SERIACIÓN DE FORMAS

Sigue la serie de figuras.



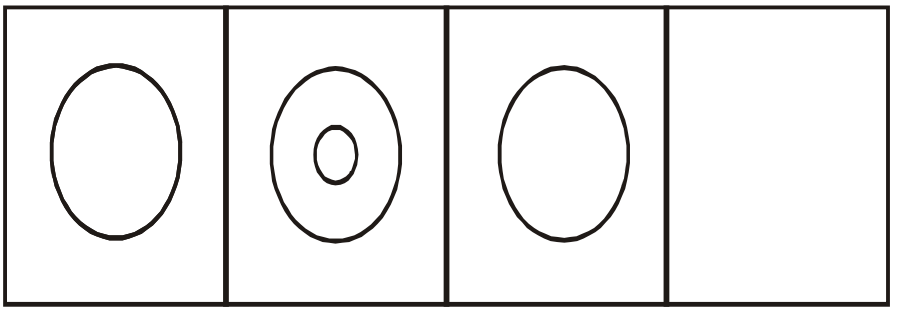



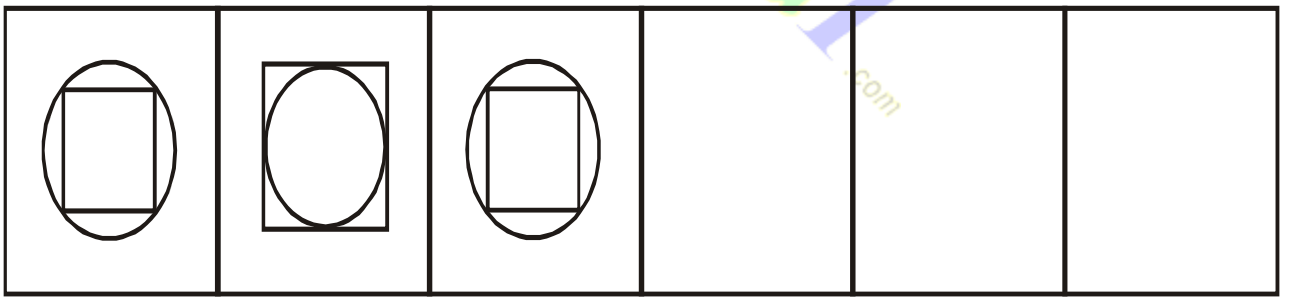

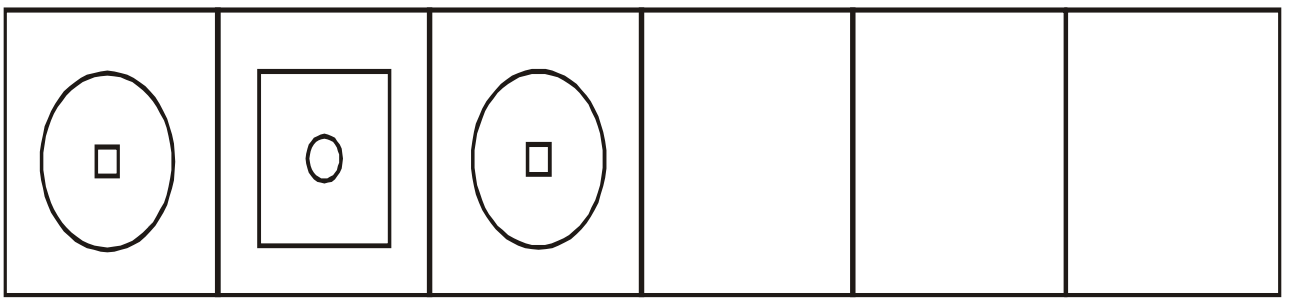

www.Matematica1.com

▶ Sigue la serie gráfica

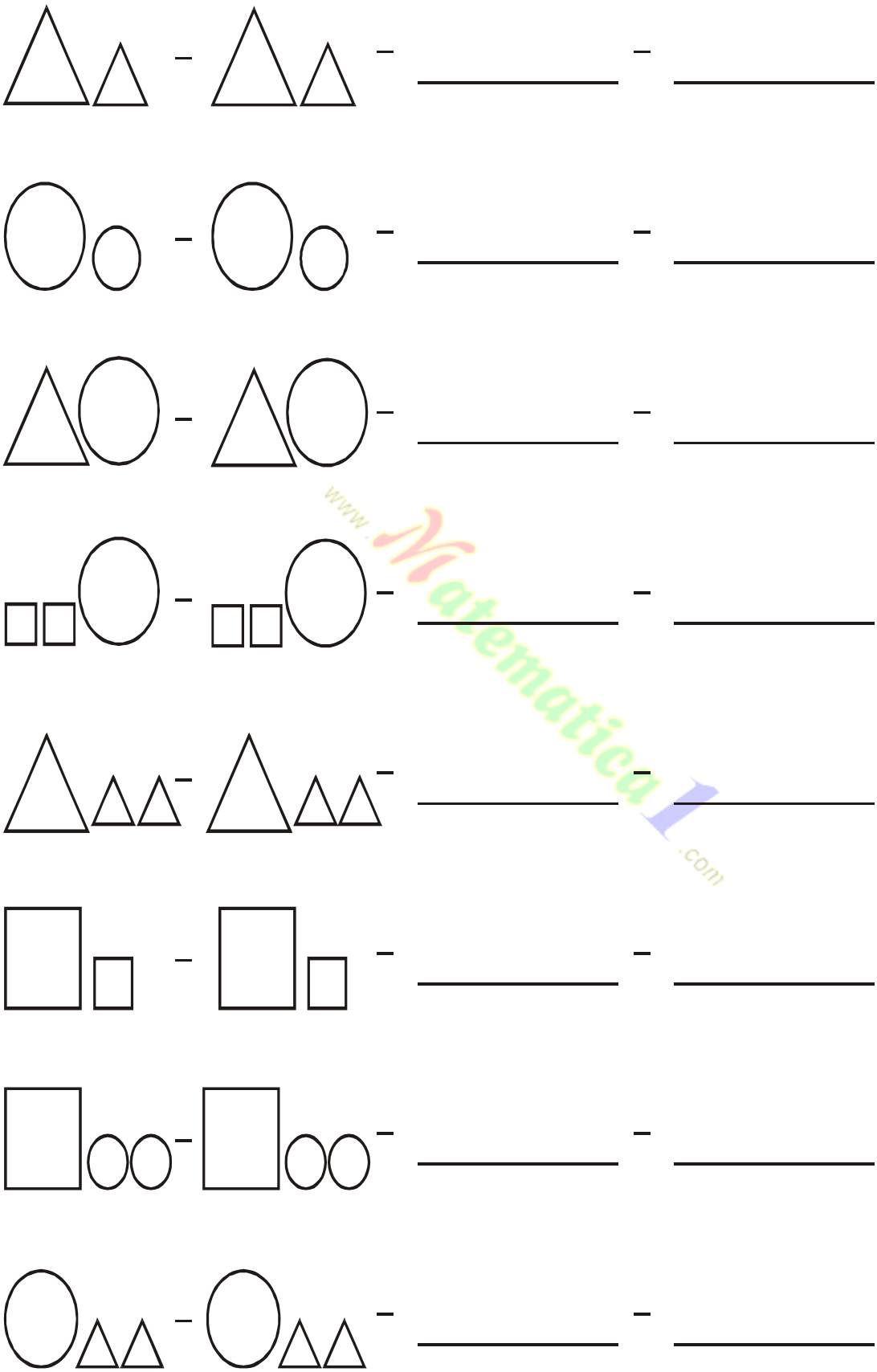

www.Matematica1.com

▶ Continua con la serie:



www.Matematica1.com

Sigue la serie numérica ascendente



www.Matematica1.com

SERIES NUMÉRICAS

▶ Completa la serie de números









SERIES NUMÉRICAS

▶ Completa la serie descendente









SERIES NUMÉRICAS

Descendentes

−1

10 9 ◯ ◯ 6 ◯ ◯ 3 ◯ ◯

-1

15 ◯ ◯ 12 ◯ ◯ 9 ◯ ◯ 6

-1

17 ◯ 15 ◯ ◯ 12 ◯ 10 ◯ ◯

-1

20 ◯ 18 ◯ ◯ 15 ◯ ◯ 12 ◯

-1

9 ◯ 7 ◯ ◯ 4 ◯ ◯ 1 ◯

www.Matematica1.com

CONTEO DE FIGURAS

1. En la figura ¿Cuántos triángulos hay?

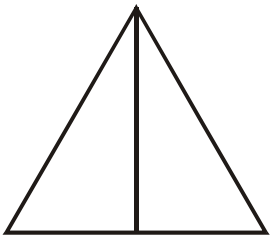

Solución

1° Los partimos

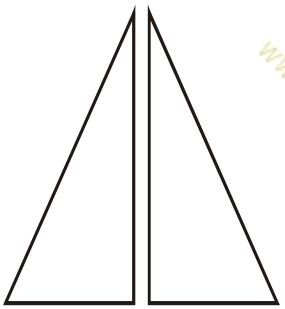

¿Cuántos △ de 1 pieza hay?

Hay____△

2° Arma los triángulos en 2 piezas

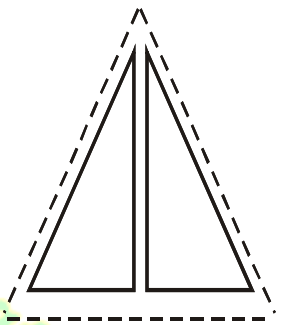

¿Cuántos △ de 2 piezas hay?

Hay____△

3° Halla la suma de los △

N° de Piezas	N° de Triángulos
De 1 parte	
De 2 partes	

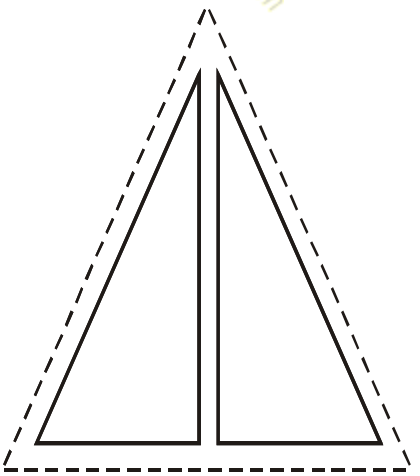

Respuesta:

hay _____△

www.Matematica1.com



Hay _____ △

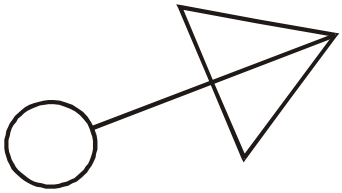

Hay _____ △

Hay _____ ▭



Hay _____ ▭

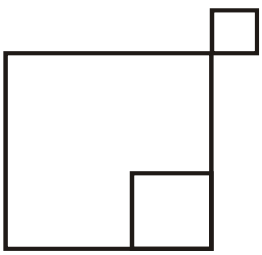

Hay _____ □

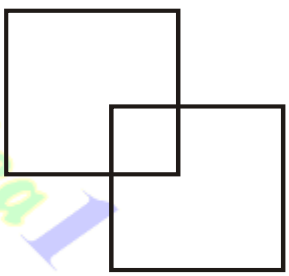

Hay _____ □

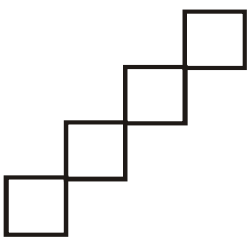

Hay _____ □

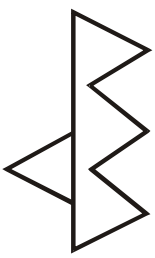

Hay _____ △

www.Matematica1.com

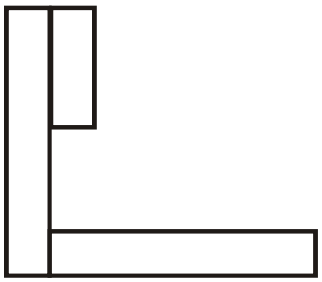

Hay _____ ▭

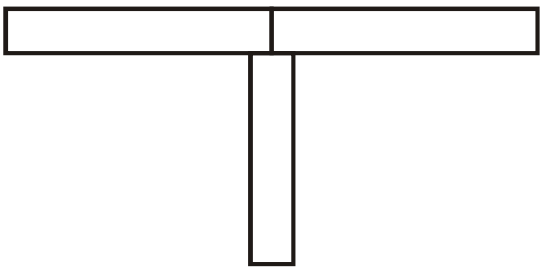

Hay _____ ▭

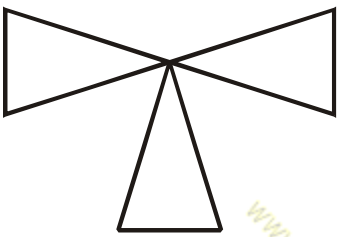

Hay _____ △



Hay _____ △

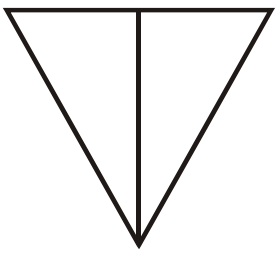

Hay _____ □

Hay _____ ▭

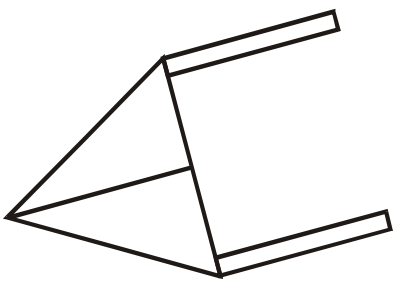

Hay _____ △

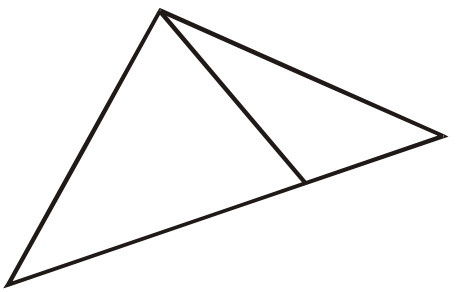

Hay _____ △

www.Matematica1.com

▶ *Ayuda a llegar a cada animalito a su casa, usando colores.*



www.Matematica1.com

FIGURAS DIFERENTES

► *Identifica y colorea las figuras diferentes*

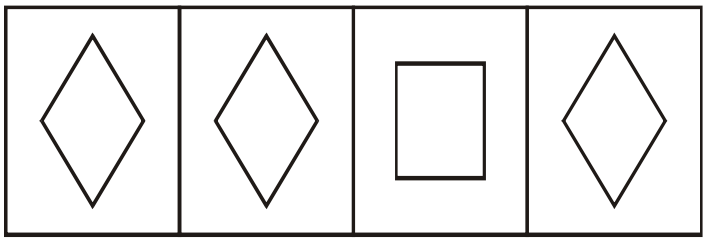



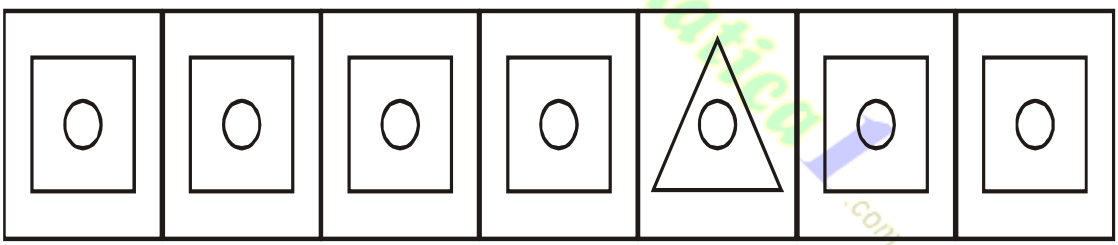

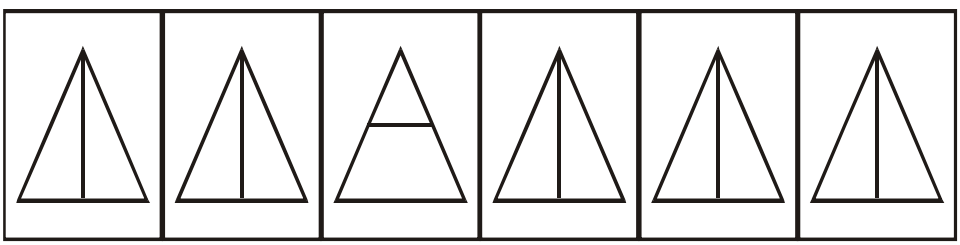

www.Matematica1.com

▶ *Encierra las figuras diferentes de cada grupo.*

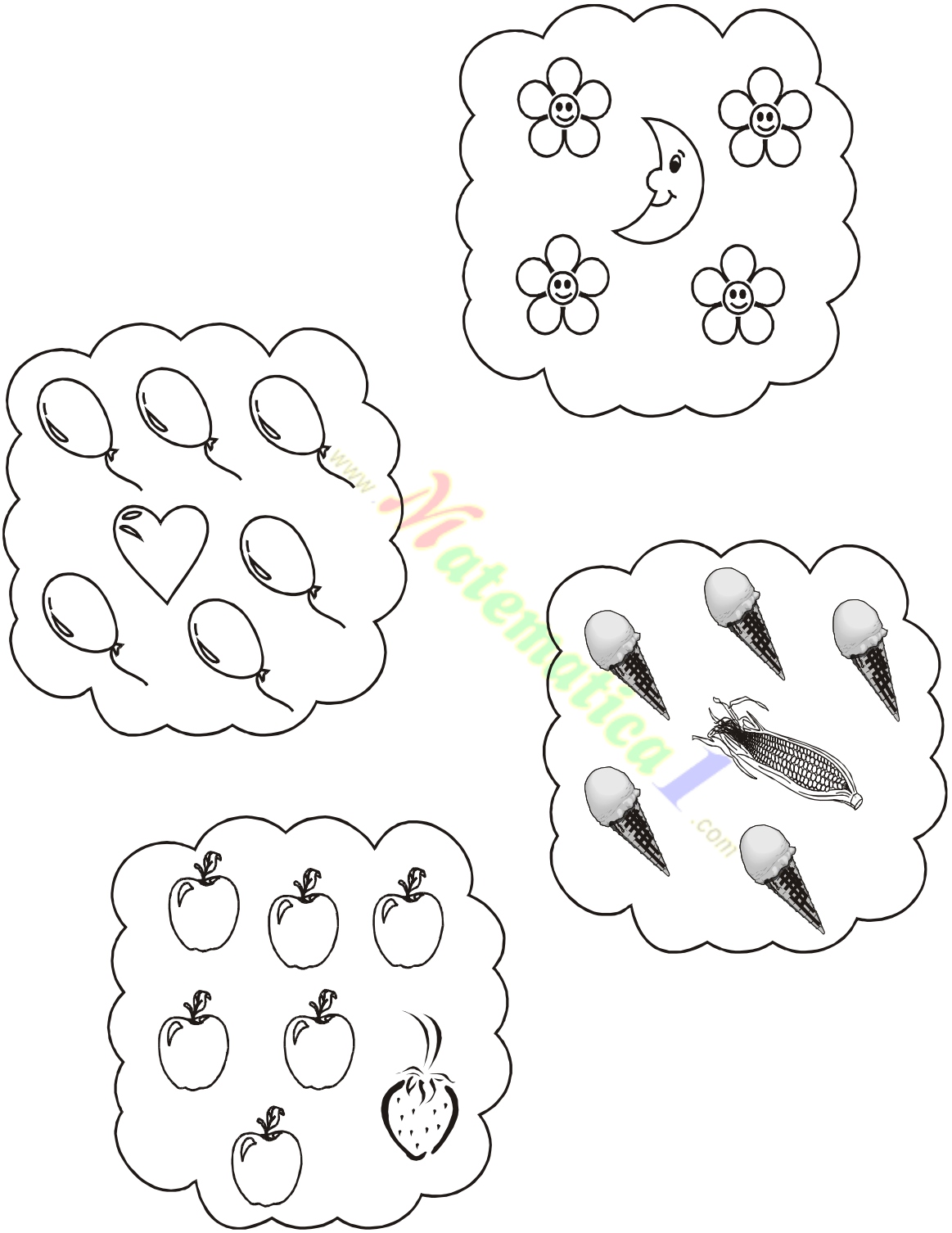

www.Matematica1.com

▶ ***Busca la forma igual a la primera.***

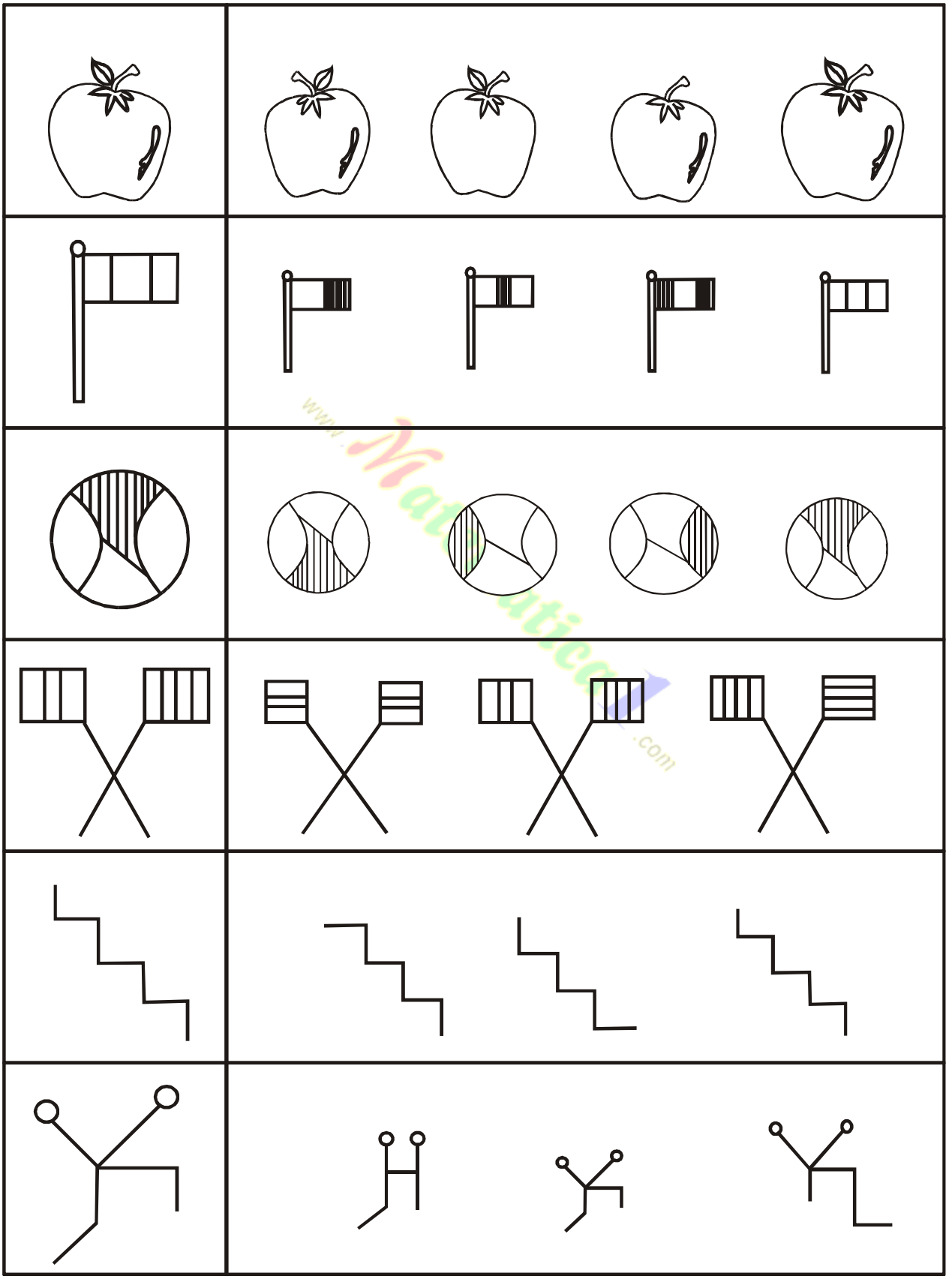

www.Matematica1.com

▶ ***Resuelve las operaciones indicadas y colorea.***

10 verde claro 9 verde oscuro 8 amarillo

7 marrón 6 azul 5 celeste 4 rojo



DISCRIMINACIÓN VISUAL

SERIACIONES GRÁFICAS

▶ *Observa y continúa la serie.*

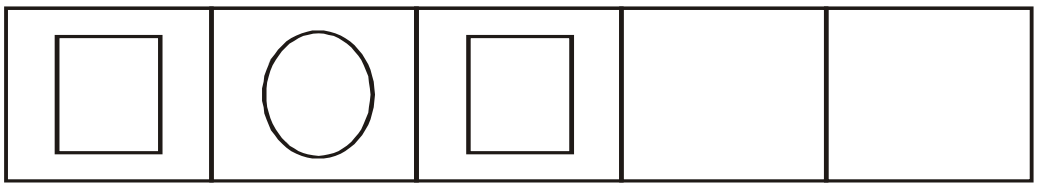

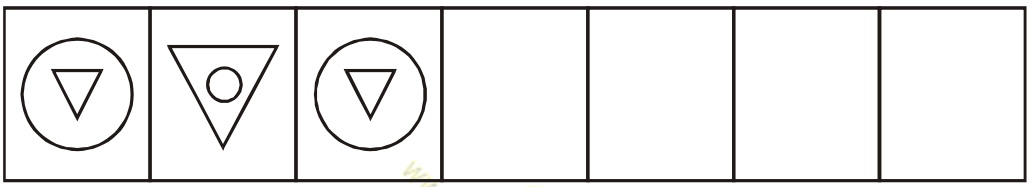

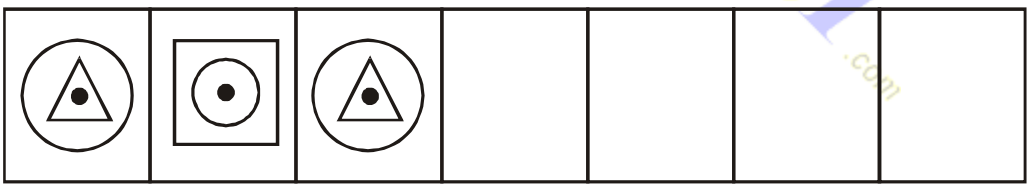

www.Matematica1.com

▶ Continúa las series gráficas:

www.Matematica1.com

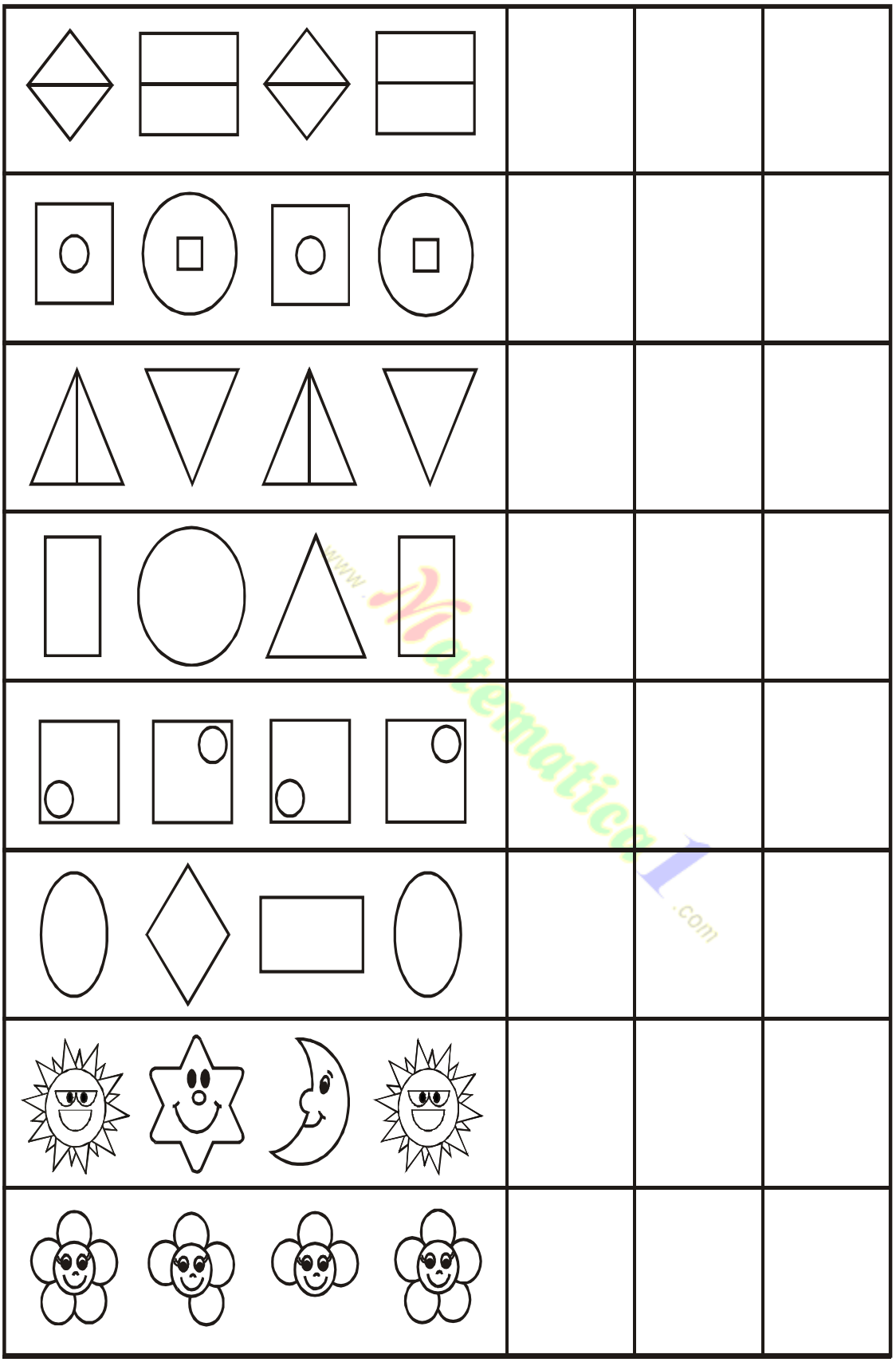

www.Matematica1.com

SERIACIONES NUMÉRICAS Ascendente

www.Matematica1.com

SERIACIONES NUMÉRICAS Ascendente



28 ◯ ◯ ◯ 32 ◯ ◯ ◯ ◯ 37 ◯ ◯ ◯



25 ◯ ◯ ◯ 29 ◯ ◯ ◯ 33 ◯ ◯ ◯ 37



42 ◯ ◯ ◯ ◯ ◯ ◯ ◯ 50 ◯ ◯ ◯ ◯



65 ◯ ◯ ◯ ◯ 70 ◯ ◯ ◯ ◯ 75 ◯ ◯

www.Matematica1.com

SERIES NUMÉRICAS

▶ **Completa Series Numéricas**

43		41			38	

29				25		



58					53	

65			62			

www.Matematica1.com

▶ **Completa cada serie descendente.**


40
37


50
48


60
51


70
69

SECUENCIA GRÁFICA

▶ ***Observa y sigue la sucesión gráfica.***



www.Matematica1.com

SUCESIONES NUMÉRICAS

ASCENDENTES

+1

8 ( ) ( ) ( ) ( ) ( )

+2

3 ( ) ( ) ( ) ( ) ( )

+3

7 ( ) ( ) ( ) ( ) ( )

+2

10 ( ) ( ) ( ) ( ) ( )

+3

9 ( ) ( ) ( ) ( ) ( )

+4

12 ( ) ( ) ( ) ( ) ( )

www.Matematica1.com

SUCESIONES NUMÉRICAS

DESCENDENTES

−2

14 ( ) ( ) ( ) ( ) ( )

−3

18 ( ) ( ) ( ) ( ) ( )

−2

30 ( ) ( ) ( ) ( ) ( )

−3

28 ( ) ( ) ( ) ( ) ( )

−2

40 ( ) ( ) ( ) ( ) ( )

−1

35 ( ) ( ) ( ) ( ) ( )

www.Matematica1.com

+2

5



−1

10

+3

2

+5

5

−2

20

+2

16

www.Matematica1.com

EJERCICIOS

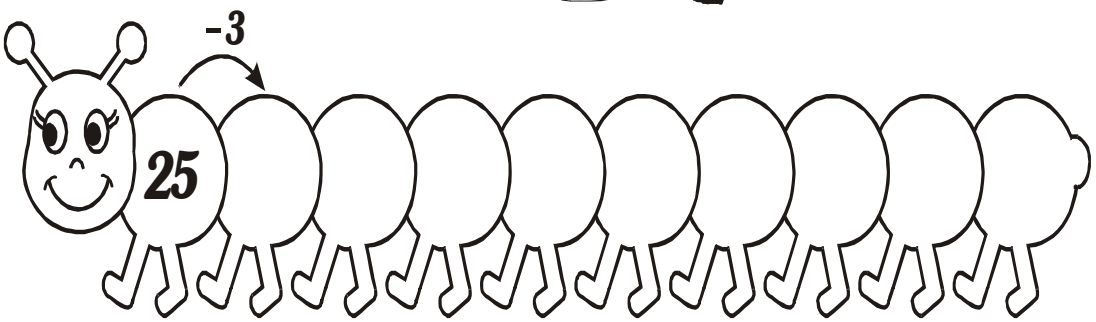

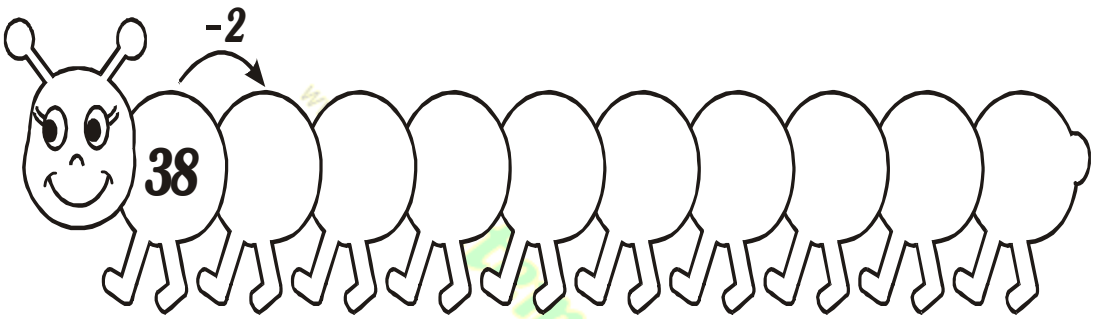



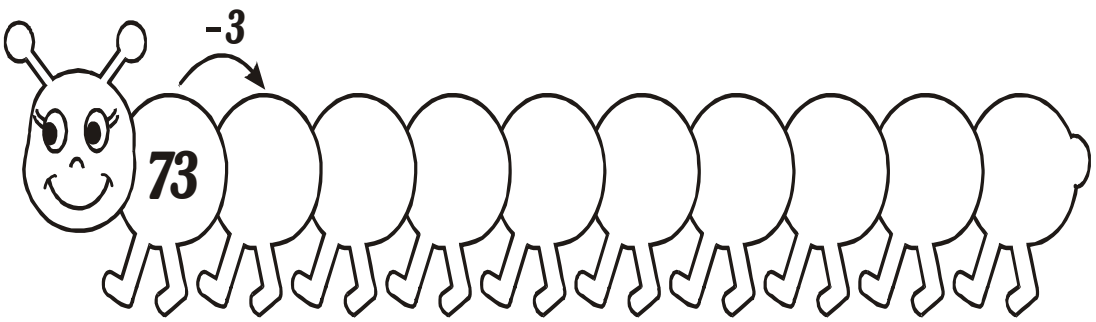

SUCESIONES GRÁFICAS

▶ ***Dibuja la figura que sigue:***

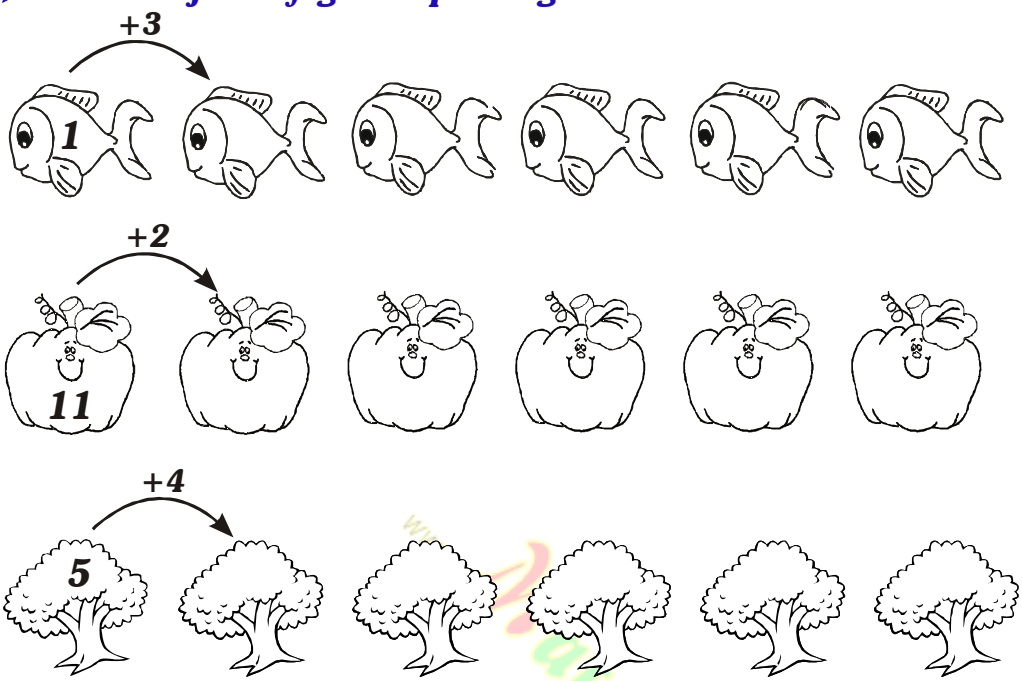

▶ ***Completa las series descendentes:***

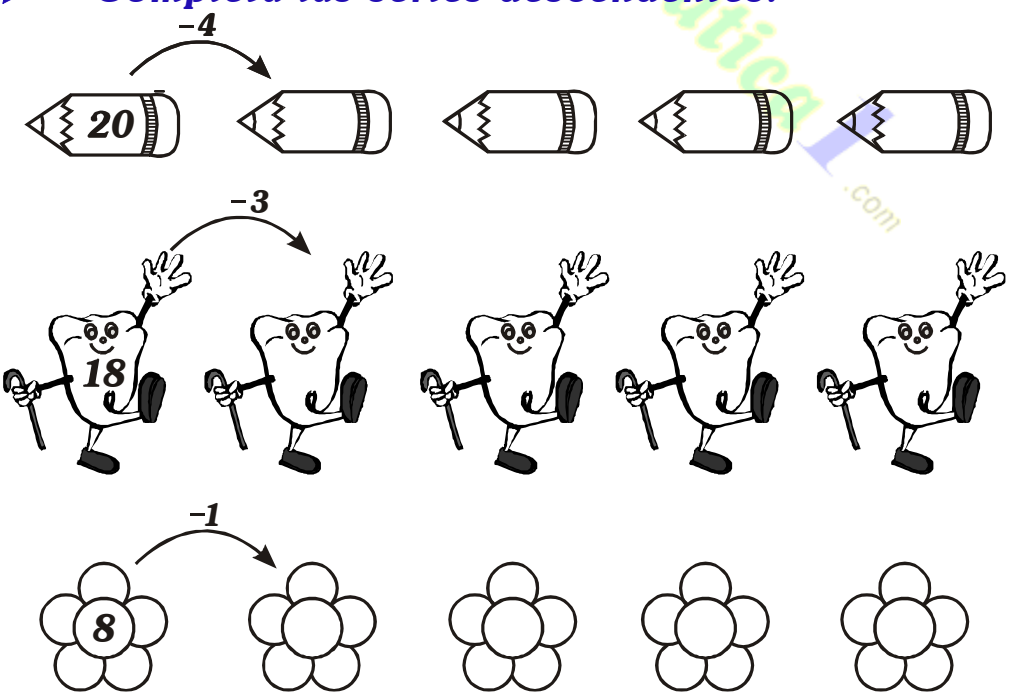

SERIES GRÁFICAS

▶ ***Continúa la serie.***



www.Matematica1.com

JUGUEMOS CON FIGURAS

▶ ¿Cuántas figuras hay?

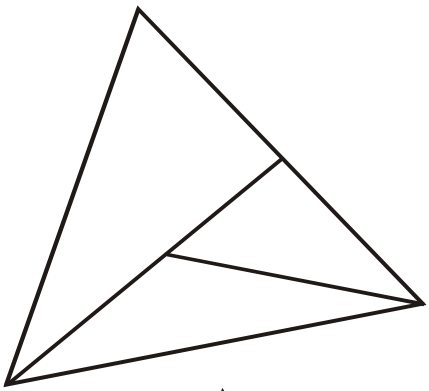

△ = _____

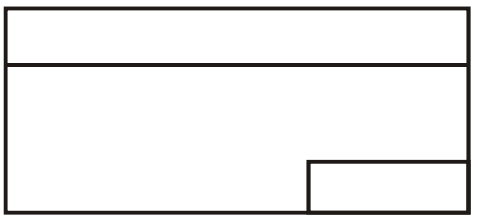

▭ = _____



□ = _____

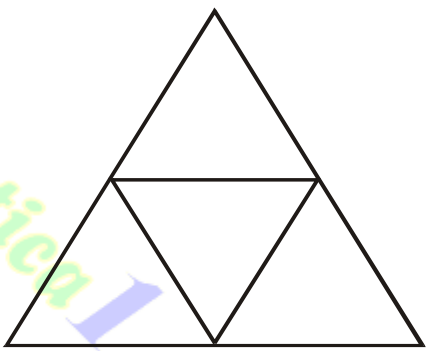

△ = _____

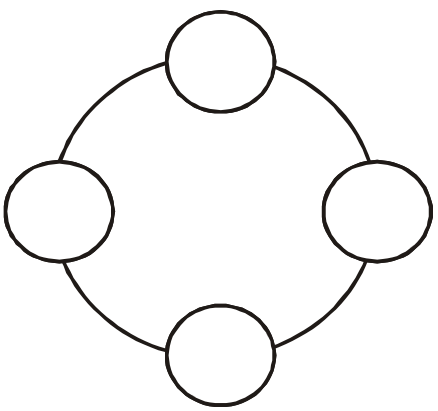

○ = _____

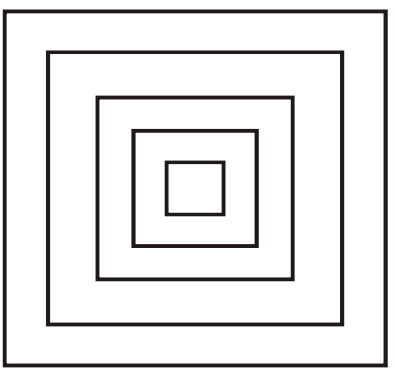

□ = _____

www.Matematica1.com

SERIACIONES NUMÉRICAS

▶ **Completa la serie ascendente**









www.Matematica1.com

EJERCICIOS



Hay _____ △

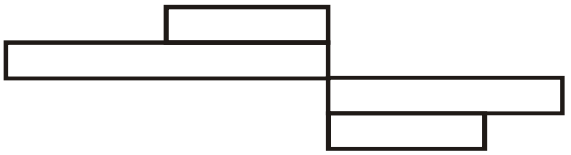

Hay _____ ▭



Hay _____ △

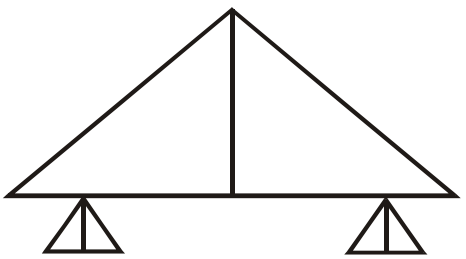

Hay _____ △

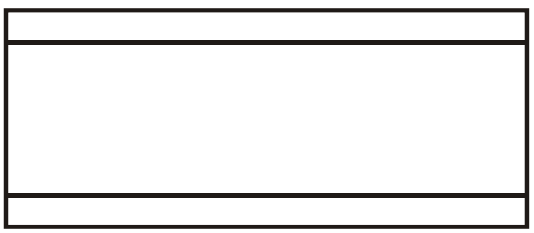

Hay _____ ▭

Hay _____ ▭

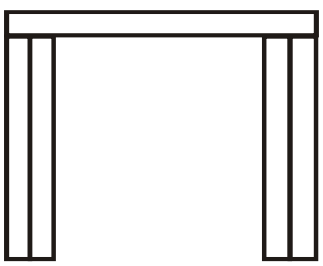

Hay _____ ▭

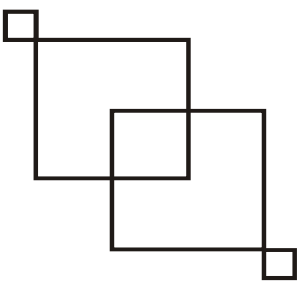

Hay _____ □

www.Matematica1.com

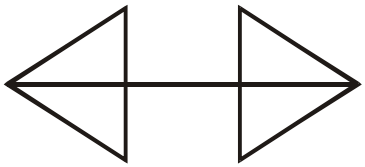

Hay _____ △

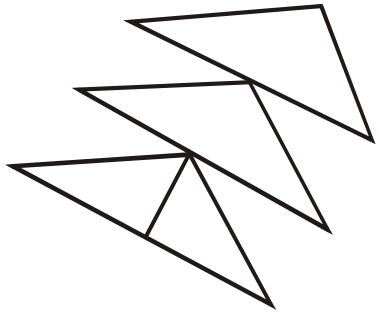

Hay _____ △



Hay _____ △

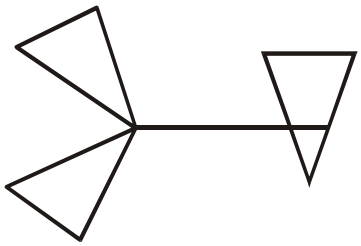

Hay _____ △

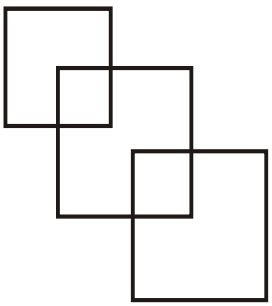

Hay _____ □

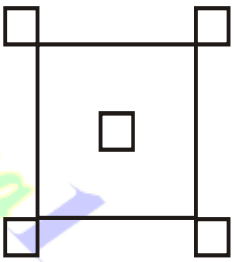

Hay _____ □

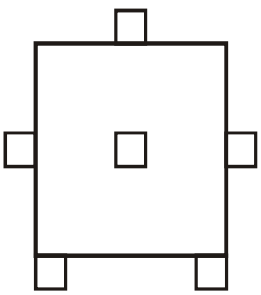

Hay _____ □

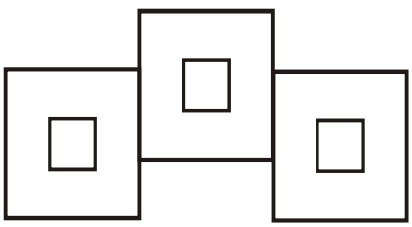

Hay _____ □

www.Matematica1.com

SERIES NUMÉRICAS

▶ **Completa la serie descendente**









¿Qué figura continúa?

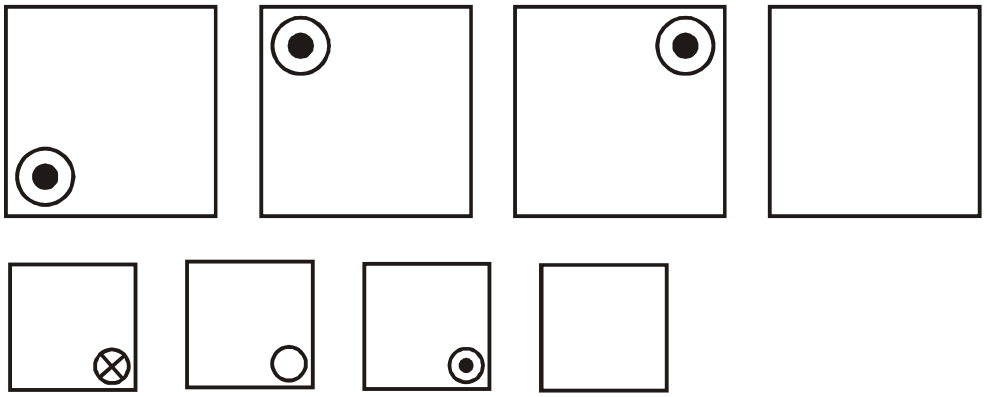

a) b) c) d)

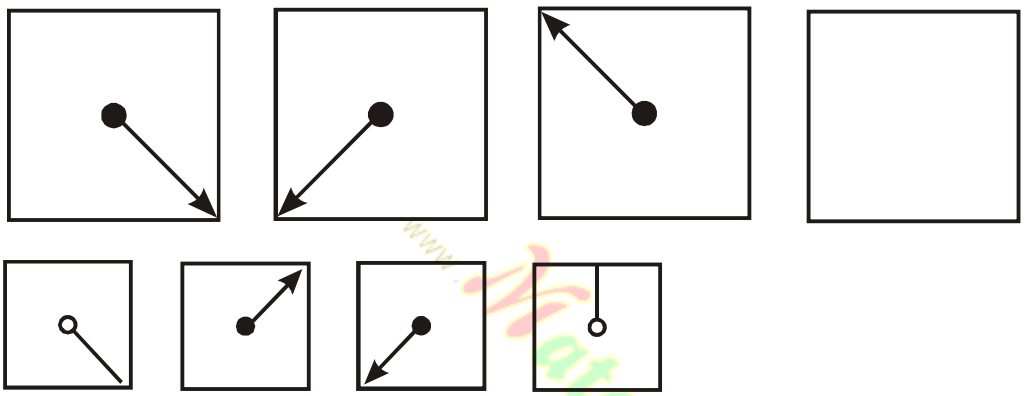

a) b) c) d)

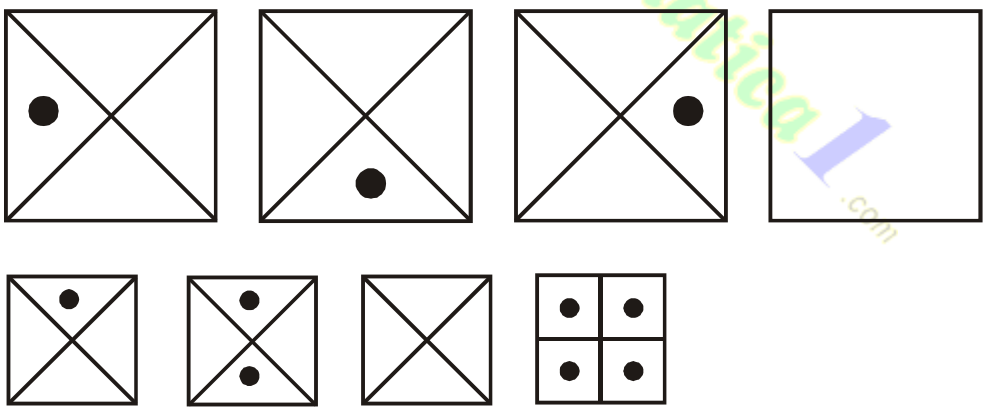

a) b) c) d)

www.Matematica1.com

LABERINTO

- ***Busca el juguete del niño.***
- ***Mi juguete es _____***

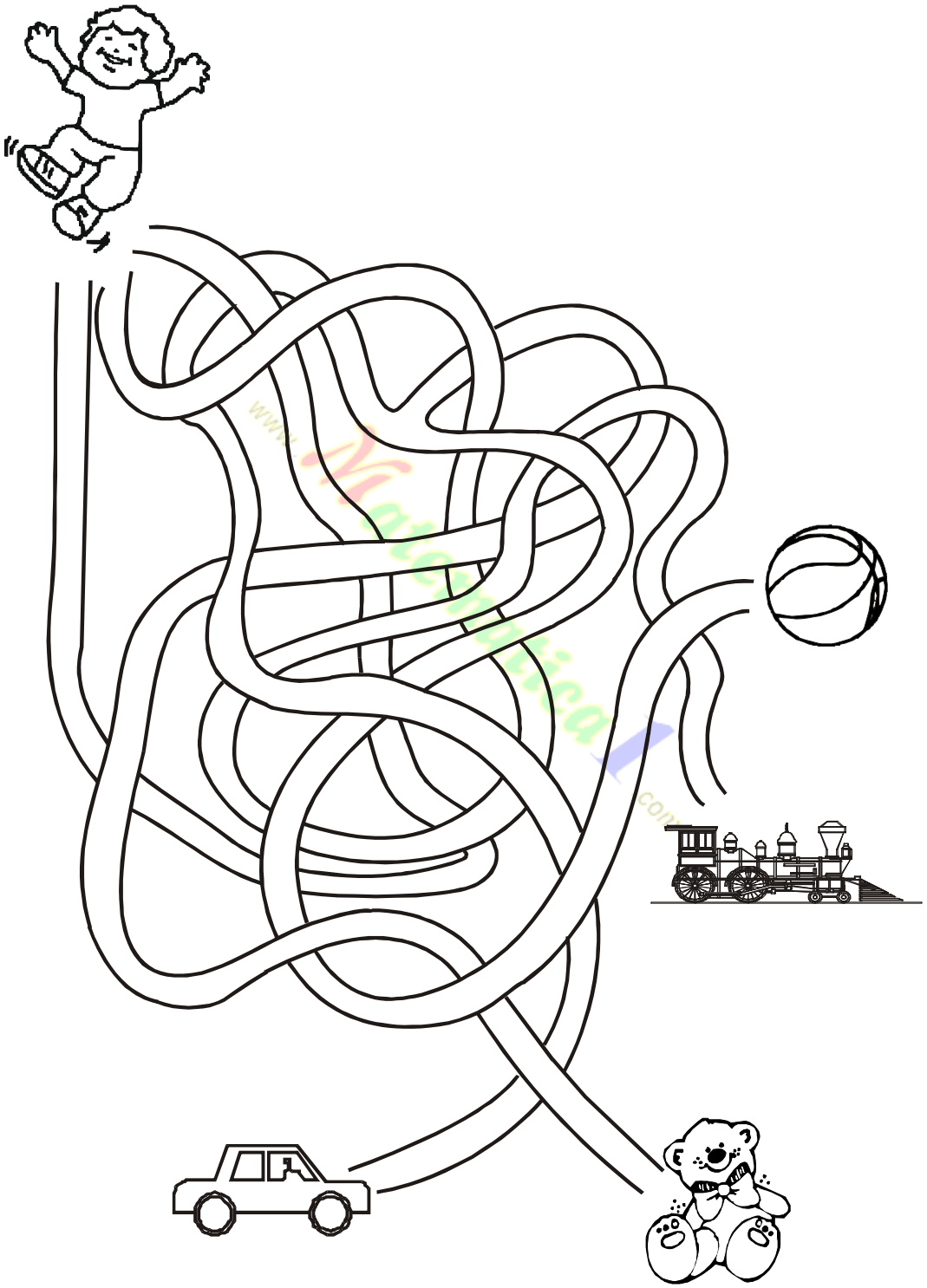

▶ ***Busca la forma igual a la 1^{era}***

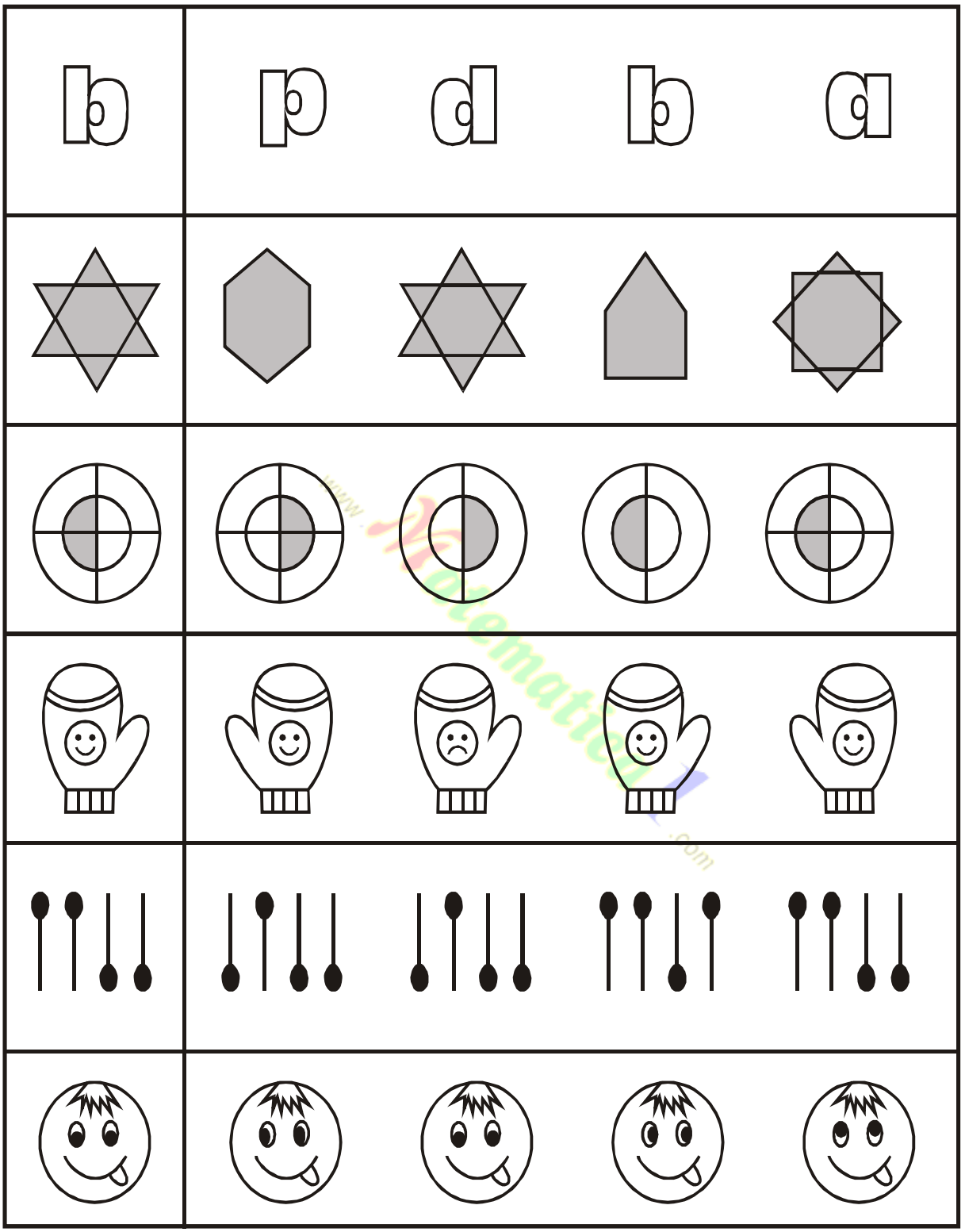

▶ ***Observamos y pintamos figuras diferentes.***



ENCONTREMOS FIGURAS DIFERENTES

▶ ***Uno es diferente ¿Cuál es?***

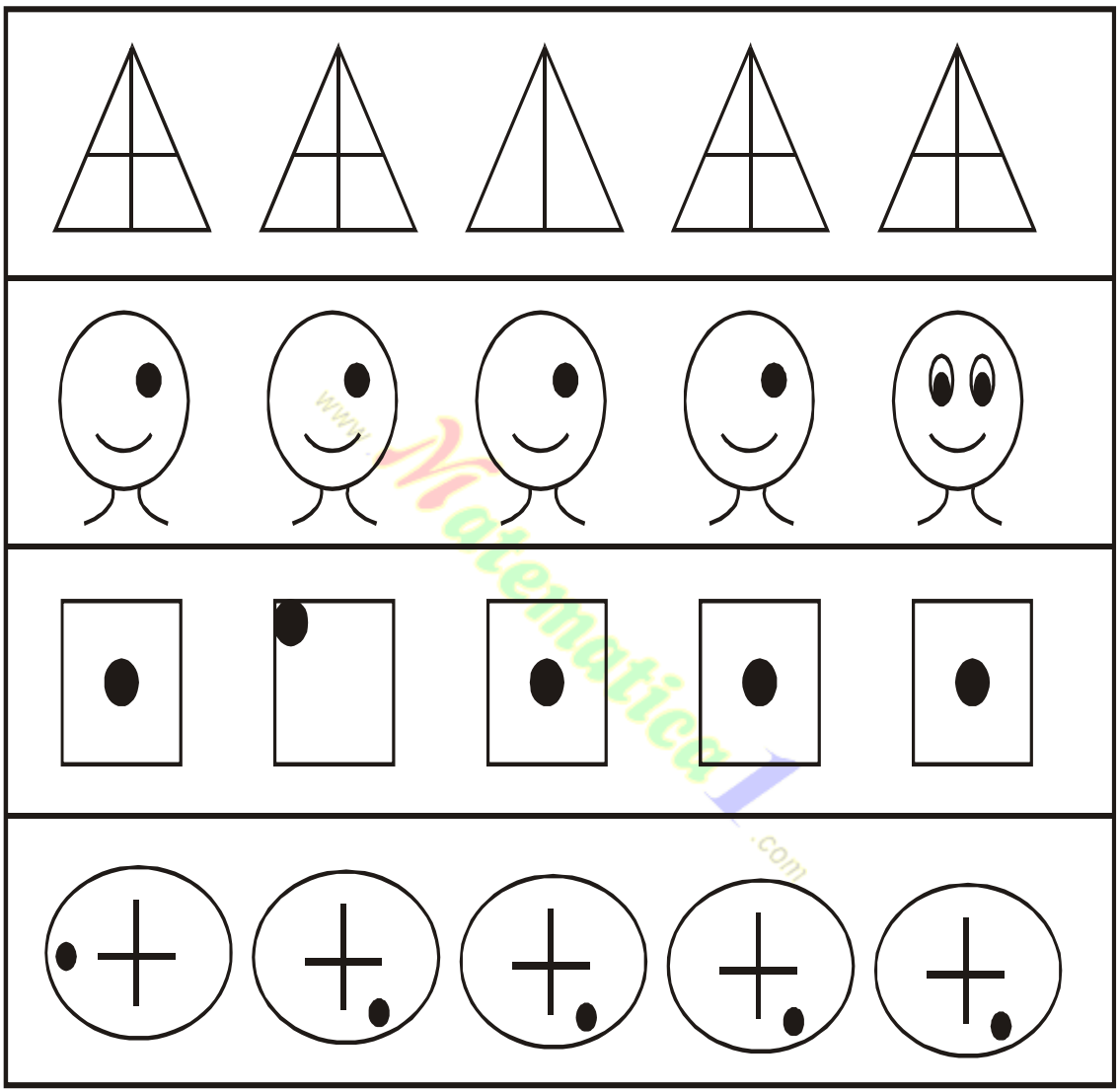

JUEGO, PIENSO Y RAZONO



► ***Colorea de acuerdo a los resultados.***

0 = azul 2 = celeste 4 = amarillo 6 = marrón 8 = morado

1 = rojo 3 = verde 5 = rosado 7 = naranja

Suma mentalmente y une con su resultado

24+8	44
35+5	36
42+2	32
29+7	57
50+7	40

www.Matematica1.com

1) ? > 20

a) 4
b) 9
c) 28
d) 19

2) ? > 28

e) 11
f) 20
g) 24
h) 36

3) ? > 30

i) 45
j) 29
k)27
l) 26

4) ? > 50

ll) 37
m) 29
n) 51
ñ) 8

5) ? > 58

o) 60
p) 52
q) 47
r) 39

6) ? > 60

s) 59
t) 50
u) 47
v) 61

7) ? > 40

w) 40
x) 20
y) 60
z) 10

8) ? > 35

a) 35
b) 53
c) 27
d) 17

9) ? > 29

e) 92
f) 10
g) 15
h) 22

10) ? > 20

i) 26
j) 32
k) 49
l) 16

11) ? > 36

ll) 36
m) 18
n) 42
ñ) 21

12) ? > 64

a) 46
b) 64
c) 39
d) 70

www.Matematica1.com

13) ? < 40

a) 40
b) 45
c) 53
d) 28

14) ? < 70

e) 71
f) 80
g) 20
h) 75

15) ? < 60

i) 59
j) 60
k) 61
l) 62

16) ? < 39

ll) 80
m) 53
n) 40
ñ) 7

17) ? < 28

o) 82
p) 34
q) 10
r) 50

18) ? < 36

s) 37
t) 39
u) 63
v) 6

19) ? < 45

w) 40
x) 48
y) 62
z) 71

20) ? < 52

a) 90
b) 25
c) 60
d) 55

21) ? < 63

e) 36
f) 71
g) 68
h) 64

22) ? < 52

i) 55
j) 51
k) 72
l) 62

23) ? < 48

ll) 84
m) 47
n) 48
ñ) 49

24) ? < 28

o) 82
p) 29
q) 15
r) 48

www.Matematica1.com

▶ *Observa y busca sólo las figuras ovaladas.*

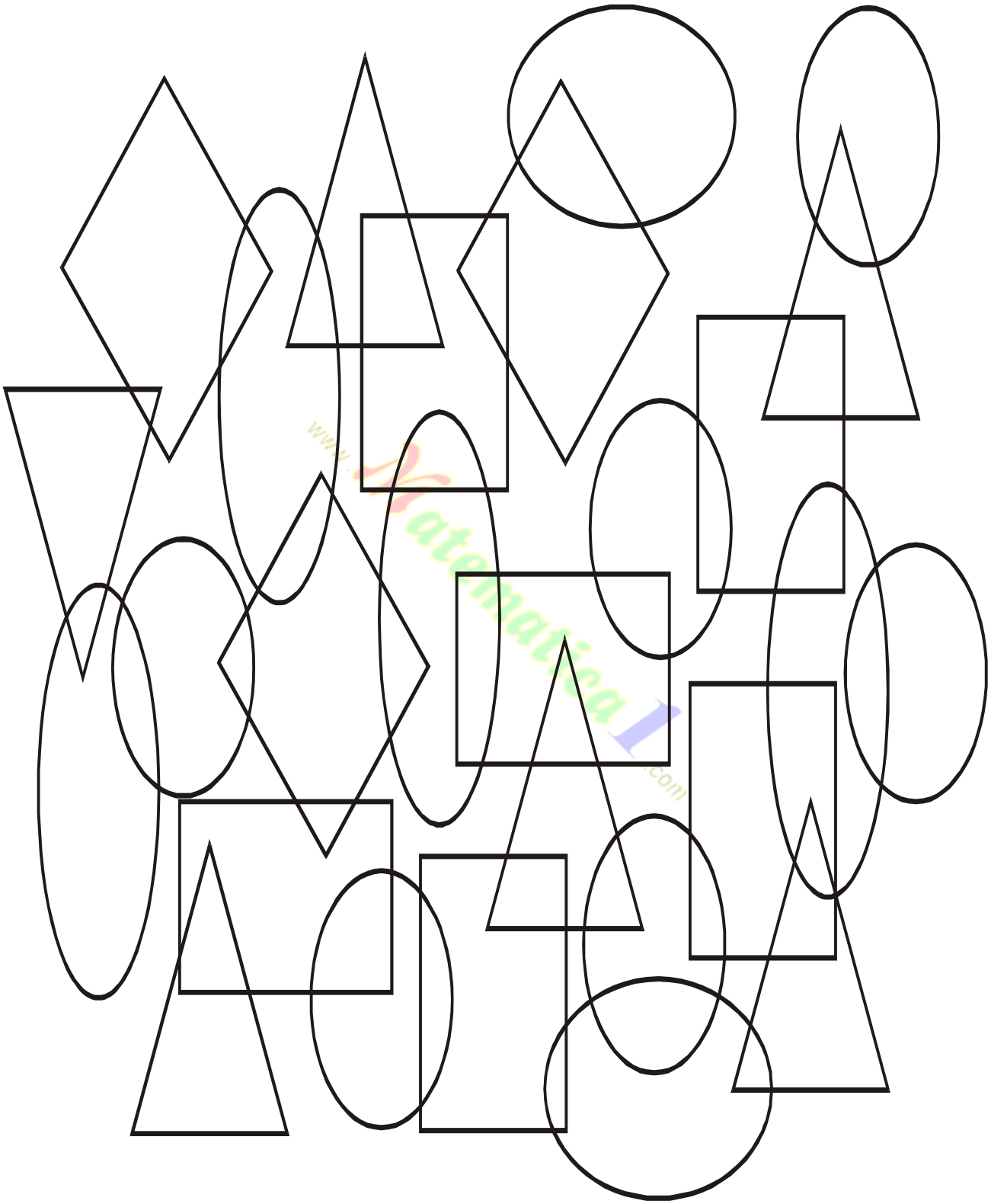

▶ ***Colorea las baldosas como indica el modelo:***



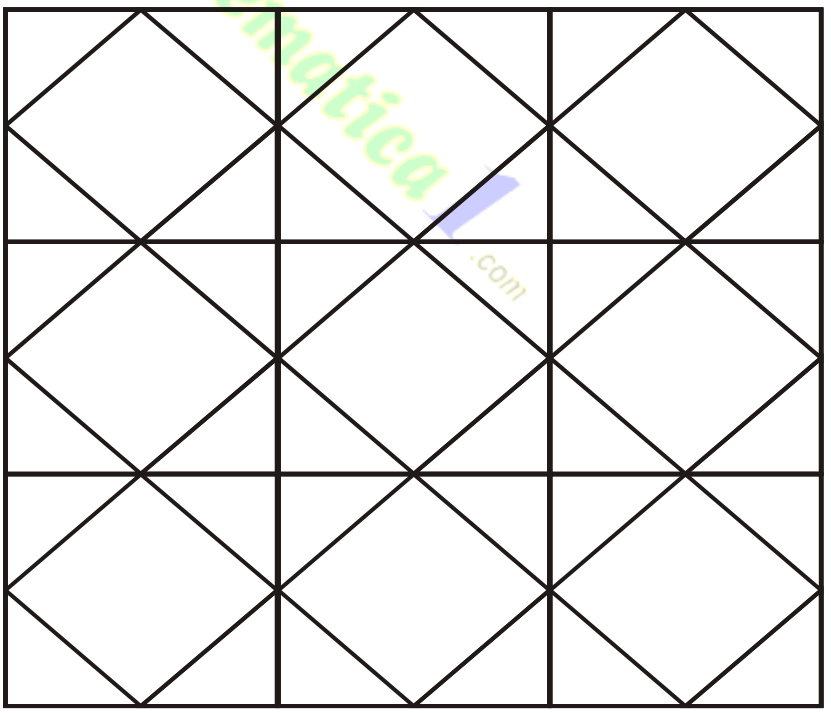

www.Matematica1.com

SUCESIONES GRÁFICAS

1) ¿Cuál continúa?

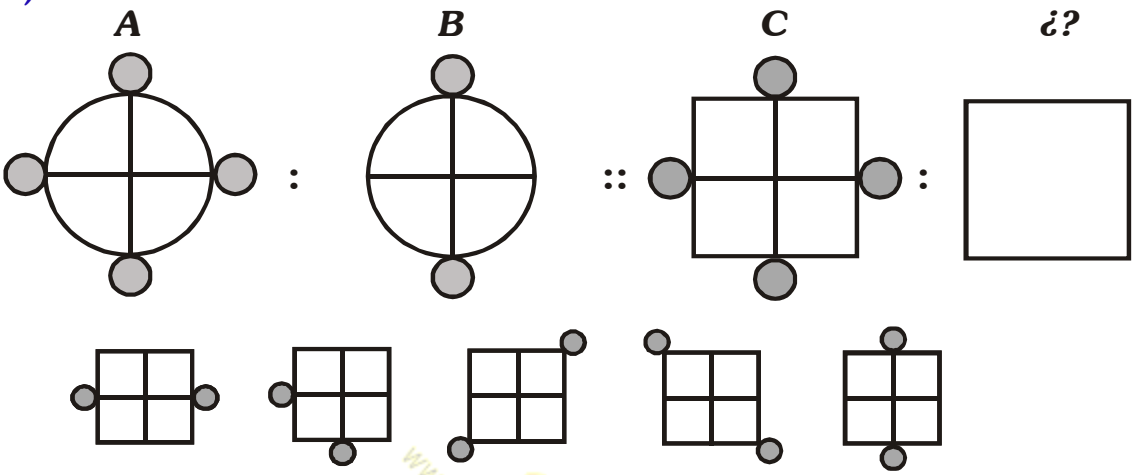

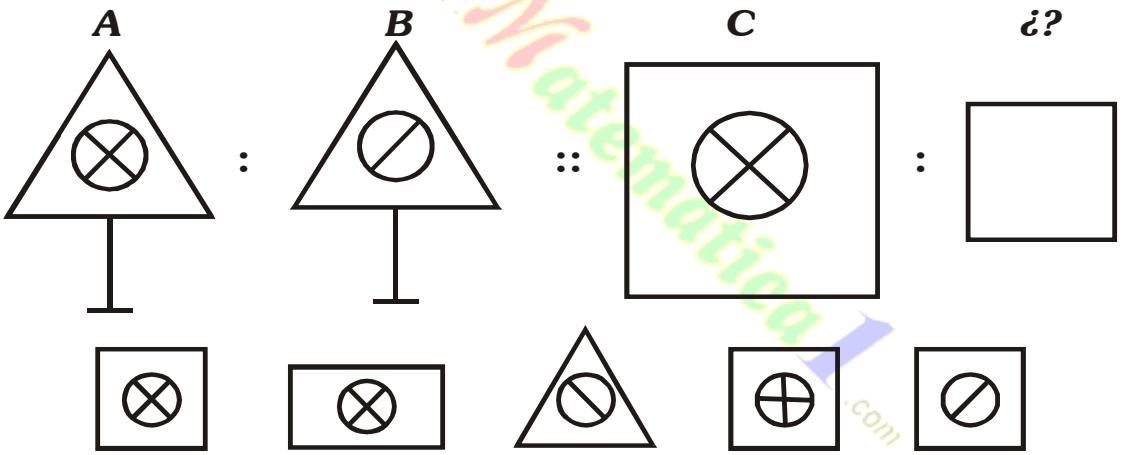

3) ¿Qué figura se relaciona con C?

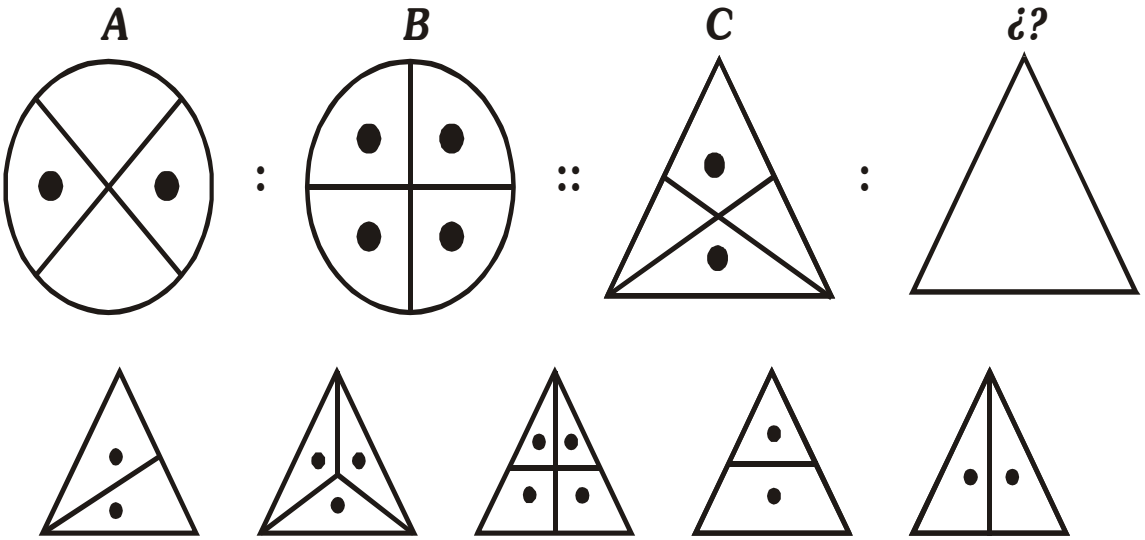

SUCESIÓN NUMÉRICA (SUMAS)

1. Resuelve.

www.Matematica1.com









www.Matematica1.com

SUCESIÓN NUMÉRICA

▶ ***Realiza sucesiones ascendentes.***





www.Matematica1.com

SUCESIONES NUMÉRICAS

(Restas)









Resuelve:







www.Matematica1.com

TRAYECTORIA

► ***Ayudemos a los niños a llegar a su maestra haciendo su trayectoria de colores.***



COPIA EL MODELO







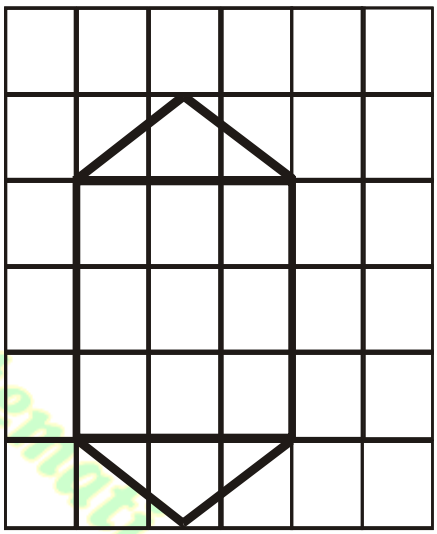

www.Matematica1.com





UNE LOS PUNTOS

► ***Completa según el modelo.***

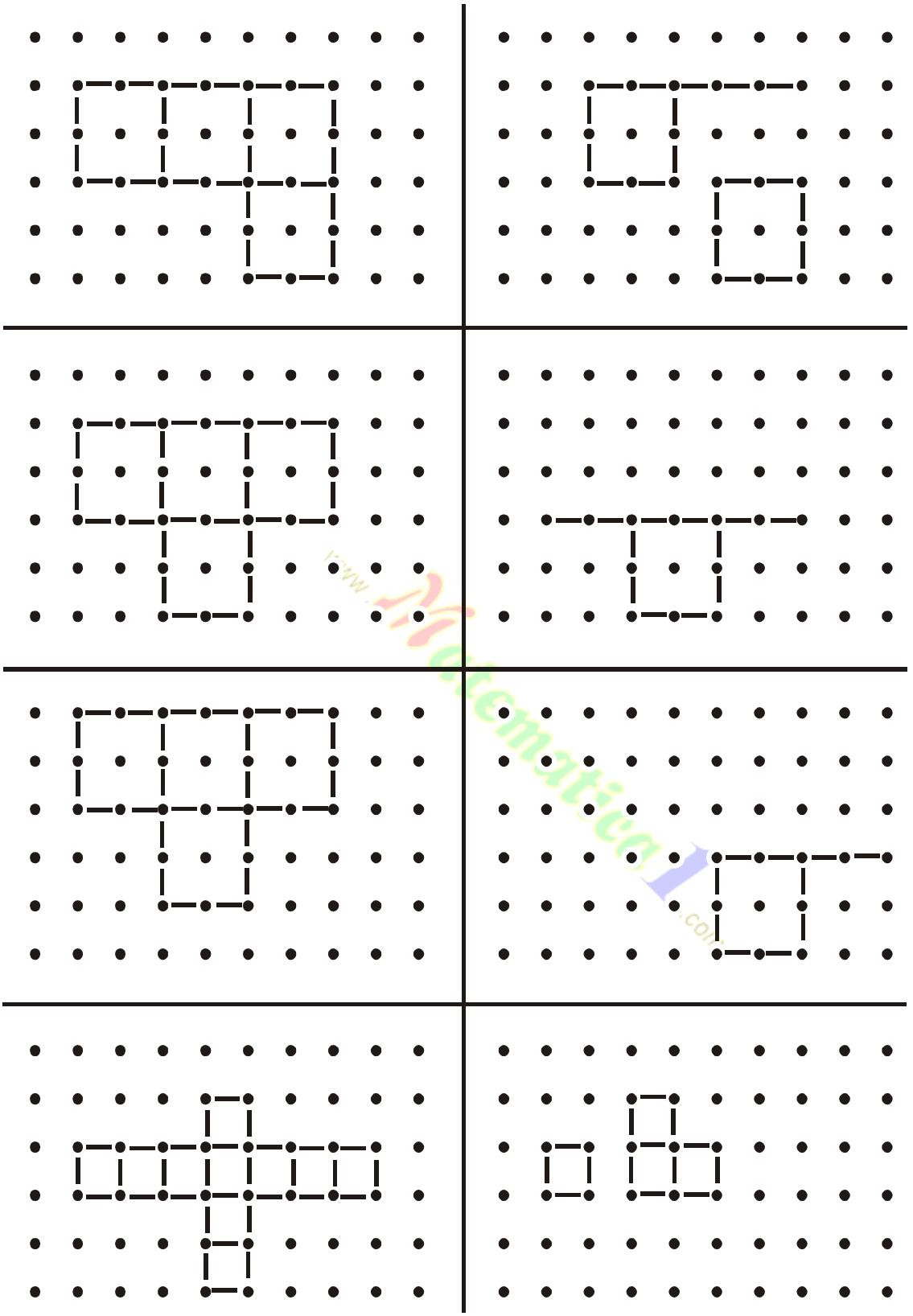

UNE LOS PUNTOS

► ***Reproduce figuras***

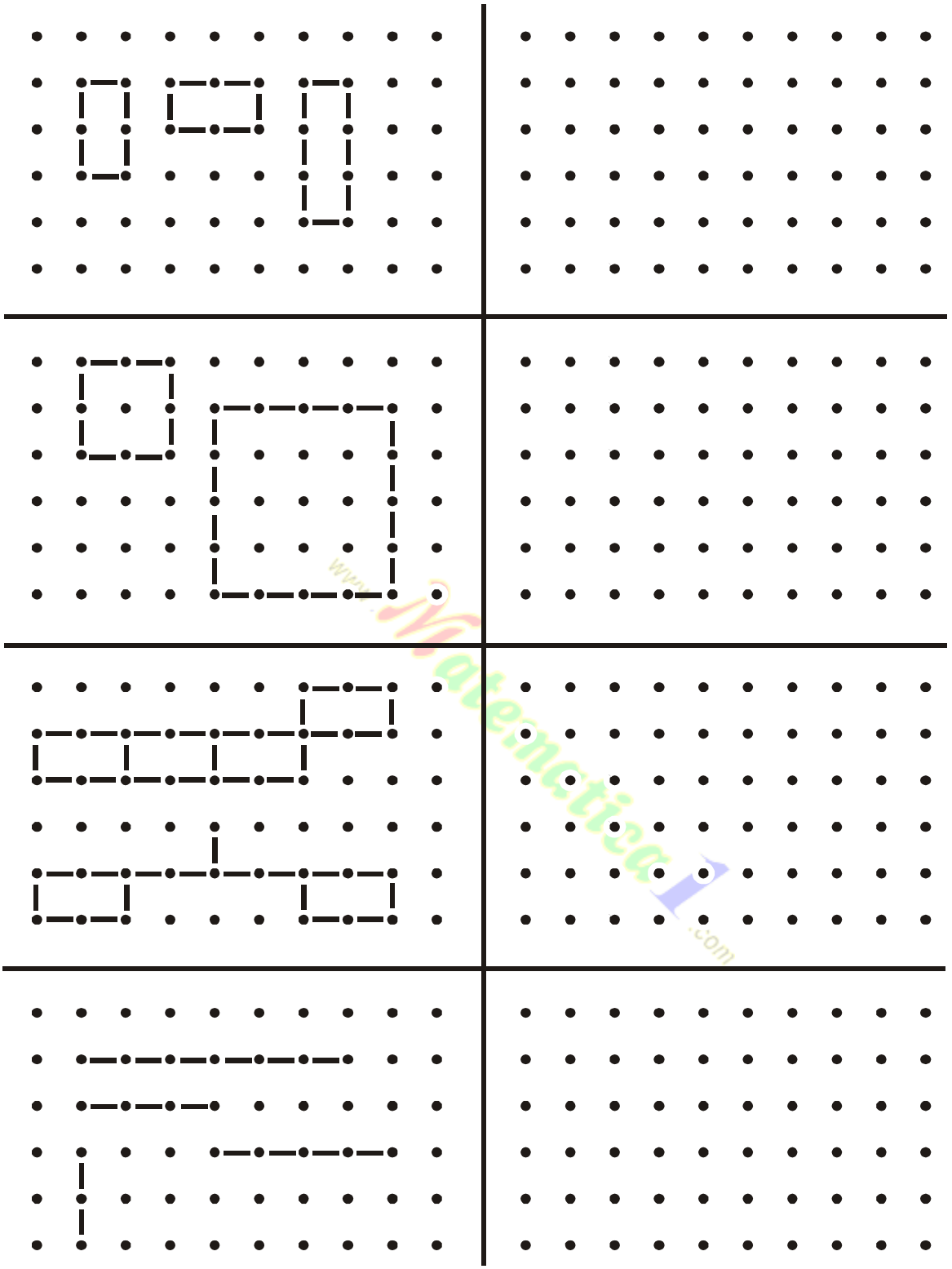

▶ Resuelve las operaciones incompletas luego recorta y pega las piezas donde corresponde.

8+□ =14	11+□=19	6+□ =11	8+□ =15
2+□ =12	14+□=16	9+□ =13	17+□=18
7+□ =10	10+□=19	11+□ =22	22+□ =34



SUMEMOS

Trasladamos figuras modificándolas

▶ Encuentra el número que falta

6 + □ = 9

5 + □ = 6

□ + 6 = 9

5 + □ = 10

□ + 5 = 7

2 + □ = 6

□ + 0 = 0

2 + □ = 8

□ + 1 = 9

□ + 4 = 8

1 + □ = 2

www.Matematica1.com

SUMAS EN PIRÁMIDES

▶ Resuelve la suma y coloca el resultado en el cuadrado de arriba.

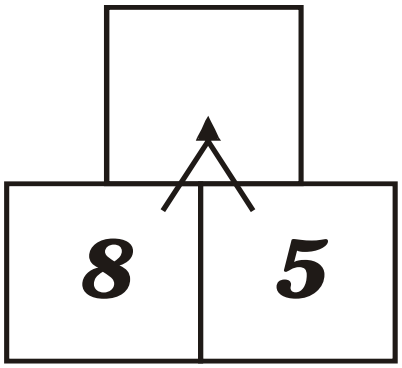

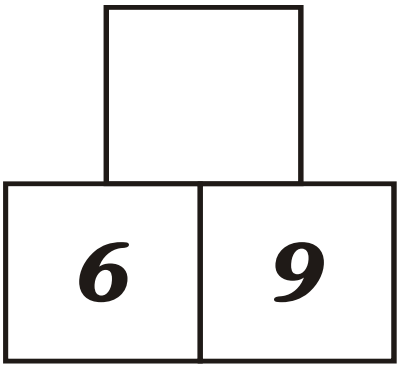

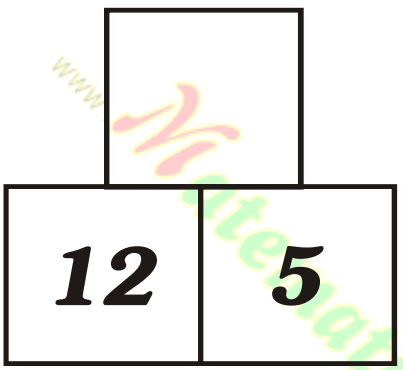

www.Matematica1.com

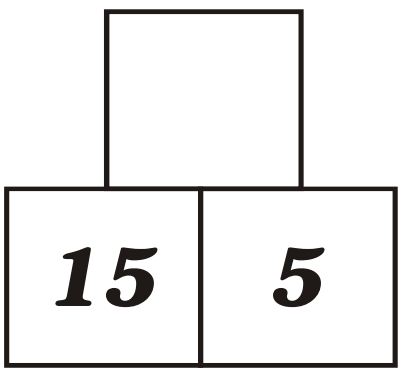

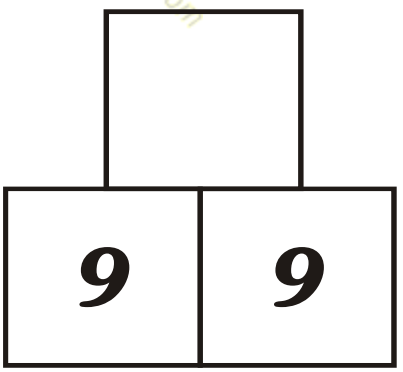

▶ ***Resuelve las pirámides numéricas***

18	9

25	7

34	8

33	14

21	45

34	25

42	23

23	45

www.Matematica1.com

TÉRMINO EXCLUIDO

▶ Colorea la figura que no corresponde a cada recuadro.



TÉRMINO EXCLUIDO

▶ Encierra cada término excluido.

5 + 2	3 + 4	2 + 4	6 + 1	7 + 0	2 + 5	4 + 3

8 + 8	9 + 7	10+6	5 + 3	7 + 9	6+10

www.Matematica1.com

6 + 6	7 + 5	8 + 4	5 + 6

3 + 2	4 + 1	1 + 2	5 + 0

▶ Encierra la alternativa que no pertenece al grupo,

1) = 10

a) 2 + 8
b) 3 + 4
c) 6 + 4
d) 7 + 3

3) = 12

a) 9 + 3
b) 5 + 7
c) 4 + 3
d) 6 + 6

2) = 15

a) 3 + 5
b) 7 + 8
c) 9 + 6
d) 11+4

4) = 20

a) 15 + 5
b) 13 + 7
c) 10 + 10
d) 10 + 5

www.Matematica1.com

1. *Observa y termina de colorear:*



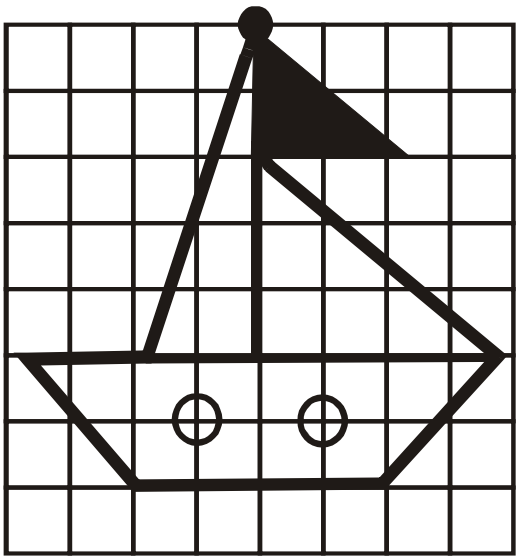

2. *Copia agrandando :*



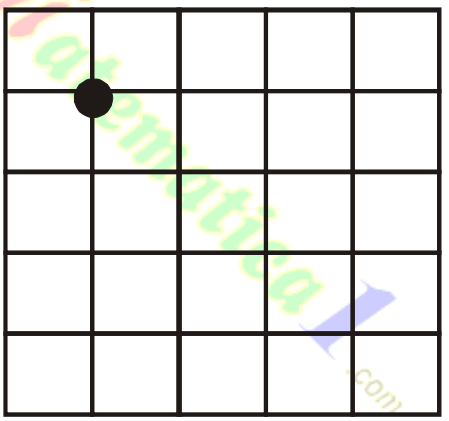

www.Matematica1.com

3. *Copia agrandando y coloreando:*





SUMAS INCOMPLETAS



$7 + \square = 8$

$10 + \square = 10$

$\square + 5 = 10$

▶ ***Resuelve las sumas incompletas.***

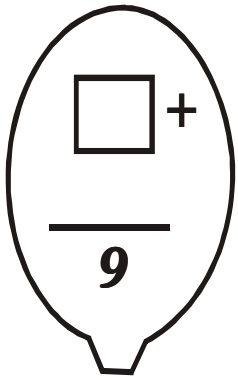

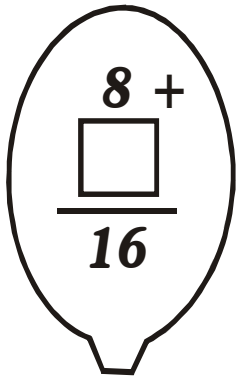

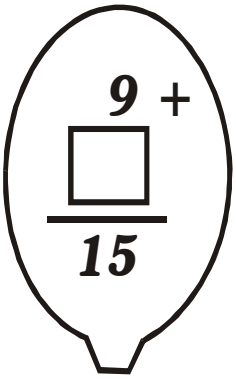

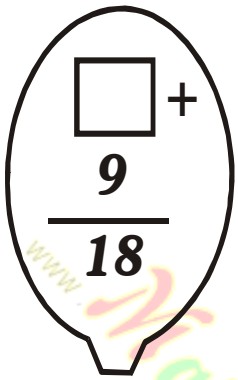

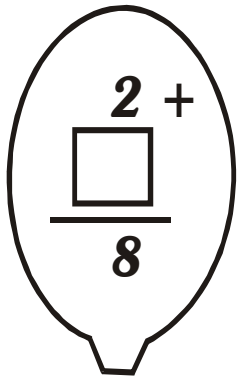





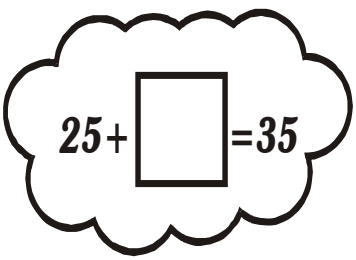

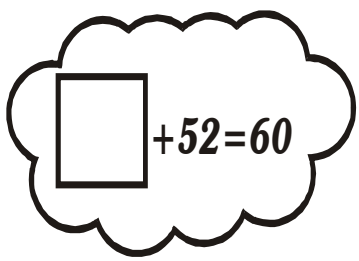

RESTAS INCOMPLETAS

▶ *Resuelve las restas incompletas:*

a) $9 - \square = 3$

b) $7 - \square = 5$

c) $5 - \square = 0$

d) $6 - \square = 3$

e) $\square - 5 = 5$

f) $\square - 4 = 3$

g) $\square - 1 = 9$

h) $\square - 0 = 8$

▶ Encuentra el número faltante:

$$\begin{array}{r} 7 \\ \square \\ \hline 7 \end{array} \qquad \begin{array}{r} 8 \\ \square \\ \hline 4 \end{array} \qquad \begin{array}{r} \square \\ 2 \\ \hline 6 \end{array} \qquad \begin{array}{r} \square \\ 4 \\ \hline 5 \end{array}$$

$$\begin{array}{r} 6 \\ \square \\ \hline 2 \end{array} \qquad \begin{array}{r} 9 \\ \square \\ \hline 6 \end{array} \qquad \begin{array}{r} \square \\ 0 \\ \hline 1 \end{array} \qquad \begin{array}{r} \square \\ 3 \\ \hline 5 \end{array}$$

$$\begin{array}{r} 8 \\ \square \\ \hline 1 \end{array} \qquad \begin{array}{r} 5 \\ \square \\ \hline 4 \end{array} \qquad \begin{array}{r} \square \\ 7 \\ \hline 2 \end{array} \qquad \begin{array}{r} \square \\ 1 \\ \hline 8 \end{array}$$

www.Matematica1.com

RESTAS INCOMPLETAS

▶ ***Resuelve las restas.***

$$\begin{array}{r} 9\ - \\ \square \\ \hline 5 \end{array}$$

$$\begin{array}{r} 8\ - \\ \square \\ \hline 3 \end{array}$$

$$\begin{array}{r} 7\ - \\ \square \\ \hline 4 \end{array}$$

$$10 - \square = 6$$

$$\begin{array}{r} \square\ - \\ 3 \\ \hline 6 \end{array}$$

$$12 - \square = 7$$

$$\square - 5 = 8$$

$$\square - 2 = 9$$

RESTAS DE PIRÁMIDES

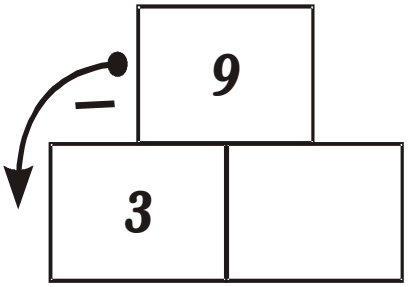

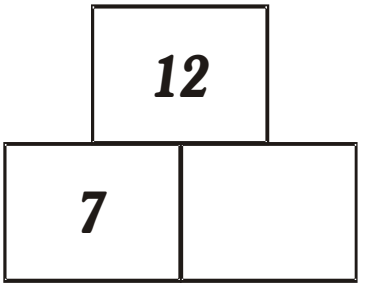



www.Matematica1.com

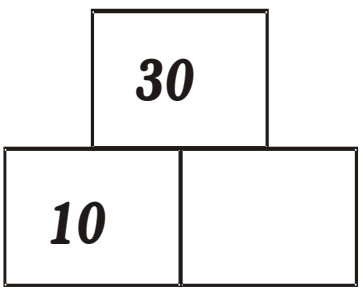

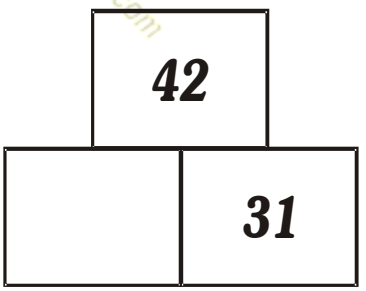

Juego y Aprendo con

Pirámides

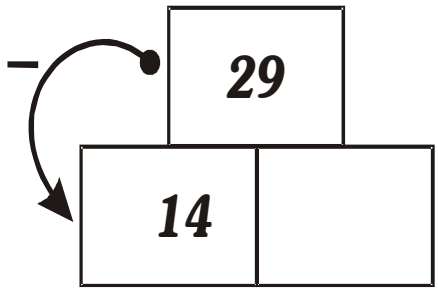



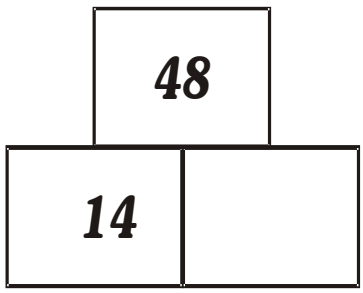

www.Matematica1.com

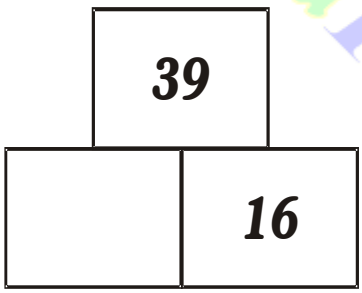

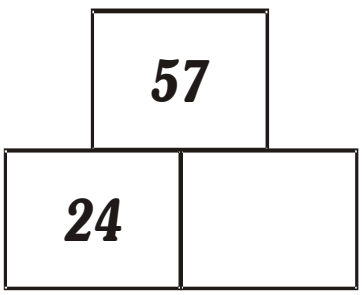

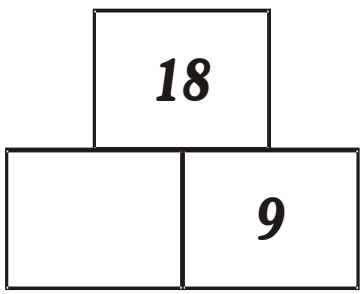

SUMAS PIRAMIDALES

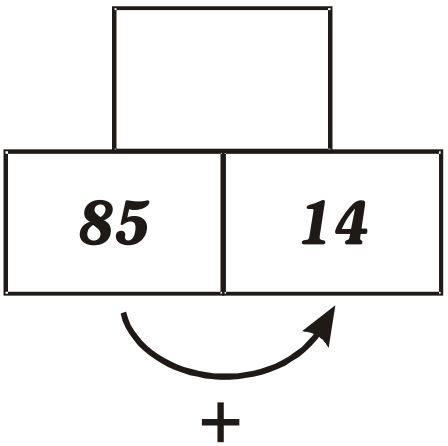



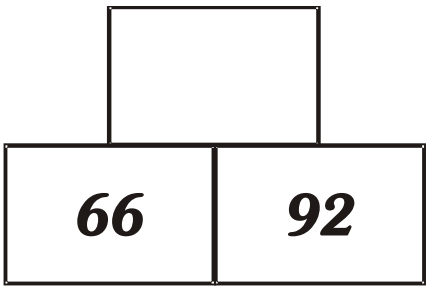

www.Matematica1.com

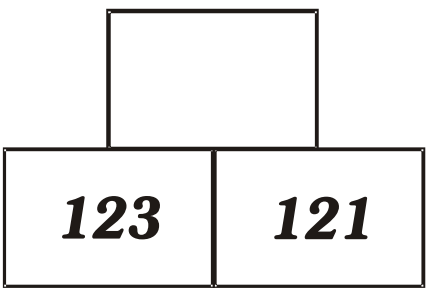

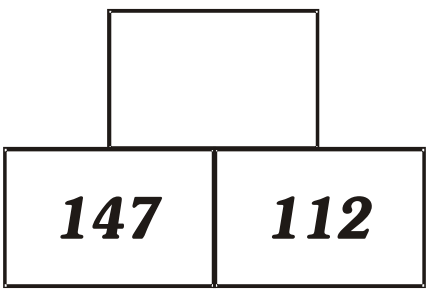

PRÁCTICA DE PIRÁMIDES

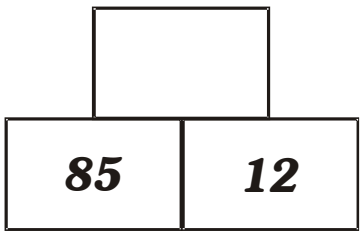

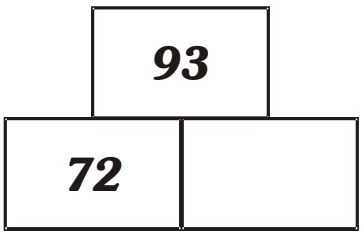

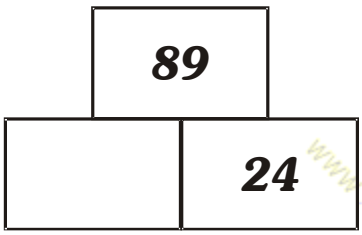

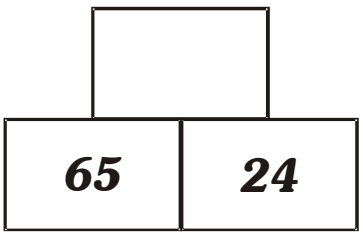

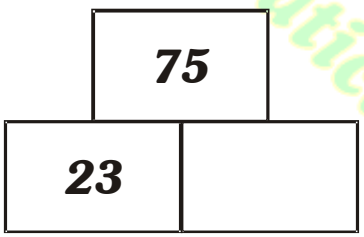

www.Matematica1.com

DIFERENTES

▶ **Pinta las figuras diferentes de cada renglón.**

DIFERENTES

► ***Marca la figura diferente de cada nube.***





FIGURAS DIFERENTES

▶ ***Marca con x la figura diferente.***

1)

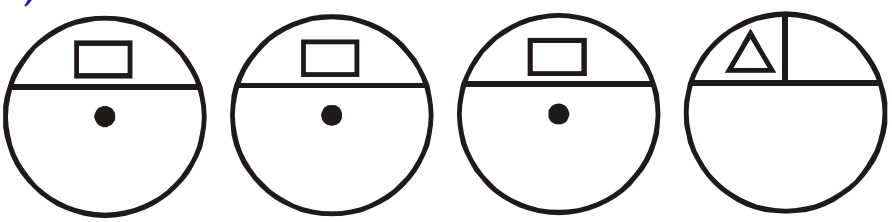

2)



3)

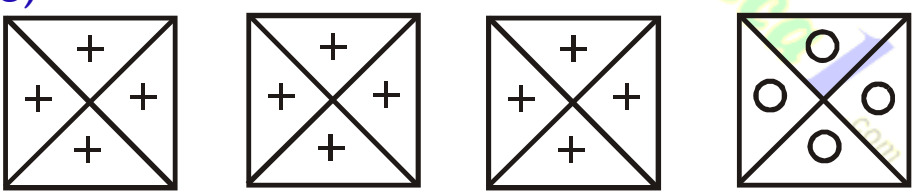

4)



CÁLCULO MENTAL

▶ ***Observa la clave y resuelve los ejercicios.***

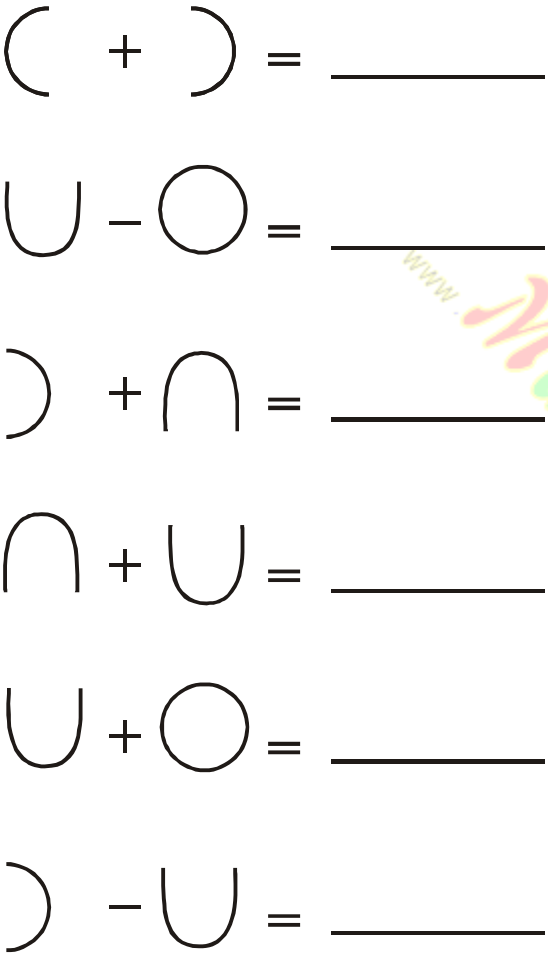



www.Matematica1.com

CÁLCULO MENTAL

▶ ***Colorea el cuadro del resultado correcto.***

26 + 5	41	31	51
62 + 8	80	60	70
75 + 5	80	52	89
120 + 20	150	140	160
142 + 42	384	284	184
186 + 13	199	299	99

72 - 21	41	51	31
89 - 45	64	34	44
126 - 113	13	23	33
189 - 145	44	64	74
200 - 100	10	100	20
163 - 22	141	161	171

▶ ***Resuelve y colorea los resultados como corresponde.***

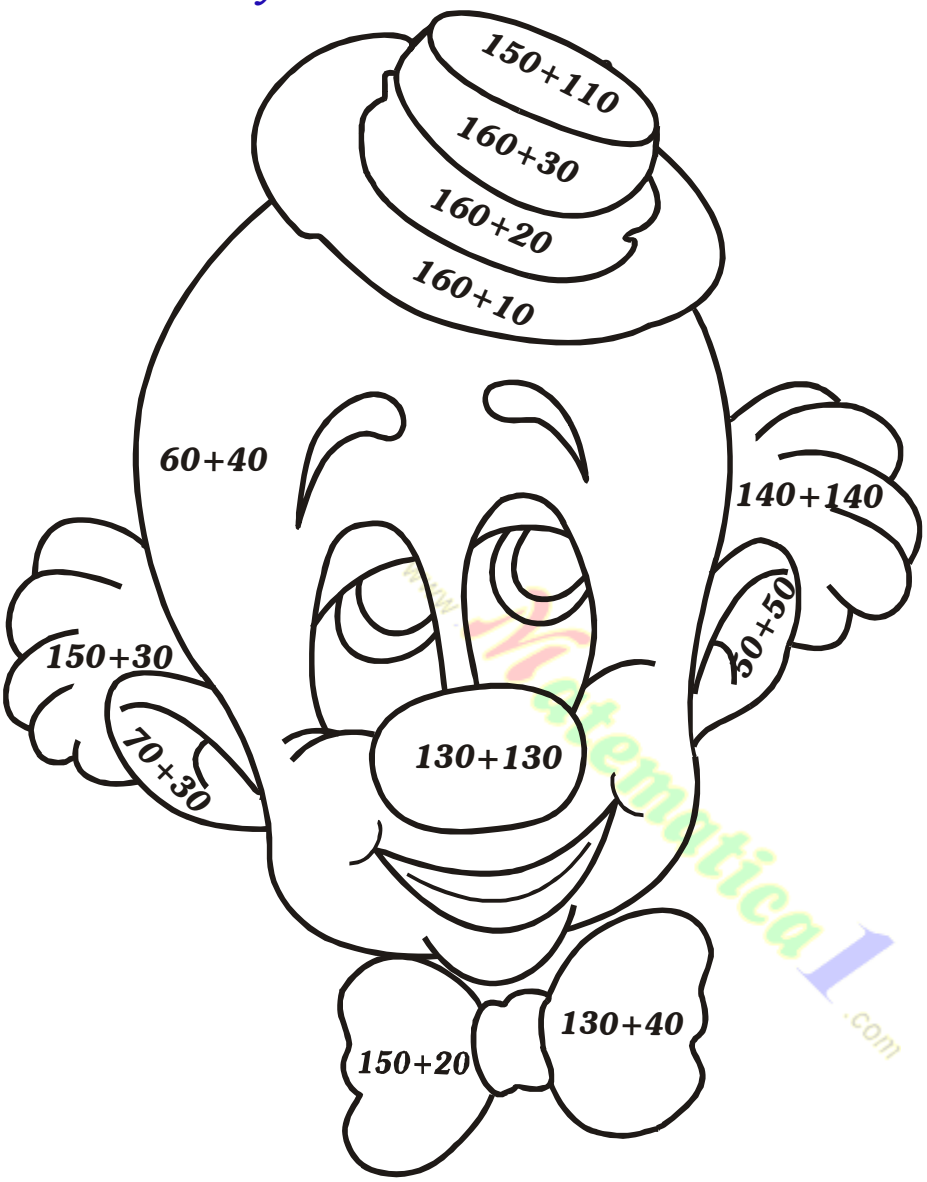

Color

260	rojo
170	amarillo
180	verde
190	azul
100	rosado

PROBLEMAS – PROBLEMITAS

1) *¿Cuántas patas hay en 3 mesas?* = _____

2) *Un número > de 60 y < a 62* = _____

3) *¿Cuántas llantas hay en 2 triciclos?* = _____

4) *¿Cuánto es 9 – 3?* = _____

5) *¿Cuánto le falta a 8 para ser 20?* = _____

6) *¿Qué número está después de 48?* = _____

7) *¿Qué número está entre 69 _____ 71?* = _____

8) *¿Cuánto le sobra a 20 para ser 15?* = _____

www.Matematica1.com

MEMORIA VISUAL

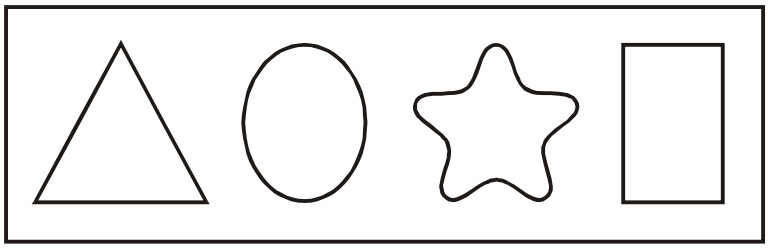

www.Matematica1.com

► ***Observa las figuras de cada renglón luego tápalas y dibuja en los espacios en blanco.***

DISCRIMINACIÓN VISUAL



▶ ***Dibuja el símbolo debajo de las figuras.***







SUCESIONES GRÁFICAS

▶ Dibuja la figura que sigue.

1)

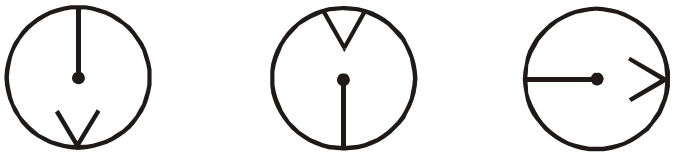

2)

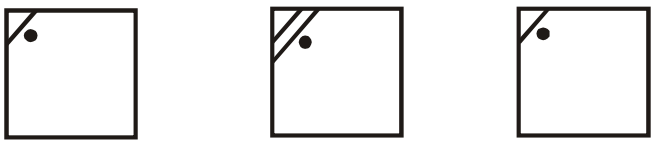

3)



4)

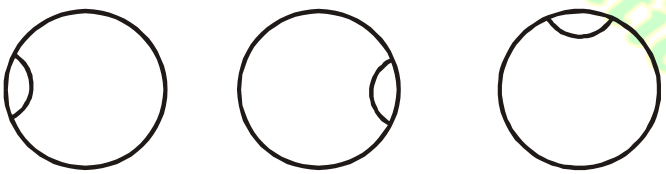

5)

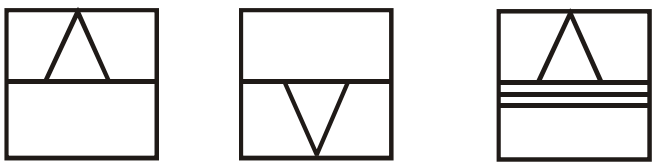

6)

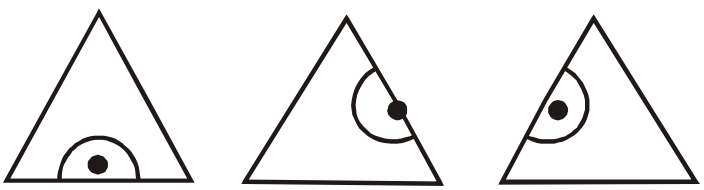

7)



www.Matematica1.com

SUCESION NUMÉRICA

ASCENDENTE

+5

75 80

+4

66 70

+1

52 53

+5

49 54

+2

61 63

+4

33 37

www.Matematica1.com

1)

2)

3)

4)

5)

6)

7)

8)

9) 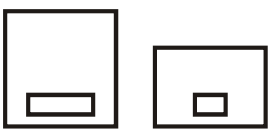

10)

11)

SIGUE LAS SERIES

www.Matematica1.com

A)



B)



C)

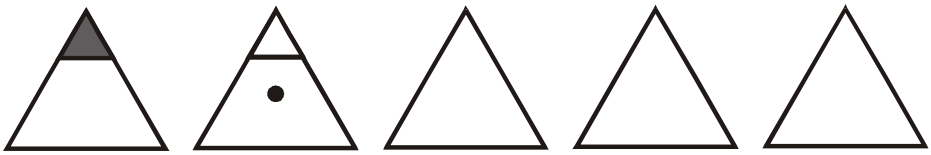

D)



E)



F)



G)

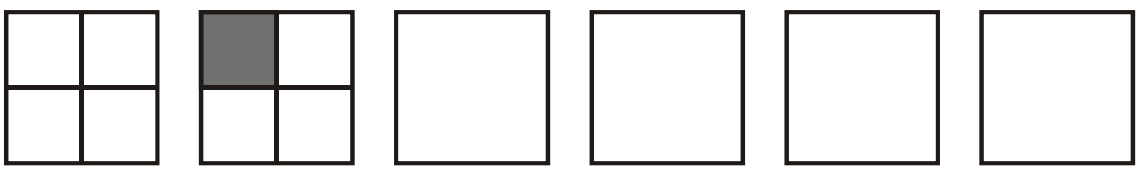

www.Matematica1.com

SERIES GRÁFICAS

1)

2)

3)

4)

5)

6)

7)

8)

9) 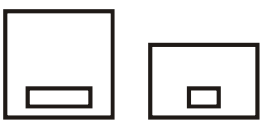

10)

11)

www.Matematica1.com

COMPLETA LA SERIE

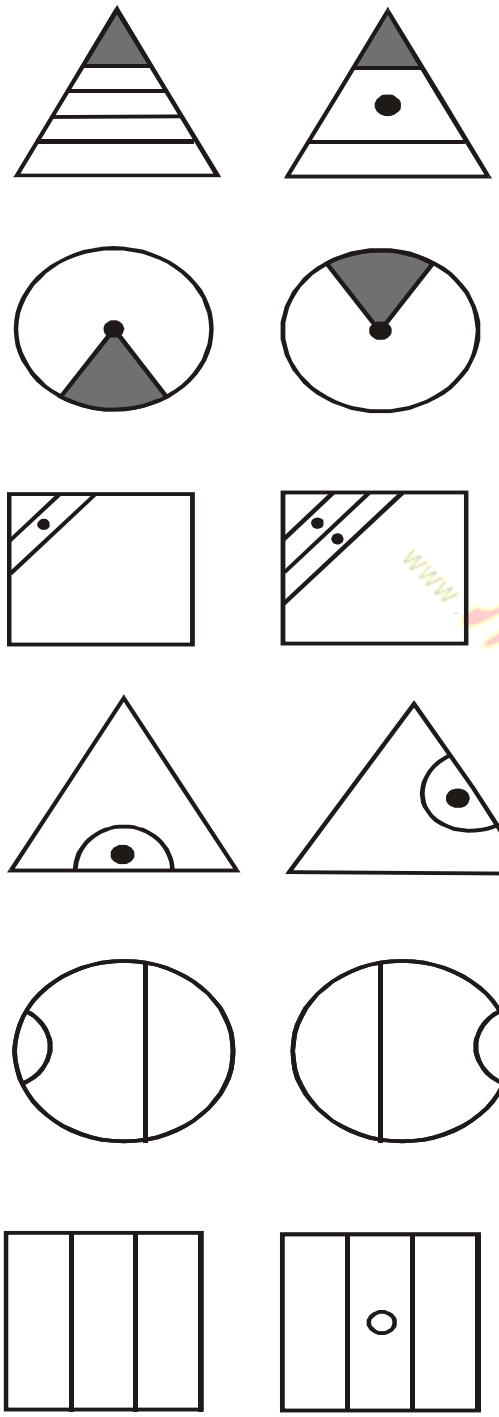

www.Matematica1.com

SERIACIONES NUMÉRICAS

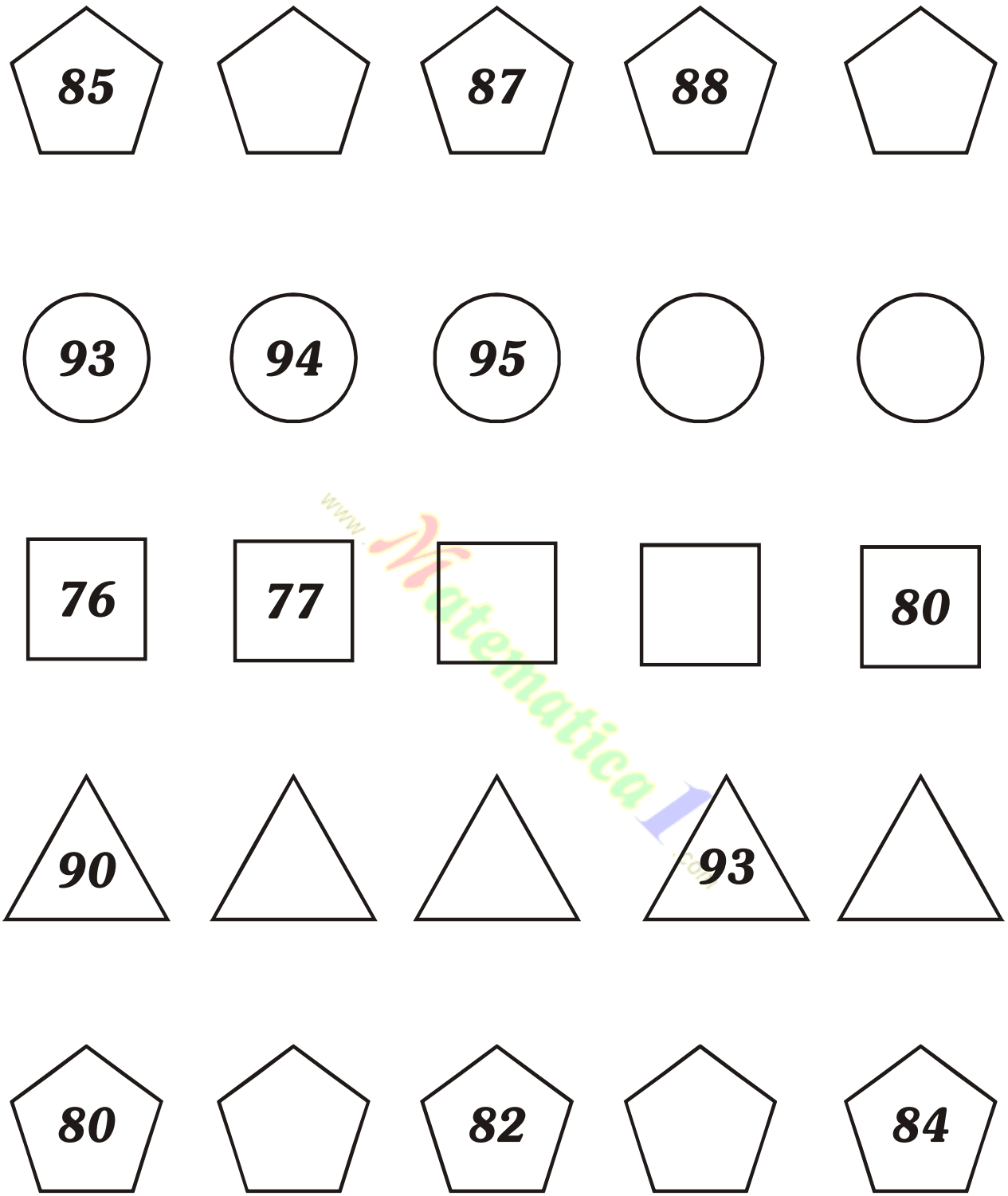

▶ Continúa la serie numérica.

SERIE NUMÉRICAS

▶ Cuenta y completa la serie



www.Matematica1.com

SERIES NUMÉRICAS

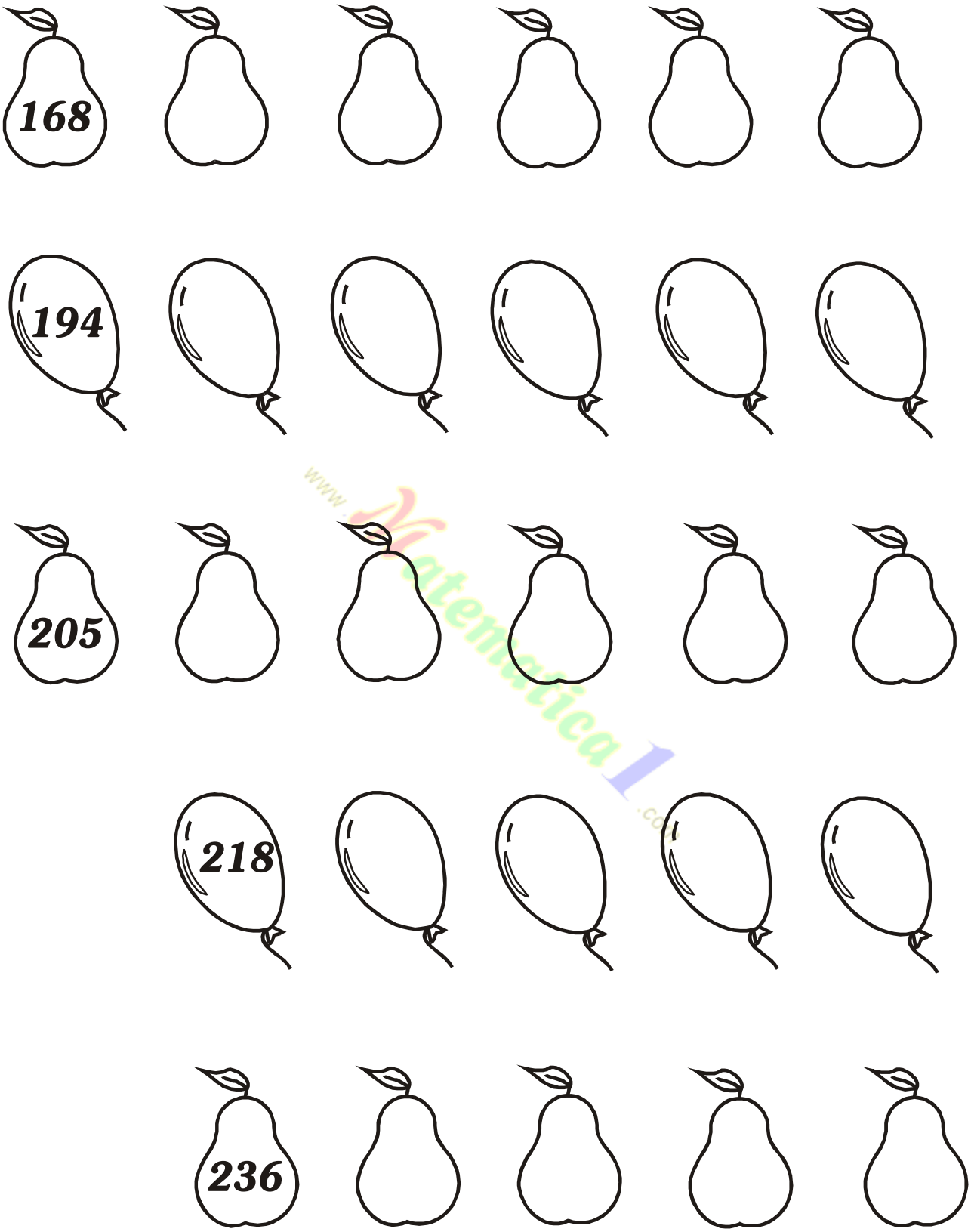

▶ Completar las series

www.Matematica1.com

SERIE NUMÉRICA







www.Matematica1.com

SUCESIONES GRÁFICAS



www.Matematica1.com

SUCESIONES GRÁFICAS



SUCESIONES GRÁFICAS

▶ Dibuja la figura que sigue.

1) 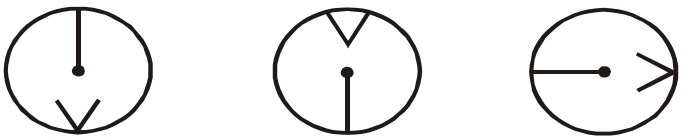

2) 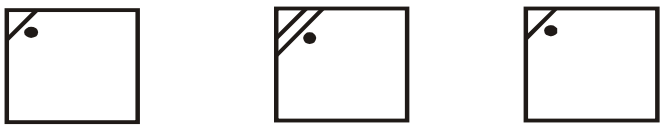

3) 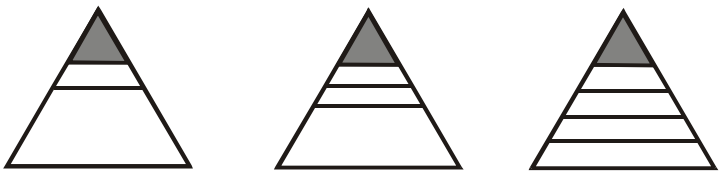

4) 

5) 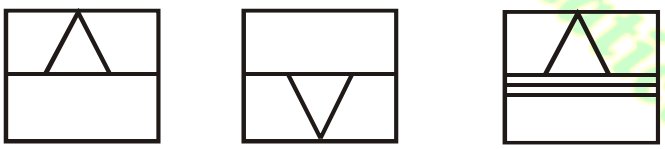

6) 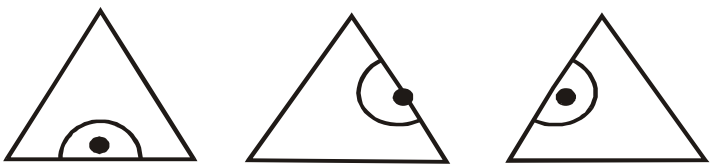

7) 

www.Matematica1.com

SUCESION NUMÉRICA

ASCENDENTE

+5

75 80

+4

66 70

+1

52 53

+5

49 54

+2

61 63

+4

33 37

www.Matematica1.com

SUCESIONES NUMÉRICAS

Descendente









www.Matematica1.com

REALIZA SUCESIONES NUMÉRICAS









Completa las sucesiones numéricas

1) 232 +3

2) 305 +2

3) 289 −3

4) 310 −3

5) 248 +4

6) 263 +5

7) 270 −6

www.Matematica1.com

CONTAMOS FIGURAS

▶ ¿Cuántas figuras hay?

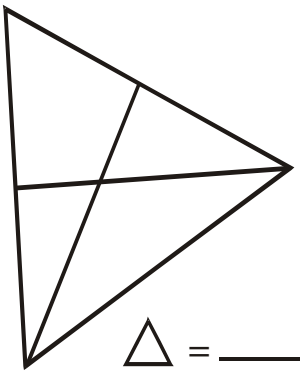

△ = _____

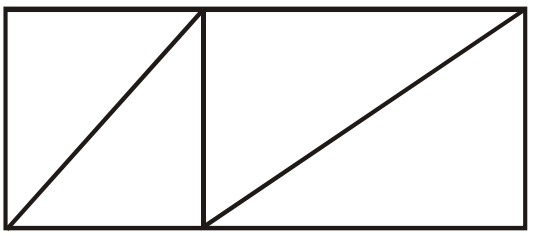

△ = _____

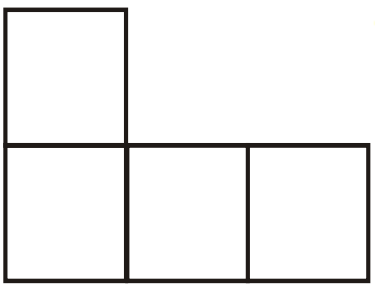

□ = _____

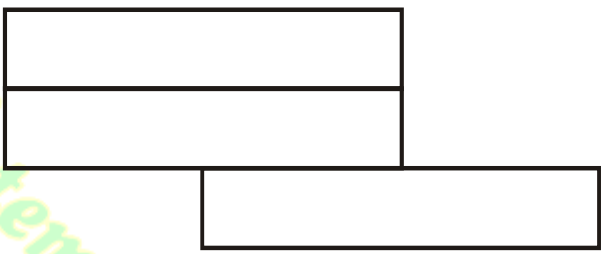

▭ = _____

www.Matematica1.com

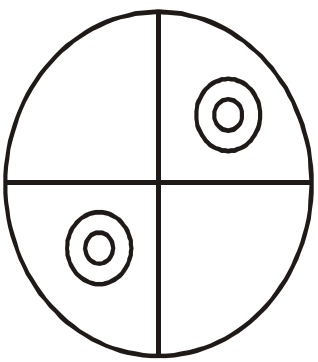

○ = _____

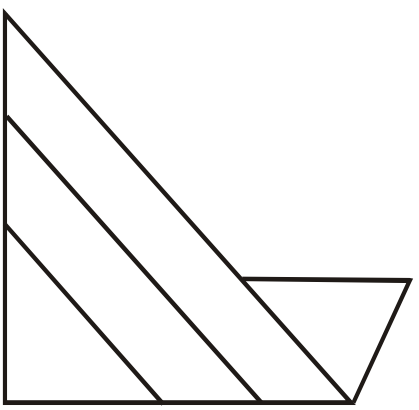

△ = _____

Encuentra el número...

□ 2 +	□ 5 +	□ 9 +
5 □	5 □	3 □
9 8	8 7	9 9
□ 4 +	5 □ +	7 6 +
3 □	□ 2	□ 3
7 8	1 0 5	1 1 □
7 □ +	8 □ +	4 □ +
□ 2	□ 3	□ 3
1 2 5	1 2 6	1 1 6

www.Matematica1.com

RESTAS INCOMPLETAS

□	8	−
6	□	
3	6	

9	□	−
□	5	
7	4	

□	7	−
6	□	
2	5	

6	□	−
□	5	
4	2	

9	□	−
□	2	
4	5	

8	□	−
□	2	
3	1	

3	□	−
□	2	
2	7	

7	□	−
□	3	
2	1	

www.Matematica1.com

SUMAS Y RESTAS INCOMPLETAS

$$\begin{array}{r} 5\ \square\ + \\ \square\ 2 \\ \hline 1\ 2\ 9 \end{array} \qquad \begin{array}{r} \square\ 8\ + \\ 2\ \square \\ \hline 7\ \ 9 \end{array} \qquad \begin{array}{r} 9\ \square\ + \\ \square\ 3 \\ \hline 11\ 5 \end{array}$$

$$\begin{array}{r} 9\ \square\ - \\ \square\ 2 \\ \hline 6\ \ 4 \end{array} \qquad \begin{array}{r} \square\ 8\ - \\ 2\ \square \\ \hline 7\ \ 4 \end{array} \qquad \begin{array}{r} 7\ \square\ - \\ \square\ 1 \\ \hline 2\ \ 7 \end{array}$$

$$\begin{array}{r} 6\ \square\ + \\ \square\ 3 \\ \hline 1\ 4\ \ 9 \end{array} \qquad \begin{array}{r} 2\ \square\ + \\ 1\ \ 8 \\ \hline \square\ \ 1 \end{array}$$

Resuelve ¡Es fácil!

www.Matematica1.com

RAZONES

¿Cuántas llantas hay en 3 bicicletas?

¿Cuánto le sobra a 18 para ser una decena?

www.Matematica1.com

Una camisa tiene 4 botones ¿Cuántos botones se necesitará para 2 camisas?

Tres números menores que 99.

Pepe compra 3 caramelos, 3 panes y 7 chupetines. ¿Cuántos dulces compró?

¿Qué número está entre 69 y 71?

¿Qué número se forma con 8 decenas y 1 unidad?

www.Matematica1.com

¿Cuánto le falta a 6 para ser 10?

Problemas de Razonamiento

1) *¿Cuántas días tiene una semana?* _____

2) *El número que tiene 9 decenas y 9 unidades es*

_____

3) *Súmale 2 a 9 y tenemos el número*

_____

4) *Réstale 4 a 10 y tenemos el número*

_____

5) *El número 57 tiene* _____ *decenas y* _____ *unidades.*

6) *Roberto tiene 7 años y Fiorella 2 años más que él. Fiorella tiene* _____ *años.*

7) *El número anterior a 52 es*

_____

8) *El resultado de 52 + 8 es*

_____

9) *¿Cuánto le falta a 7 para que llegue a 12?*

_____

10) *Escribe el menor número con estos dígitos 5 y 1*

_____

www.Matematica1.com

PIRÁMIDES

▶ Hallar el valor de los espacios vacíos.

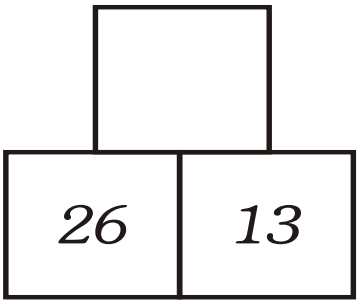

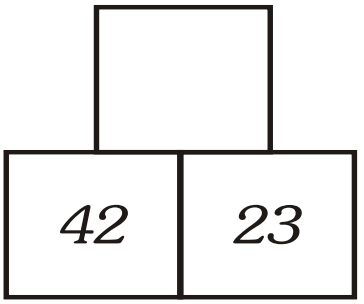

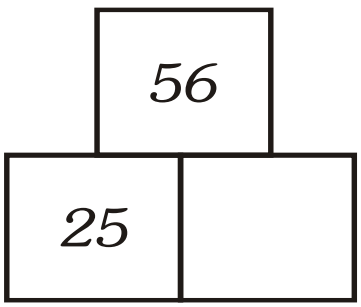

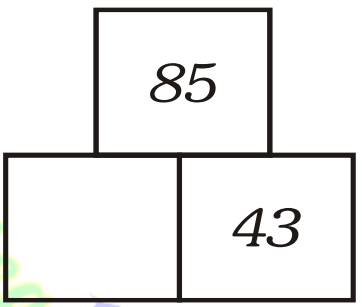

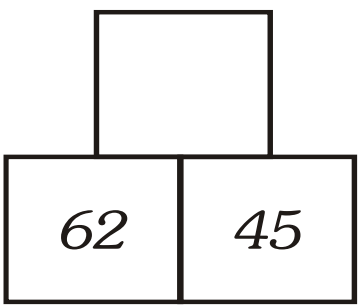

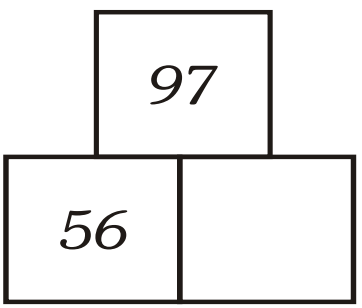

www.Matematica1.com

RESUELVE PIRÁMIDES

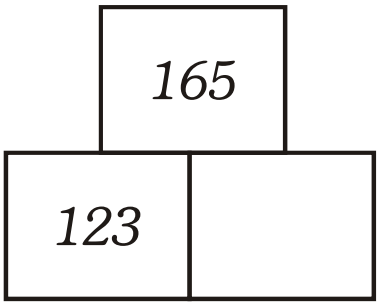

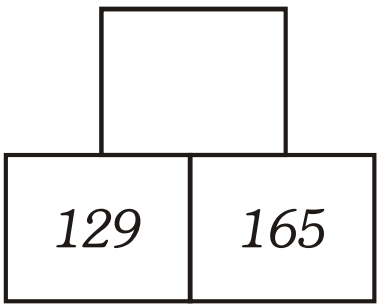

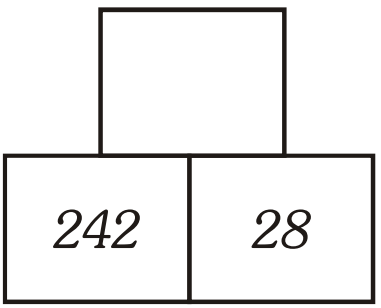

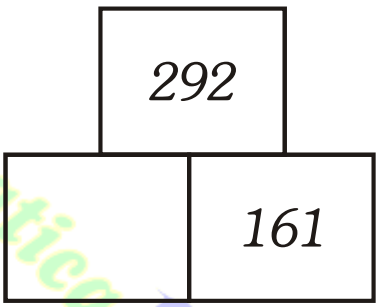

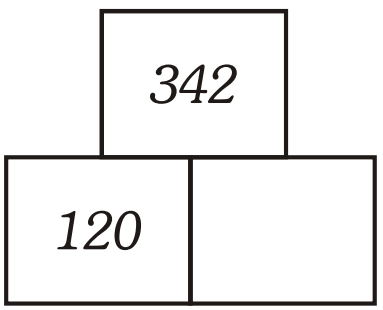

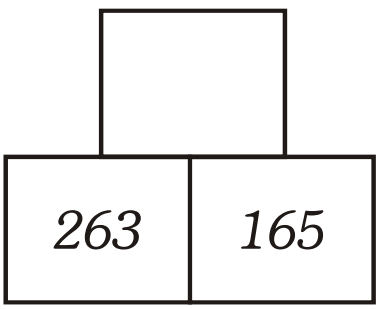

www.Matematica1.com

PIRÁMIDES NUMÉRICAS

11 9	150 7	146 6
101 9	87 7	192 8
176 4	65 10	111 9

www.Matematica1.com

Práctica Calificada

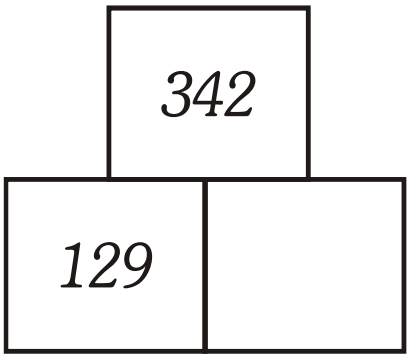

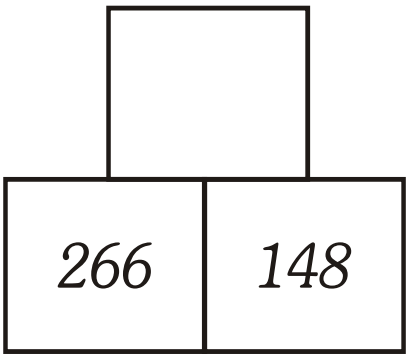

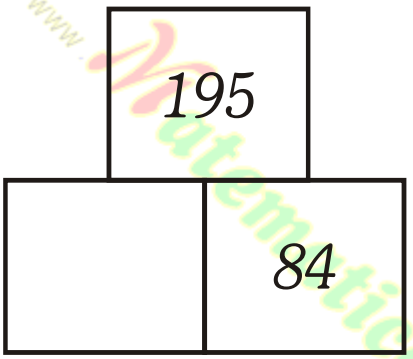

www.Matematica1.com

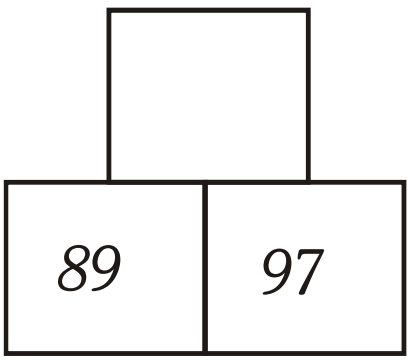

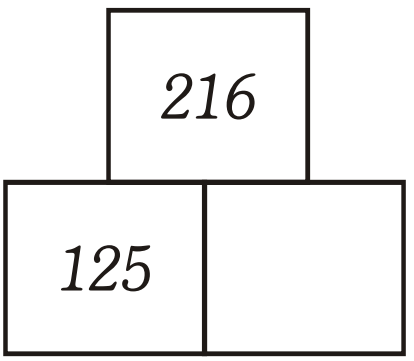

Averiguo el valor de:

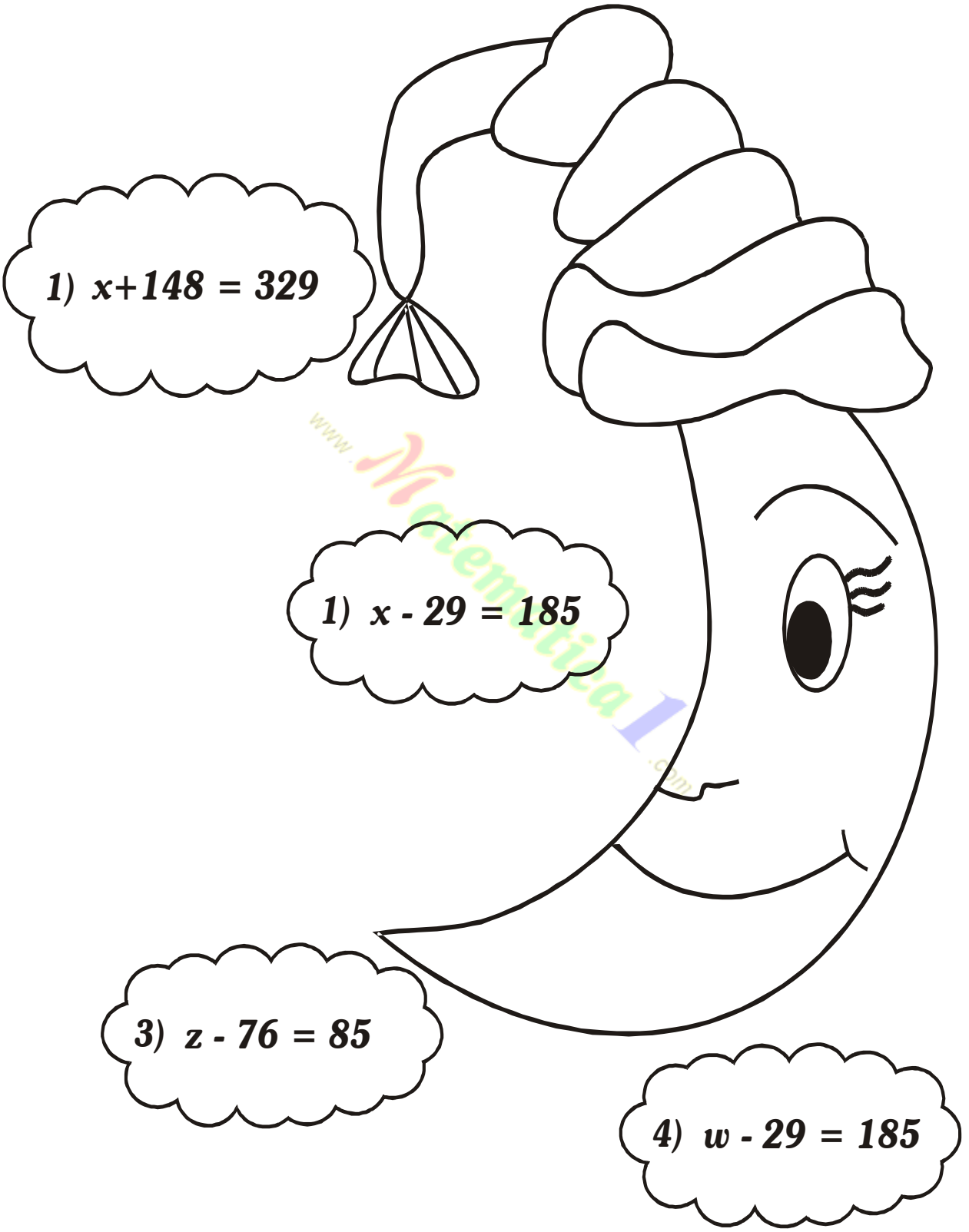

PRÁCTICA CALIFICADA

▶ Resuelve ecuaciones

$x + 136 = 268$

$y + 87 = 129$

$n - 212 = 168$

$n - 85 = 126$

$z + 242 = 365$

www.Matematica1.com

Trasladamos figuras modificándolas

1. **observa y termina de colorear:**

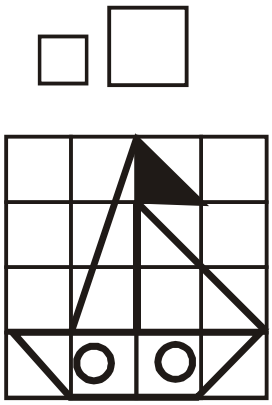

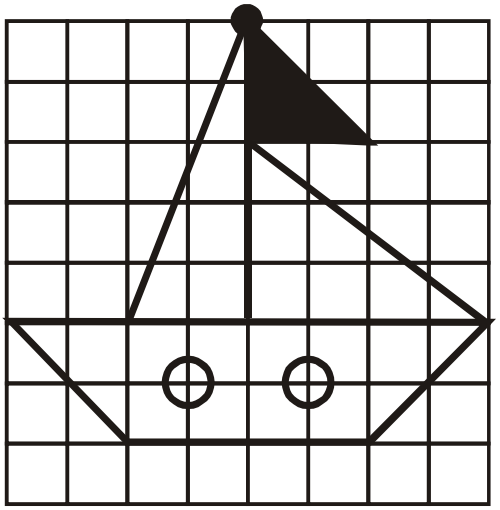

2. **Copia agrandando:**



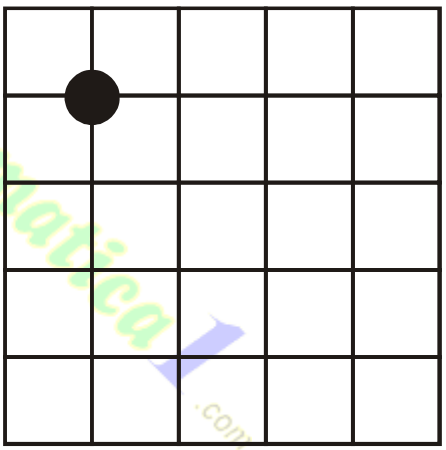

3. **Copia agrandando y coloreando:**



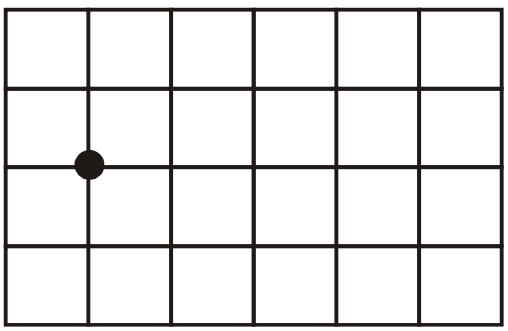

REPRODUCIR FIGURAS

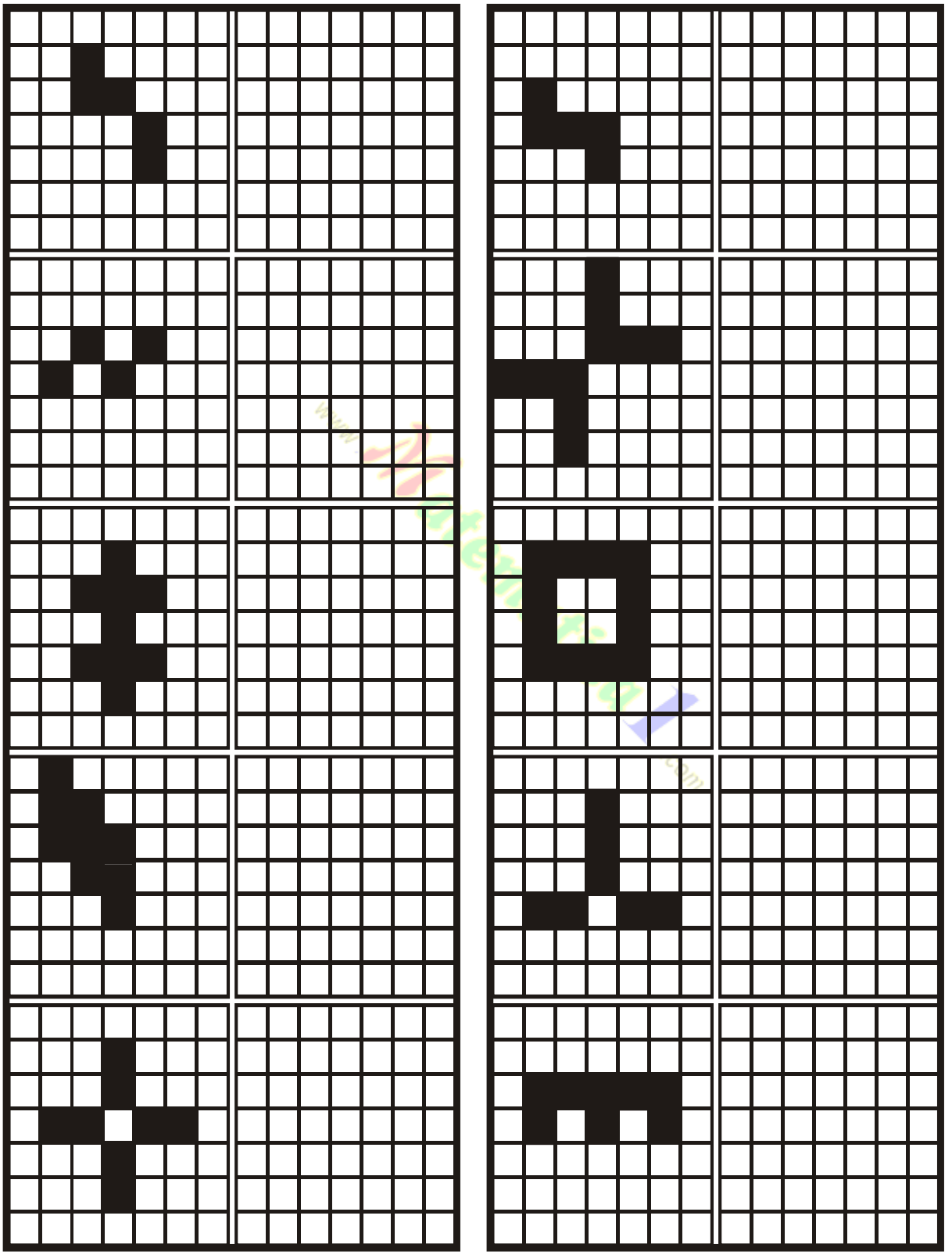

ANALOGÍAS

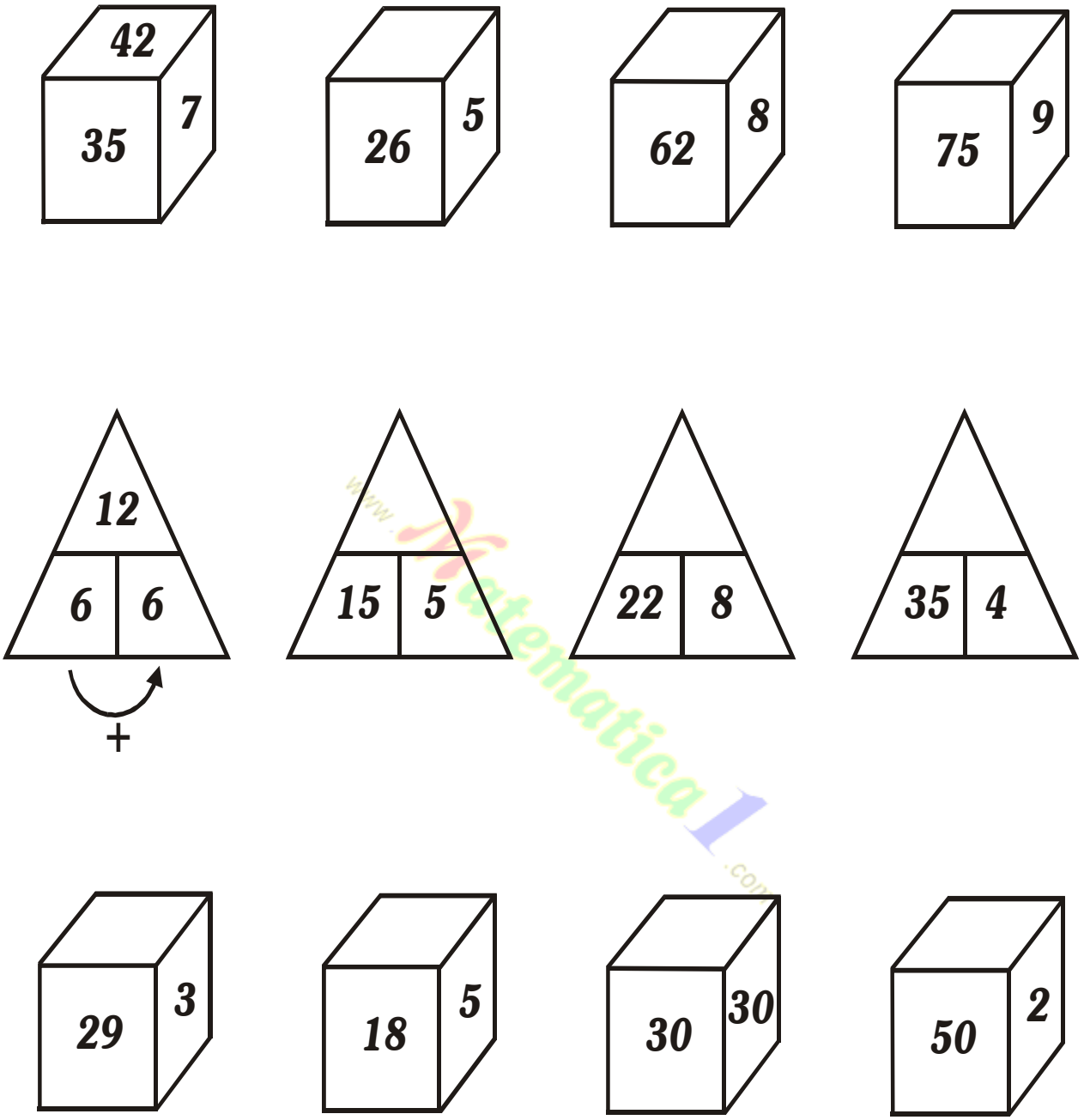

▶ Resuelve las analogías.

ANALOGÍAS NUMÉRICAS

www.Matematica1.com

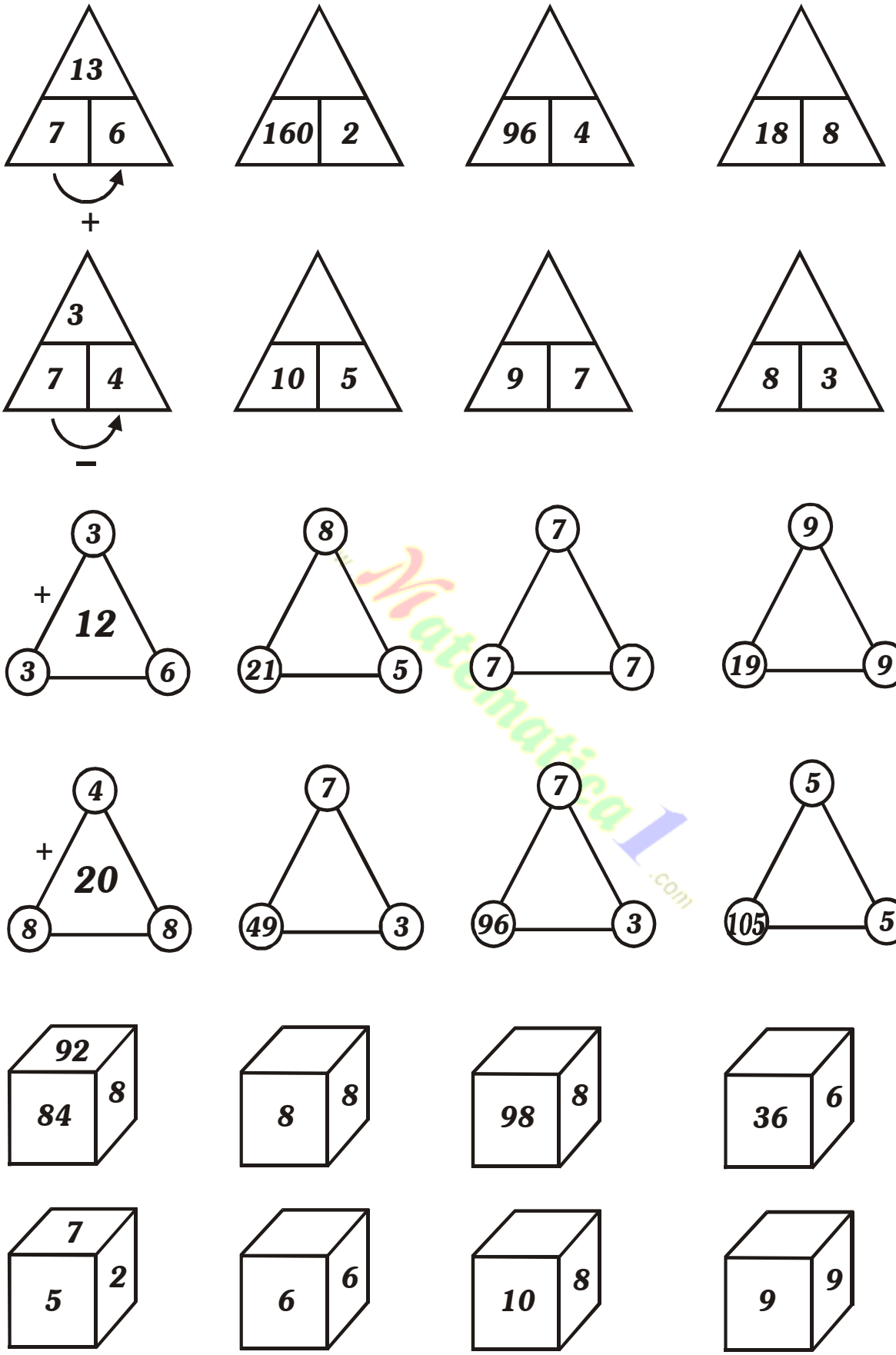

Matematica1.com

ANALOGÍAS NUMÉRICAS

▶ Falta un número ¿Cuál es?

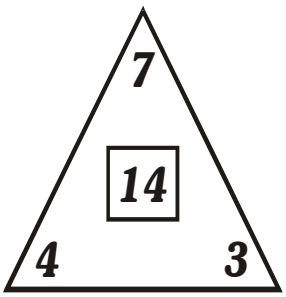

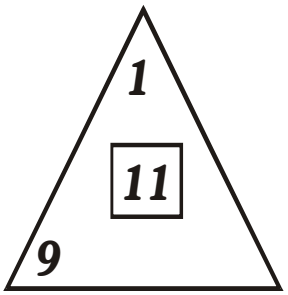

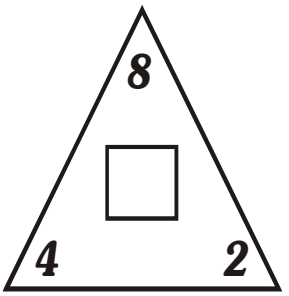

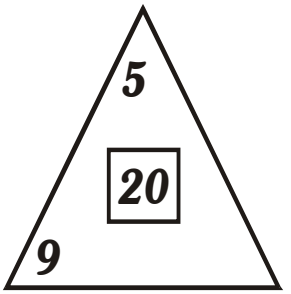

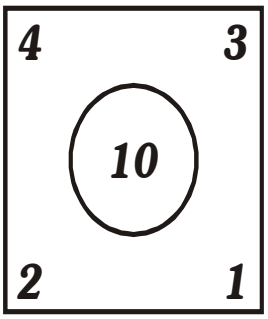

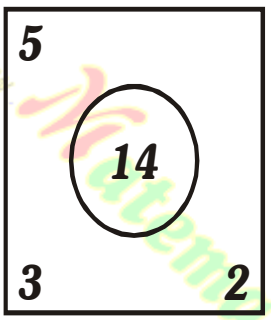

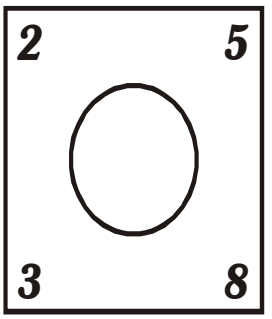







www.Matematica1.com

PRÁCTICA CALIFICADA

1. Completa las analogías

A)

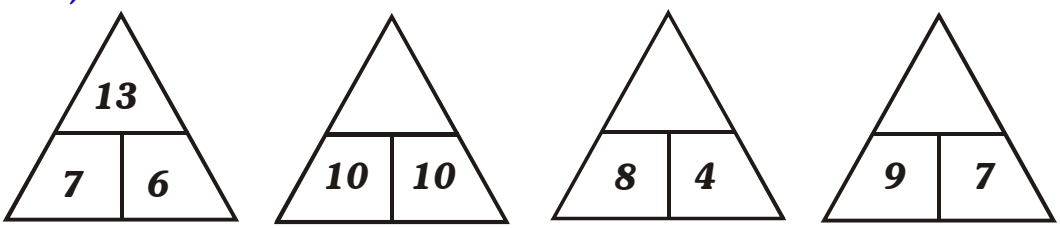

B)

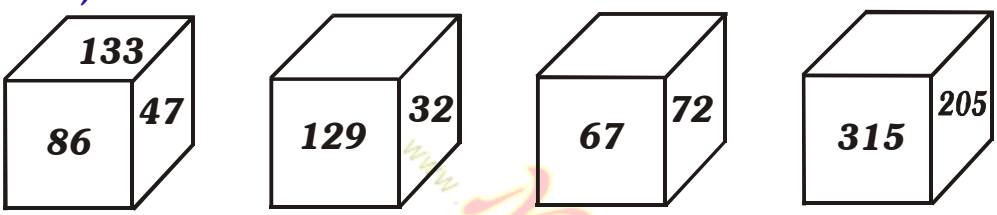

2. ¿Qué número falta?

A)

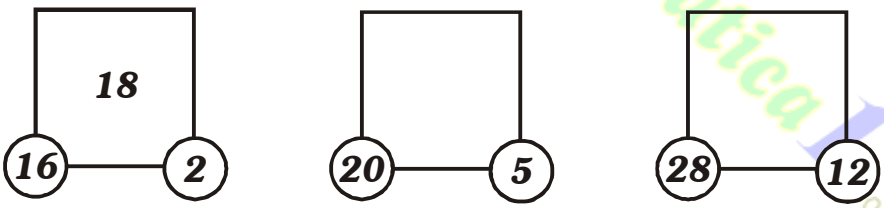

B)



SUMAS INCOMPLETAS

5 □ +	□ 5 +	6 □ +
4 6	2 □	□ 0
9 9	4 7	8 3
□ 5 +	6 □ +	□ □ +
□ 1	□ 3	2 □
6 6	9 7	5 8
□ 0 +	□ 3 +	□ 5 +
6 □	4 □	□ □
9 7	6 9	4 7
□ 1 +	1 □ +	□ □ +
3 □	□ 2	6 2
7 6	9 4	9 8

www.Matematica1.com

RESTAS INCOMPLETAS

$$\begin{array}{r} 9\ \square \\ \square\ 3 \\ \hline 3\ 2 \end{array} -$$

$$\begin{array}{r} 8\ 9 \\ \square\ \square \\ \hline 2\ 1 \end{array} -$$

$$\begin{array}{r} \square\ 0 \\ 3\ \square \\ \hline 6\ 0 \end{array} -$$

$$\begin{array}{r} \square\ \square \\ 4\ 1 \\ \hline 3\ 4 \end{array} -$$

$$\begin{array}{r} \square\ 9 \\ 4\ \square \\ \hline 4\ 5 \end{array} -$$

$$\begin{array}{r} 7\ \square \\ \square\ 4 \\ \hline 2\ 2 \end{array} -$$

$$\begin{array}{r} \square\ 9 \\ 5\ \square \\ \hline 4\ 7 \end{array} -$$

$$\begin{array}{r} 8\ 4 \\ \square\ \square \\ \hline 5\ 3 \end{array} -$$

$$\begin{array}{r} \square\ 2 \\ 2\ \square \\ \hline 7\ 0 \end{array} -$$

www.Matematica1.com

ADICIONES EN PIRÁMIDES

282	151

232	210

140	112

360	131

168	243

www.Matematica1.com

¡JUGUEMOS CON PIRÁMIDES!

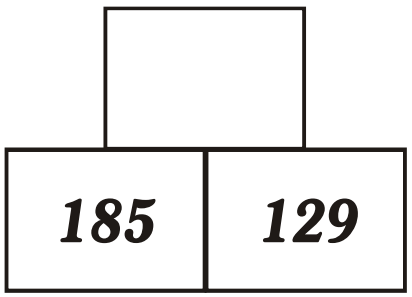

www.Matematica1.com

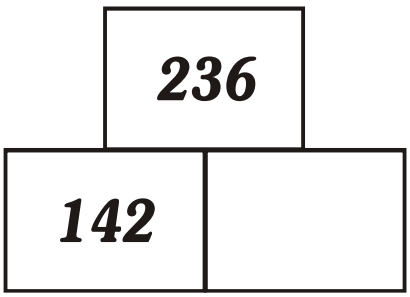

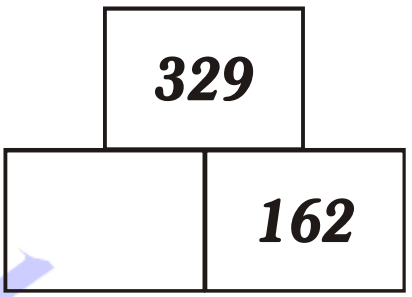

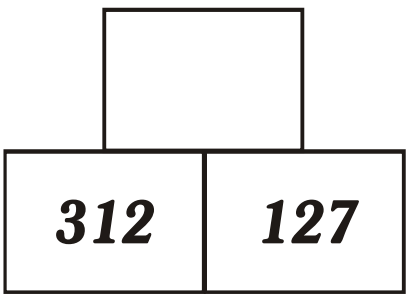

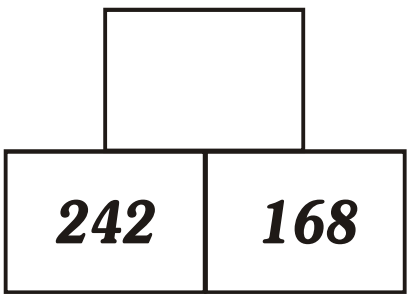

RESUELVE LAS PIRÁMIDES

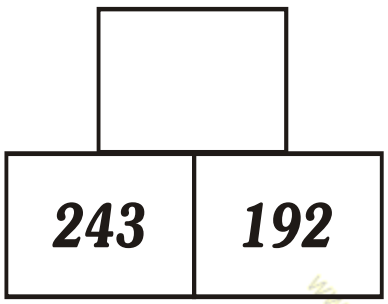

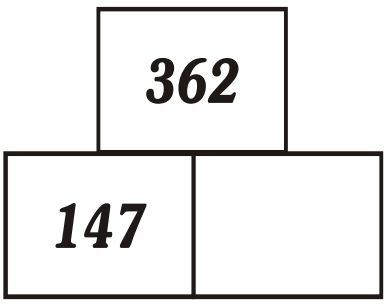

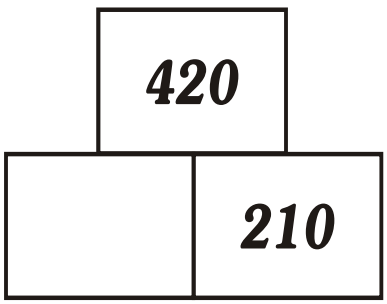

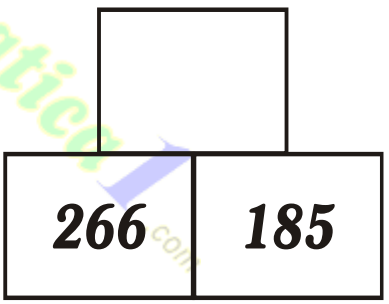

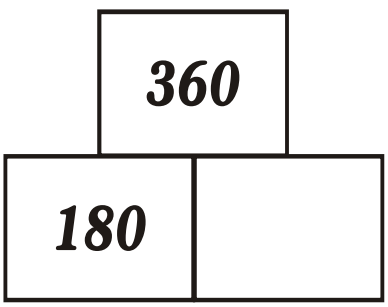

www.Matematica1.com

FIGURA DIFERENTE

▶ Encierra la figura diferente.

A) *Uno no tiene 4 lados.*

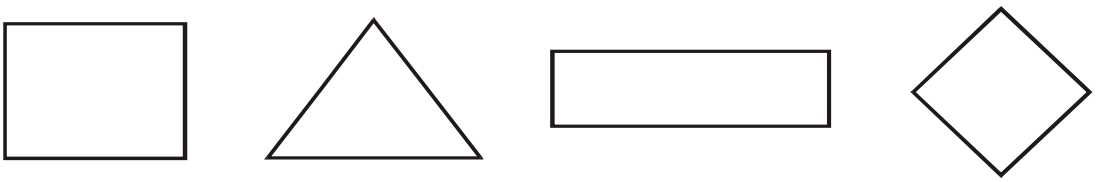

B) *¿Qué figura es diferente?*

1)

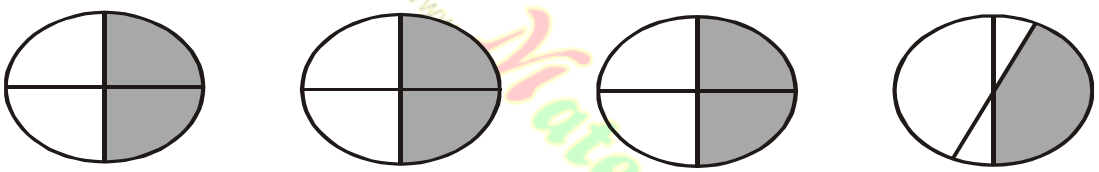

2)

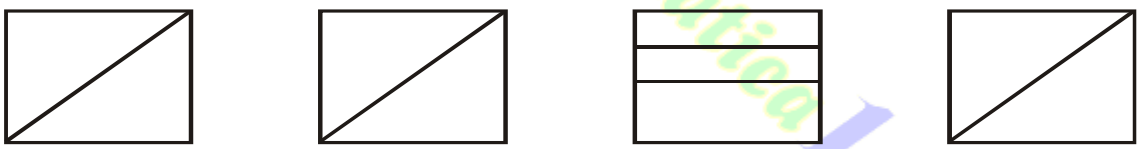

3)

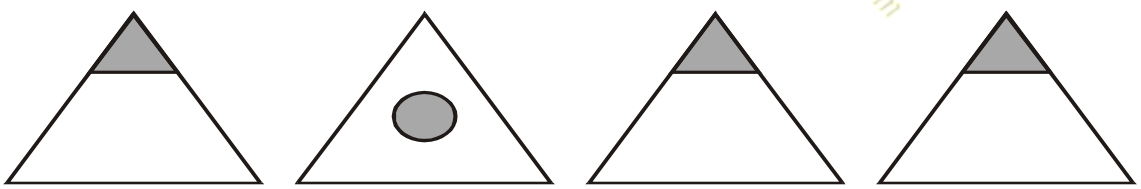

4)

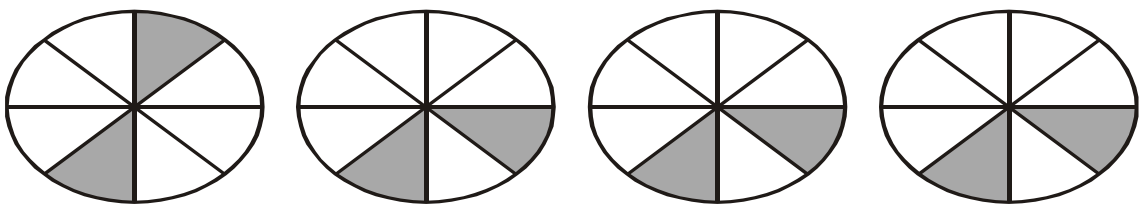

www.Matematica1.com

▶ Dibuja una figura diferente a

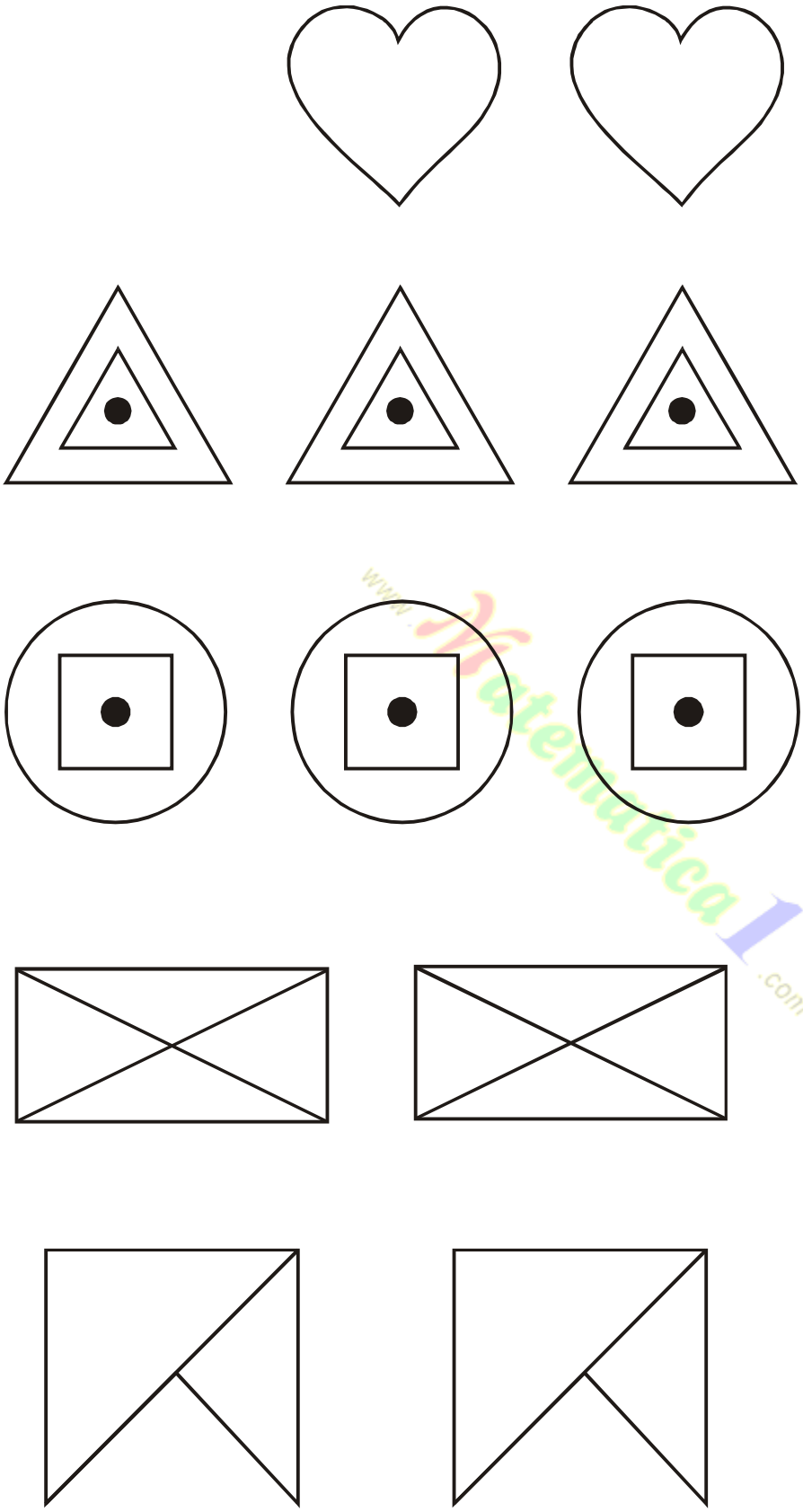

www.Matematica1.com

www.Matematica1.com

Completa:



400		402			405				409
410			413				417		
420					425				
430				434					
440							447		
450					455				
460									469
470			473						
480						486			
490								498	

www.Matematica1.com

Escribe el número:

445 → _____

479 → _____

436 → _____

481 → _____

499 → _____

500 → _____

Resuelve y escribe el número donde corresponde: par o impar.

559 – 125

611 – 210

849 – 433

148 + 323

241 + 182

239 + 241







www.Matematica1.com

¡VAMOS A GRAFICAR!

* **Ordena y grafica según te indiquen.**



Ejem: 4D 3U 1C Rpta: 1C 4D 3U 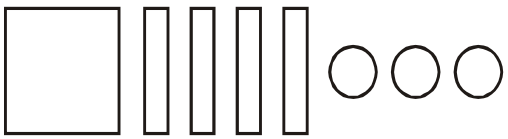	4C 2D 8U Rpta:
4U 2D 4C Rpta:	6D 4U 3C Rpta:
2D 9U 4C Rpta:	3C 2D 1U Rpta:
4C 3U 2D Rpta:	7U 4D 3C Rpta:

www.Matematica1.com

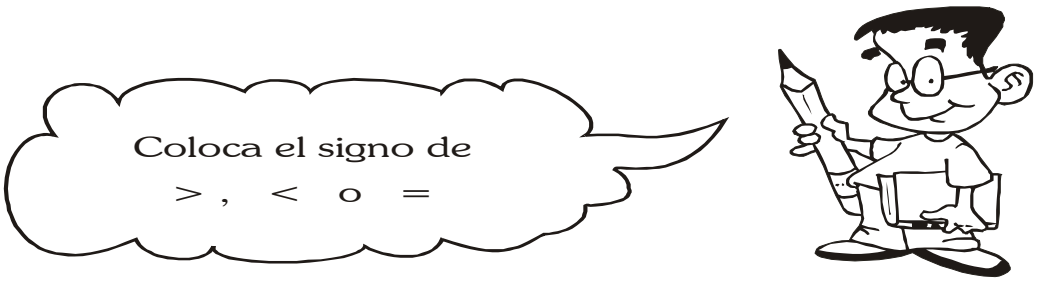

424	_____	440	150 + 2	_____	140 + 5
439	_____	242	255 – 2	_____	258 – 5
445	_____	445	141 + 0	_____	144 – 1
345	_____	145	241 + 0	_____	244 – 1
359	_____	431	164 + 4	_____	263 + 6
448	_____	369	140 + 9	_____	149 – 0
351	_____	341	268 + 3	_____	268 – 7

Escribe números mayores de ..... y menores de ..... teniendo en cuenta el signo.

448	<	_____	_____	>	444
_____	>	400	454	>	_____
_____	=	500	_____	<	484
_____	<	349	_____	=	400
469	>	_____	_____	<	499
_____	=	302	479	>	_____
_____	=	408	_____	=	300
_____	<	494	_____	<	500

www.Matematica1.com

Resuelve y escribe el número posterior a:

167 –
38
167 ⇨ 130

148 –
47
101 ⇨ 102

477 –
39
⇨ ☐

463 –
42
⇨ ☐

555 –
150
⇨ ☐

561 –
71
⇨ ☐

698 –
442
⇨ ☐

497 –
53
⇨ ☐

748 –
259
⇨ ☐

492 –
92
⇨ ☐

529 –
458
⇨ ☐

537 –
52
⇨ ☐

www.Matematica1.com

Ordenar en forma Ascendente:

474	431	465	446	481	456	400	425	500

_ _ _ _ _ _ _ _

247	456	345	397	497	470	425	480	434

_ _ _ _ _ _ _ _

Ordena en forma Descendente:

460	430	450	420	440	410	400	500	490

_ _ _ _ _ _ _ _

472	482	452	462	432	492	422	442	400

_ _ _ _ _ _ _ _

* Desarrolla las sumas, ubica los resultados y pinta de acuerdo a la tabla de colores:

58 +
16
9
_____

38 +
26
13
_____

66 +
29
10
_____

49 +
32
14
_____

53 +
28
23
_____

37 +
25
19
_____

49 +
32
28
_____

48 +
26
17
_____

25 +
18
13
_____

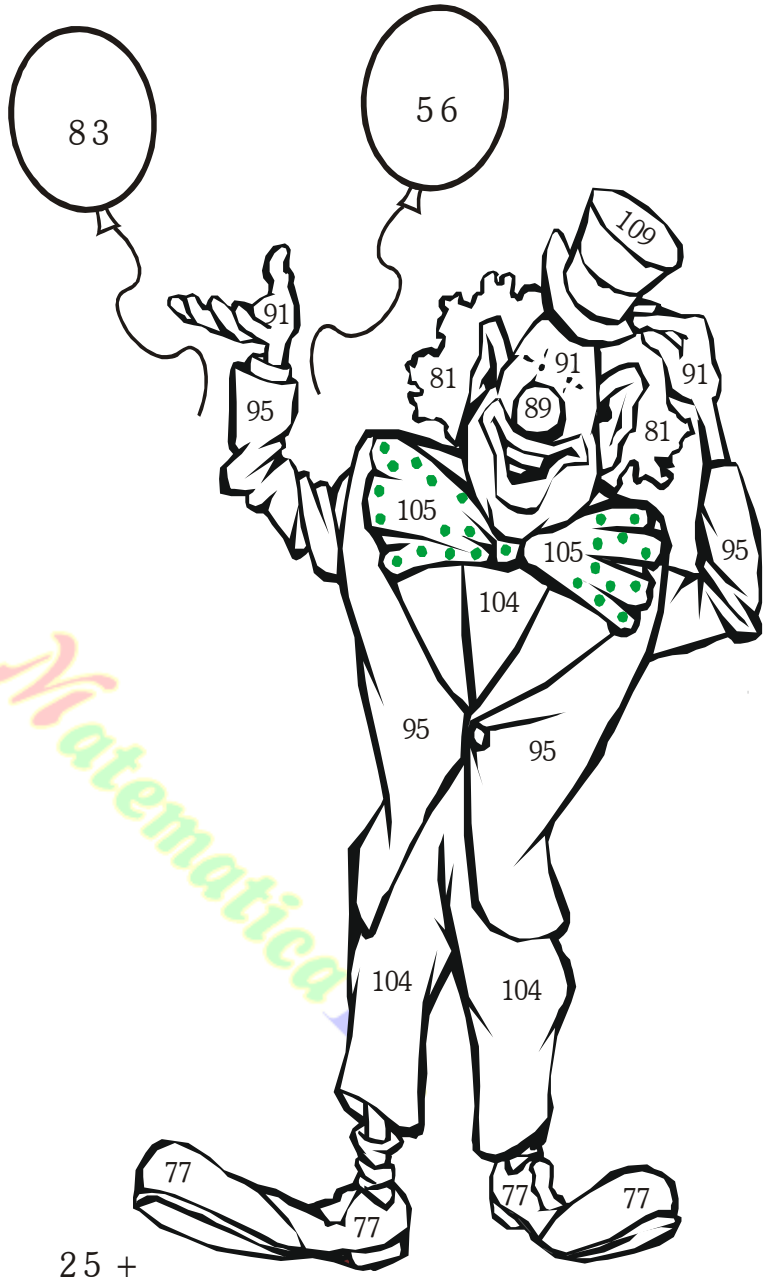

Tabla de Colores

ROJO	MARRON	AMARILLO	VERDE	NARANJA
83	77	105	95	104

MORADO	AZUL	BLANCO	ROSADO
81	109	91	56

www.Matematica1.com

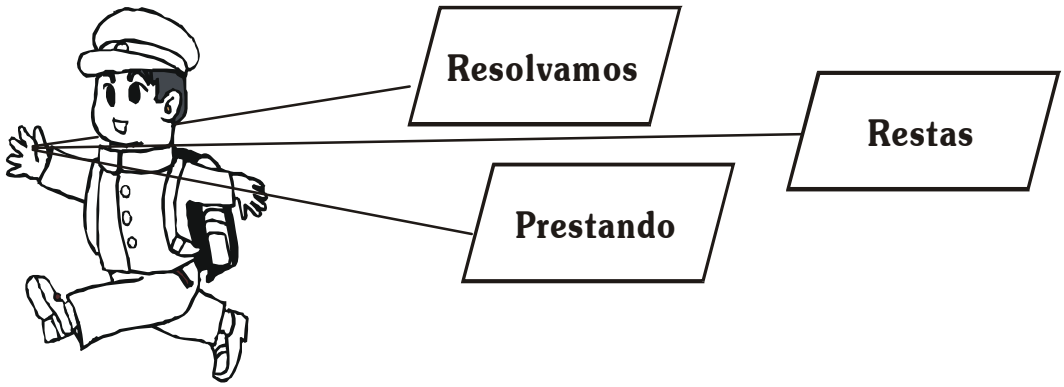

268 –
139

352 –
149

383 –
277

281 –
167

368 –
119

371 –
257

www.Matematica1.com

* Desarrolla:

–20

168	_____
176	_____
192	_____
283	_____
390	_____
263	_____
174	_____
383	_____

–41

362	_____
152	_____
241	_____
183	_____
190	_____
274	_____
361	_____
386	_____

* Resuelve las restas prestando:

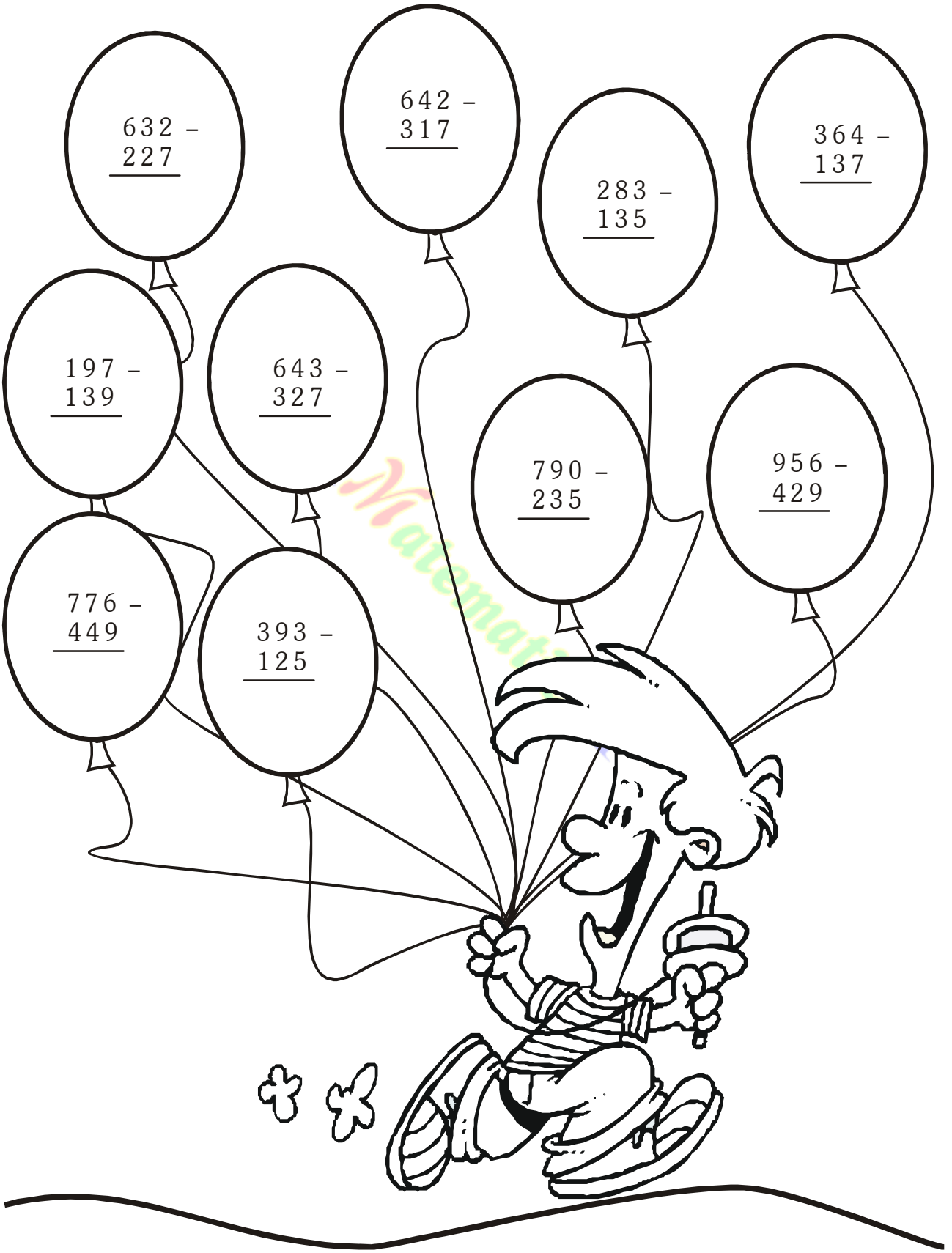





EL DOBLE

www.Matematica1.com

* Halla el doble en:

10 = _____

8 = _____

24 = _____

82 = _____

54 = _____

100 = _____

93 = _____

71 = _____

14 = _____

33 = _____

44 = _____

50 = _____

¿ Qué hábil eres!







LA MITAD

* Escribe la mitad de:

20 = _____ (amarillo)

84 = _____ (rojo)

24 = _____ (azul)

80 = _____ (morado)

100 = _____ (rosado)

60 = _____ (verde)

46 = _____ (naranja)

88 = _____ (celeste)

86 = _____ (marrón)

www.Matematica1.com

* Ubica los resultados y pinta de acuerdo a los colores dados:

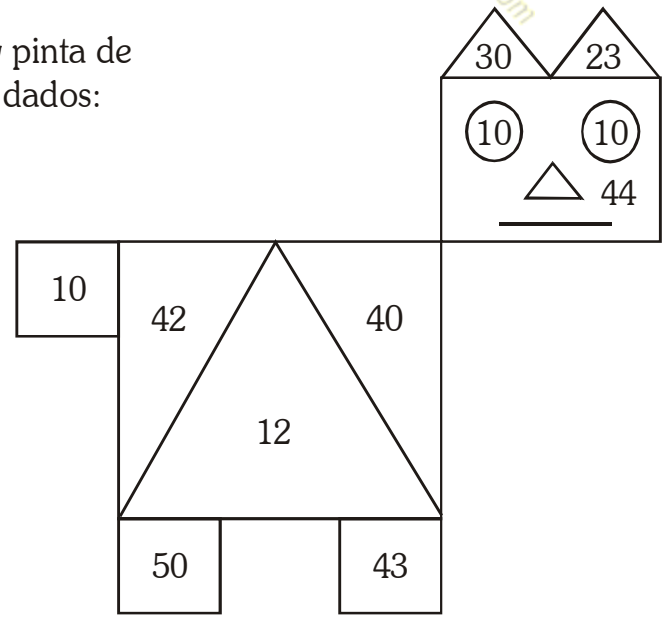

PROBLEMAS

1. En una canasta tengo 18 habas, 25 tomates, 16 zapallos. ¿Cuántos hay en total?

Operación

Respuesta

2. Un carro avanza 341 km, en una 2da. vuelta avanza 299 km. ¿Cuántos kilómetros avanza?

Operación

Respuesta

www.Matematica1.com

1. Tengo que comprar útiles escolares me cuesta S/. 10.00 soles, me cuesta S/. 5.00 soles. Si quiero comprar 2 y 3 . ¿Cuánto me costará?

Operación

Respuesta

Completa:

500			503			506			509
510		512			515			500	
520				524					
530							537		
540					545				
550			553						
560								568	
570						576			
580		582							
590				594					

www.Matematica1.com

* Lee y Escribe el número:

Quinientos veinticuatro →

Quinientos sesenta y tres →

Quinientos doce →

Quinientos cincuenta y uno →

Quinientos ochenta y cinco →

Quinientos treinta y nueve →

Seiscientos →

Quinientos cinco →



* Escribe par (P) o impar (I) según convenga:

423	
585	
348	
356	
541	
429	
233	
476	
561	
332	



www.Matematica1.com

* Escribe en el tablero posicional las siguientes cantidades:

	C	D	M
4 centenas, 2 decenas y 4 unidades	4	2	4
6 centenas, 4 unidades y 1 decena			
0 unidades, 5 decenas y 0 decenas			
5 decenas, 1 centena y 4 unidades			
5 centenas, 0 decenas y 9 unidades			
8 unidades, 3 centenas y 4 decenas			
5 centenas, 4 unidades y 5 decenas			
8 unidades, 0 decenas y 5 unidades			

* Representa:

133 →	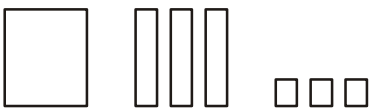
251 →	
389 →	
420 →	
276 →	
508 →	

www.Matematica1.com

¡VAMOS A DESCOMPONER!

450 = _____

586 = _____

531 = _____

425 = _____

360 = _____

224 = _____

418 = _____

540 = _____

556 = _____

549 = _____

www.Matematica1.com

* Colocar >, < ó = :



201 _____ 589

465 _____ 465

538 _____ 583

548 _____ 522

469 _____ 496

549 _____ 531

567 _____ 557

532 _____ 201

509 _____ 519

409 _____ 490

548 _____ 584

466 _____ 466

549 _____ 547

598 _____ 549

450 _____ 451

www.Matematica1.com



_____ , 545 , _____ , _____ , 548 , _____

_____ , 563 , _____ , _____ , 566 , _____

_____ , 584 , _____ , _____ , 587 , _____

_____ , 569 , _____ , _____ , 572 , _____

_____ , 550 , _____ , _____ , 553 , _____

www.Matematica1.com

* Ordena en forma ascendente y descubre la frase:

518 L

532 R

554 V

488 I

599 R

525 A

548 A

510 A

500 V

538 I

570 E

530 P

477 V

544 M

600 A

V			



www.Matematica1.com

Resuelve y Colorea según te indican

Verde claro:	Verde oscuro:
174 + 128 = ____ 214 + 48 = ____	218 + 96 = ____ 147 + 186 = ____ 73 + 29 = ____

Naranja:

200 – 184 = ____

300 – 199 = ____

150 + 133 = ____

www.Matematica1.com

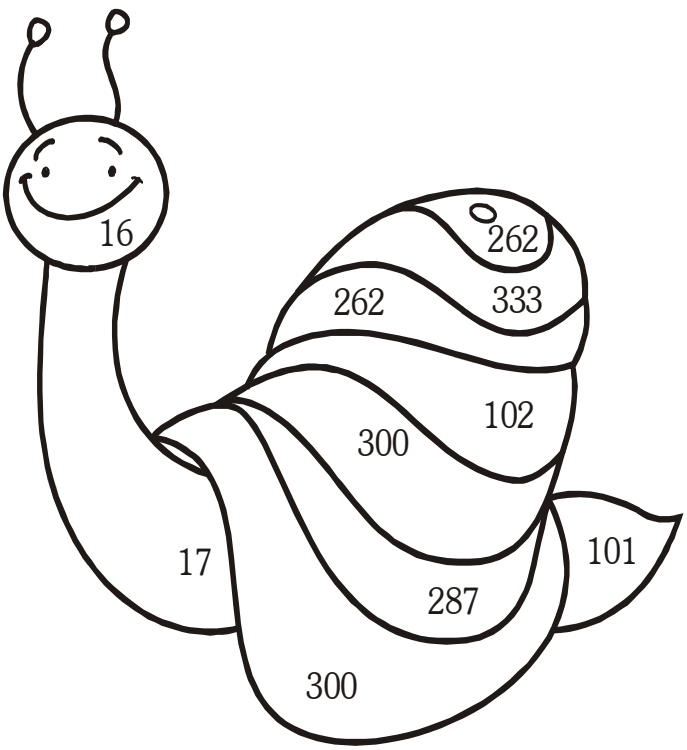

¡Eres un Campeón!

Resuelve:

1. 148 + 85 =
2. 89 + 88 =
3. 182 + 49 =
4. 188 + 32 =
5. 128 + 64 =
6. 186 + 198 =
7. 228 + 198 =
8. 182 + 29 =



* Resuelve en tu cuaderno.



* Une cada número del centro con su doble.

120	40	3
2	60	80
5	34	17
68	100	200
7	120	280
240	140	64
52	220	13
11	26	440
76	32	19
96	46	92

www.Matematica1.com

TRIPLE



* Resuelve:

14 ⇨ el triple = 14 + 14 + 14 = 42 = 42

100 ⇨ el triple = 100 + 100 + 100 = ☐

242 ⇨ el triple = ☐

123 ⇨ el triple = ☐

245 ⇨ el triple = ☐

150 ⇨ el triple = ☐

324 ⇨ el triple = ☐

241 ⇨ el triple = ☐

159 ⇨ el triple = ☐

266 ⇨ el triple = ☐

www.Matematica1.com

Operaciones Combinadas

5 + 6 – 4 + 7 – 3 = 11

+	–	+	–

5 11 7 14 11

a. 10 – 7 + 5 – 2 + 6 =

a. 20 – 10 + 2 – 7 + 5 =

a. 15 – 3 + 6 – 1 + 2 =

a. 10 – 10 + 5 – 3 + 7 =

www.Matematica1.com



1. En la bodega compré S/. 75.== soles de zanahorias, S/. 468.00 soles de tomate y S/. 83.00 soles de lechuga. ¿Cuánto gasté en total?

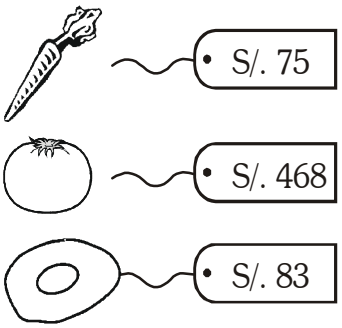

Operación

Respuesta

2. Tenía S/. 225.00 y compré 1 pantalón, me costó S/. 75.00 soles 1 camisa, costó S/. 60.00 un saco me costó S/. 80.00 soles. ¿Cuánto de vuelto he de tener?

Operación

Respuesta

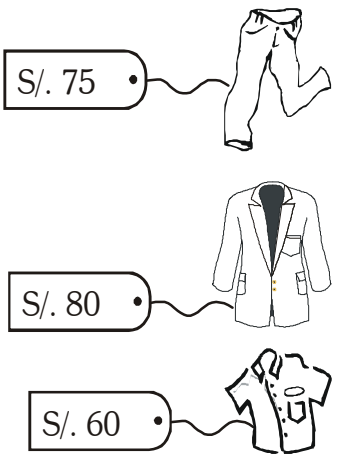

3. Alexander tiene S/. 135 soles y Federico S/. 215.00 soles.
¿Cuánto dinero tienen juntos?
¿Cuánto más tiene Federico

Operación

a. b.

Respuesta

a. ----------

b. _____

www.Matematica1.com

4. Esta semana Pablo vendió 130 cajas de papaya y 152 cajas de naranjas. ¿Cuántas cajas de frutas vendió Pablo?, la semana pasada vendió 400 cajas en total. ¿Cuál es la diferencia con ésta semana?

Operación

a. b.

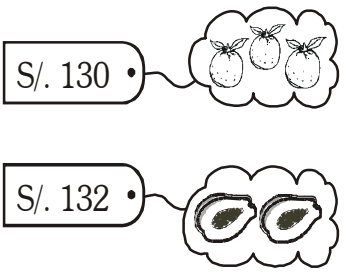

Respuesta

a. ----------

b. _____

¡ a resolver problemas !

600									
610									
620									
630									
640									
650									
660									
670									
680									
690									



Completa los números:

710									
720									
730									
740									
750									
760									
770									
780									
790									

Lee y Escribe el número

A) Seiscientos ochenta y seis _____

B) Seiscientos veintinueve _____

C) Setecientos catorce _____

D) Setecientos noventa _____

E) Seiscientos cuatro _____

F) Ochocientos _____

G) Setecientos treinta y dos _____

H) Seiscientos sesenta y cinco _____

www.Matematica1.com

Escribe el número

A) 732 _____

B) 625 _____

C) 673 _____

D) 750 _____

E) 729 _____

F) 632 _____

REPRESENTA GRÁFICAMENTE

622 =

618 =

630 =

772 =

653 =

700 =

www.Matematica1.com

DESCOMPOSICIÓN

2 8 4	=	200	+	80	+	4
7 5 3	=	700	+	50	+	3

Realiza las descomposiciones:

781 = _____

636 = _____

583 = _____

445 = _____

614 = _____

www.Matematica1.com

PIENSA CABECITA PIENSA

+	8	5	9	7	10
86					
95					

–	3	6	7	8	10
120					
95					
155					

www.Matematica1.com

Une:

3C + 4D + 5U •	• 584
6C + 2D + 0U •	• 498
6C + 1D + 8U •	• 618
5C + 8D + 4U •	• 620
4C + 9D + 8U •	• 345



Coloca el signo > , < . = .

696 _____	565 _____	565 _____	600
629 _____	748 _____	722 _____	500
563 _____	642 _____	745 _____	529
794 _____	633 _____	633 _____	586

www.Matematica1

Coloca el Número Anterior – Posterior

_____	_____	_____	789	_____	_____	_____
_____	_____	_____	625	_____	_____	_____
_____	_____	_____	643	_____	_____	_____
_____	_____	_____	716	_____	_____	_____

Recuerda:

Cuando la suma de las unidades es mayor que 9, se escribe la cifra de las unidades y se "lleva" la cifra que pertenece a las decenas.

```
  1
 536 +
 227
 ---
 763
```

Resuelve:

```
 629 +
 116
 ---
```

```
 538 +
 229
 ---
```

```
 347 +
 333
 ---
```

```
 565 +
 219
 ---
```

```
 286 +
 439
 ---
```

```
 376 +
 245
 ---
```

```
 48 +
 32
 17
 ---
```

```
 56 +
 20
 19
 ---
```

```
 60 +
 17
  9
 ---
```

www.Matematica1.com

DOBLE



Resuelve:

125 ⇨ el doble = 125 + 125 = 250

250

- 115 ⇨ el doble = 115 + 115 = _____
- 130 ⇨ el doble = _____
- 120 ⇨ el doble = _____
- 110 ⇨ el doble = _____
- 128 ⇨ el doble = _____
- 140 ⇨ el doble = _____
- 168 ⇨ el doble = _____
- 170 ⇨ el doble = _____
- 180 ⇨ el doble = _____
- 176 ⇨ el doble = _____

www.Matematica1.com

Resuelve los ejercicios de doble y mitad:

El doble de:

425 ↓

225 ↓

242 ↓

73 ↓

154 ↓

300 ↓

240 ↓

La mitad de:

250 ↓

326 ↳

784 ↓

634 ↓

896 ↓

258 ↓

Matematica1.com



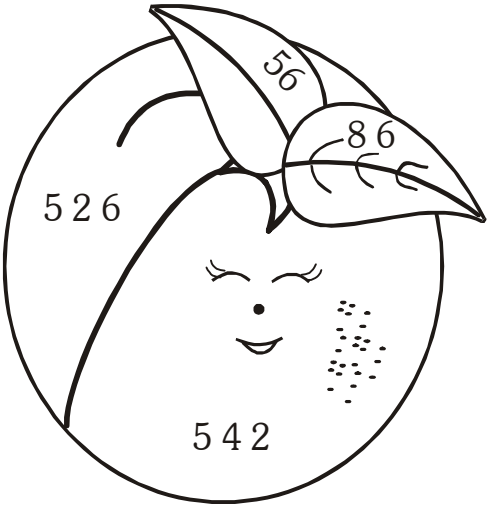





www.Matematica1.com

MITAD

VERDE

112 =	
436 =	

MORADO

410 =	
88 =	

DOBLE

NARANJA

271 =	
263 =	

ROJO

100 =	
50 =	

Hallar el triple de:

10 → _____

40 → _____

20 → _____

11 → _____

50 → _____

63 → _____

100 → _____

222 → _____

311 → _____

150 → _____

Recuerda que el triple de:

0 es _____
1 es _____
2 es _____
3 es _____
4 es _____
5 es _____
6 es _____
7 es _____
8 es _____
9 es _____

Matematica1

SUMA



- **Ordena las cifras y suma:**

a) (693 + 720) + 204



b) 715 +(528 + 99)

c) 800 + (290 + 147)

www.Matematica1.com

- **Resuelve las operaciones combinadas:**

a) 26 + 50 – 26 =

b) 60 + 90 – 10 =

c) 80 – 40 + 30 =

d) 50 – 25 + 55 =



800			803			806			
810				814					
820							827		
830			833						
840							847		
850					855				
860									869
870			873						
880						886			
890				894					

SOY EL 800 Y 900

900						906			
910			913						
920							927		
930				934					
940								948	
950		952							
960									969
970					975				
980								988	
990			993						

www.Matematica1.com

Escribe el número:

879 → _____

850 → _____

900 → _____

999 → _____

905 → _____

Une según corresponde:

Novecientos treinta	900
Ochocientos veinticuatro	903
Novecientos	842
Ochocientos	930
Ochocientos cuarenta y dos	824
Novecientos tres	800

www.Matematica1.com

* Coloca >, < o =

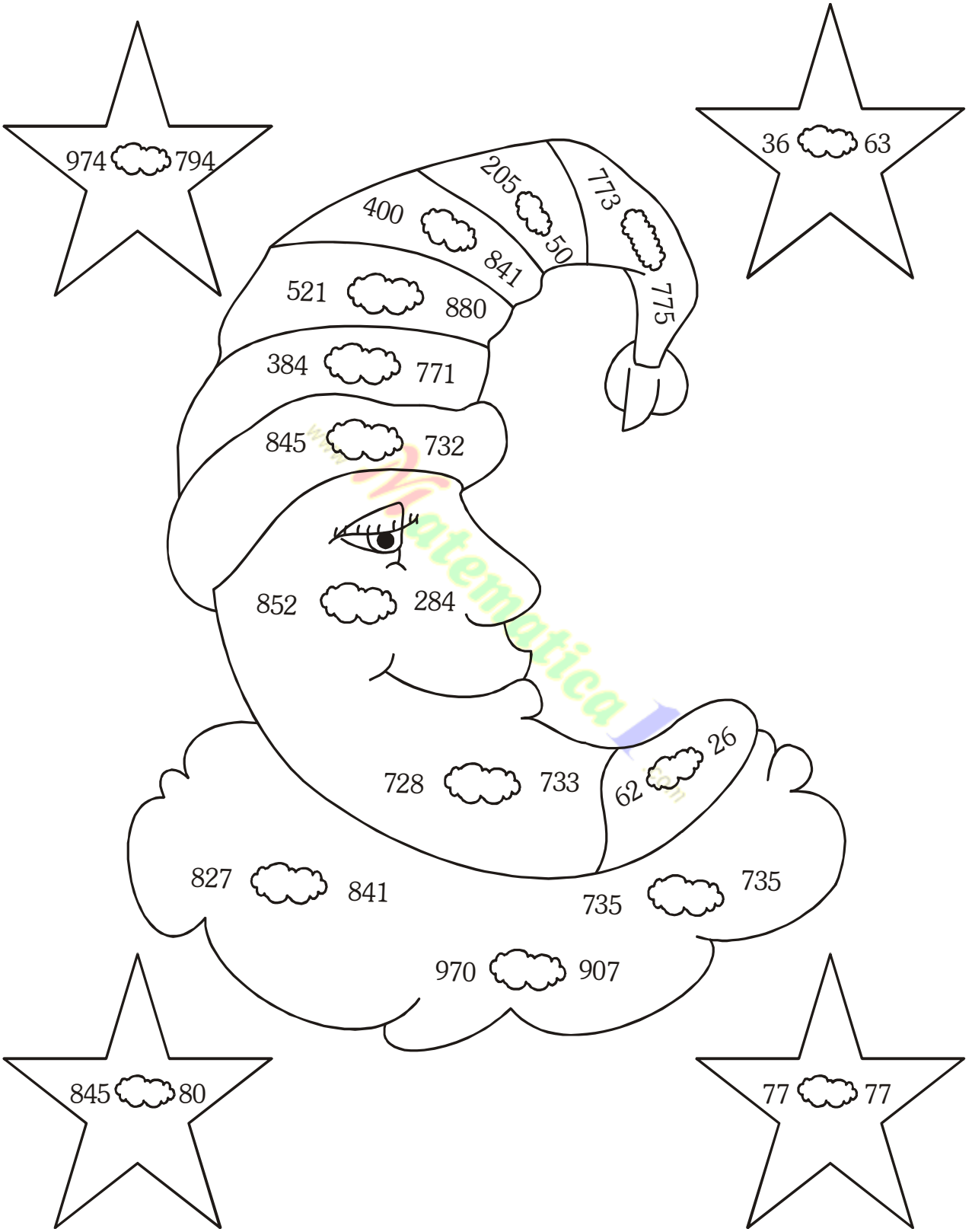
974 794
36 63
400 205 773
841 50
521 880 775
384 771
845 732
852 284
728 733
62 26
827 841
735 735
970 907
845 80
77 77

TRABAJAMOS



* Completa

Número anterior	Número	Número posterior
	843	
955		
	835	
		768
	972	
626		

www.Matematica1.com



¡Tú puedes!

Número anterior	Número	Número posterior
738		
	958	
	830	
641		
	763	
997		

¡SUMAMOS!

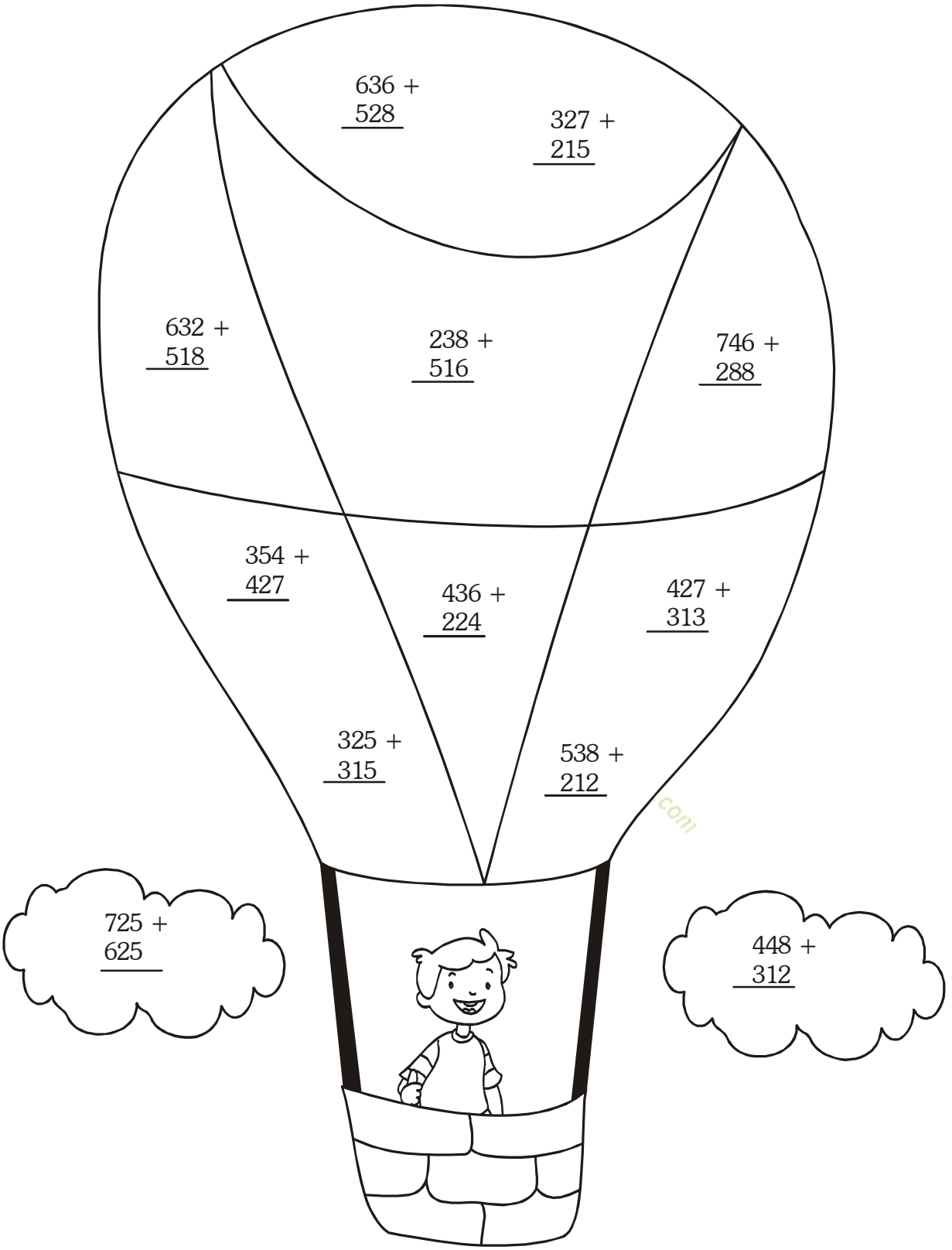
636 + 528
327 + 215
632 + 518
238 + 516
746 + 288
354 + 427
436 + 224
427 + 313
325 + 315
538 + 212
725 + 625
448 + 312

PRACTICANDO LAS RESTAS

Resuelve y pinta las áreas de respuestas con los colores indicados:

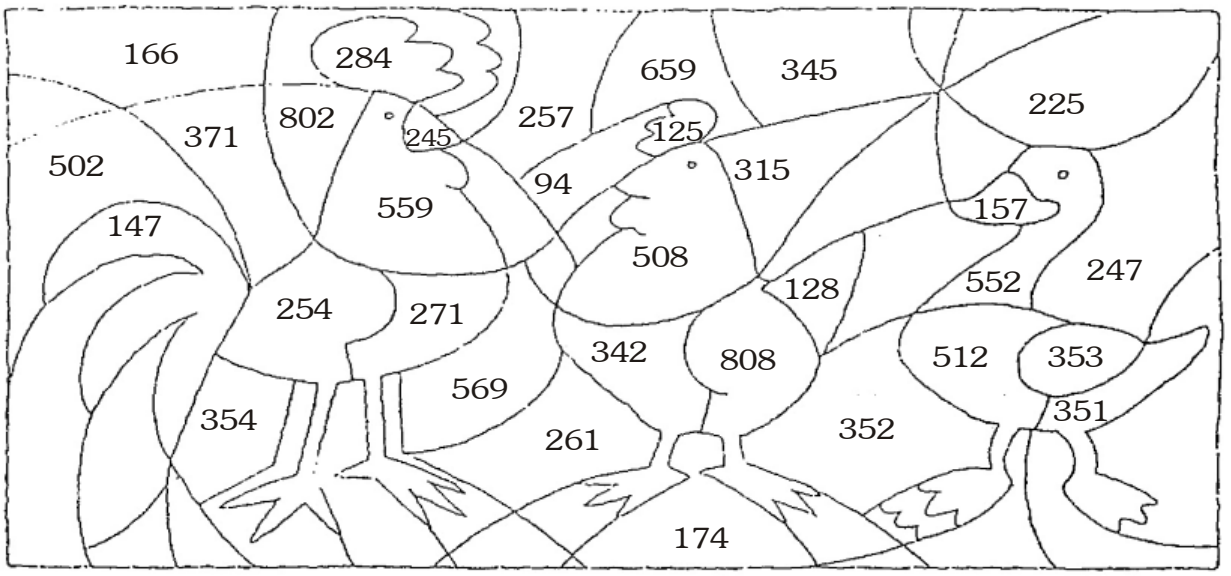

De amarillo:

846	786	695	698
– 334	– 435	– 342	– 146

De marrón:

375	481	746	987
– 247	– 139	– 238	– 179

De anaranjado:

408	519	827	736
– 137	– 372	– 582	– 482

De rojo:

832	623	846	963
– 675	– 498	– 287	– 679



Resuelve las operaciones combinadas:

1. (398 – 199) + 132 =

2. (345 + 274) – 182 =

3. (456 + 499) – (349 + 193)

¡SOMOS LOS MEJORES!

Sabías que:

El metro es la unidad principal de las medidas de longitud.
Con el metro se mide el largo, ancho, altura, la talla y la profundidad.

1 metro = 100 cm.



Usa el metro y escribe cuánto mide:



_____ cm.



_____ cm.



_____ cm.

_____ cm.

www.Matematica1.com

UNIDAD DE MASA

¡Sabías que!

La unidad de masa es el kilogramo (kg) que equivale a 1000 gramos.
Debemos decir masa en lugar de peso.

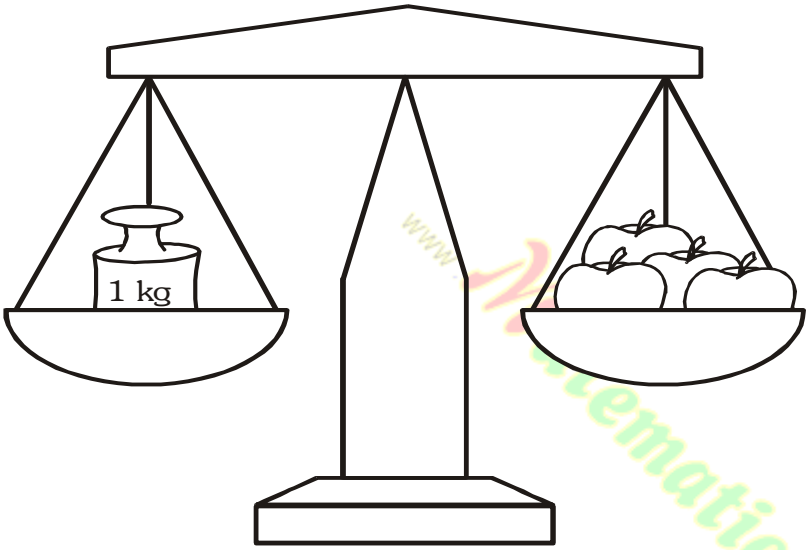



Completo colocando + ó – en el cuadrado

a. La tiene masa que el

b. La tiene masa que el

c. La tiene masa que el

d. La tiene masa que el

www.Matematica1.com

¿QUÉ HORA ES?

* Encierro la hora correcta



6:15 1:30 1:15



10:00 12:00 10:15



3:30 5:00 5:15



9:45 10:15 10:45



12:30 5:15 5:00



6:00 7:30 8:30



12:00 11:00 11:45



12:15 3:00 12:30



9:15 5:45 9:30



3:30 6:00 6:15



2:45 9:15 2:30



12:15 3:00 3:30

www.Matematica1.com

* Escribe debajo del reloj qué hora es:



_____



_____



_____



_____



_____



_____



_____



_____

www.Matematica1.com

RECONOZCO LAS MONEDAS Y LOS BILLETES

MONEDAS

1 Céntimo

5 Céntimos

10 Céntimos

20 Céntimos

50 Céntimos

1 Sol

2 Soles

5 Soles

www.Matematica1.com

BILLETES