9 Fracciones: lectura y escritura

Nombre _____ Fecha _____

RECUERDA



La fracción que representa la parte sombreada es:

$\frac{1}{2}$ ← Número de partes sombreadas
← Número de partes iguales de la figura

La fracción $\frac{1}{2}$ se lee: un medio.

1 **Escribe la fracción que representa la parte sombreada.**

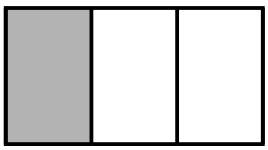
▶

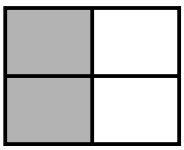
▶


▶

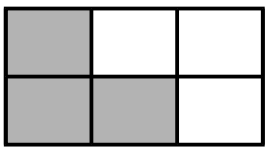
▶

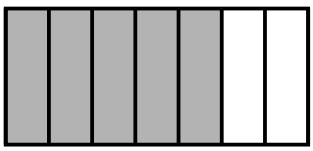
▶

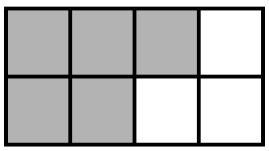
▶

2 **Completa la tabla.**

Fracción	Lectura	Representación
$\frac{1}{3}$		
$\frac{3}{4}$		
$\frac{3}{5}$		
	Cinco sextos	
	Cinco séptimos	
	Ocho novenos	

Material fotocopiable © 2014 Santillana Educación, S. L.

9 Comparación de fracciones

Nombre _____ Fecha _____

RECUERDA

- ¿Qué figura tiene mayor zona sombreada?



▶ $\frac{3}{4}$



▶ $\frac{2}{4}$

$\frac{3}{4} > \frac{2}{4}$

- ¿Qué figura tiene menor zona sombreada?



▶ $\frac{2}{8}$



▶ $\frac{2}{4}$

$\frac{2}{8} < \frac{2}{4}$

1 **Escribe la fracción que representa la parte sombreada y rodea la fracción mayor.**

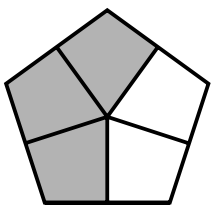

$\frac{\dots}{\dots}$

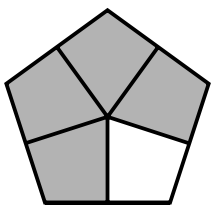

$\frac{\dots}{\dots}$

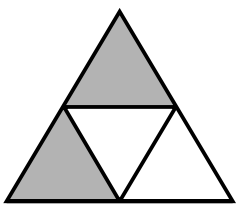

$\frac{\dots}{\dots}$

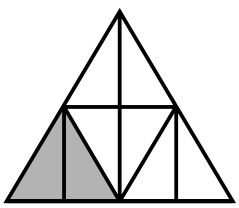

$\frac{\dots}{\dots}$

2 **Compara las fracciones y escribe el signo correspondiente.**

Tienen igual el denominador.

- $\frac{4}{5}$ ◯ $\frac{3}{5}$
- $\frac{3}{6}$ ◯ $\frac{5}{6}$
- $\frac{6}{7}$ ◯ $\frac{5}{7}$
- $\frac{5}{8}$ ◯ $\frac{7}{8}$

Tienen igual el numerador.

- $\frac{2}{4}$ ◯ $\frac{2}{7}$
- $\frac{3}{5}$ ◯ $\frac{3}{7}$
- $\frac{5}{8}$ ◯ $\frac{5}{6}$
- $\frac{6}{7}$ ◯ $\frac{6}{9}$

3 **Lee y contesta.**

Julia y Roberto fueron a merendar pizza. Partieron la pizza en 8 partes iguales y Julia se comió $\frac{3}{8}$ y Roberto $\frac{4}{8}$. ¿Quién comió más pizza?

Material fotocopiable © 2014 Santillana Educación, S. L.

9 Unidades decimales

Nombre _____ Fecha _____

RECUERDA

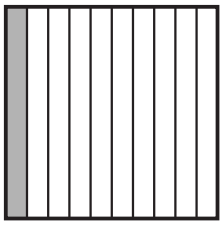

1 décima se escribe así:

$\frac{1}{10}$ o 0,1

Fracción Decimal



1 centésima se escribe así:

$\frac{1}{100}$ o 0,01

Fracción Decimal

1 **¿Cuántas décimas son? Cuenta y escribe la fracción correspondiente.**



… décimas ► $\frac{\dots}{\dots}$

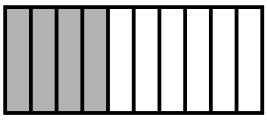

… décimas ► $\frac{\dots}{\dots}$

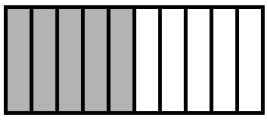

… décimas ► $\frac{\dots}{\dots}$

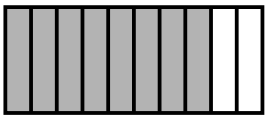

… décimas ► $\frac{\dots}{\dots}$

2 **¿Cuántas centésimas son? Cuenta y escribe la fracción correspondiente.**



… centésimas ► $\frac{\dots}{\dots}$



… centésimas ► $\frac{\dots}{\dots}$



… centésimas ► $\frac{\dots}{\dots}$



… centésimas ► $\frac{\dots}{\dots}$

3 **Escribe en forma de número decimal.**

RECUERDA

- $\frac{1}{10} = 0{,}1$
- $\frac{1}{100} = 0{,}01$

- $\frac{2}{10} = \dots$
- $\frac{4}{10} = \dots$
- $\frac{6}{10} = \dots$
- $\frac{8}{10} = \dots$
- $\frac{3}{100} = \dots$
- $\frac{5}{100} = \dots$
- $\frac{7}{100} = \dots$
- $\frac{9}{100} = \dots$

4 **Escribe en forma decimal.**

- 5 décimas ►
- 7 décimas ►
- 4 centésimas ►

Material fotocopiable © 2014 Santillana Educación, S. L.