Números del 200 al 299

Aprende.

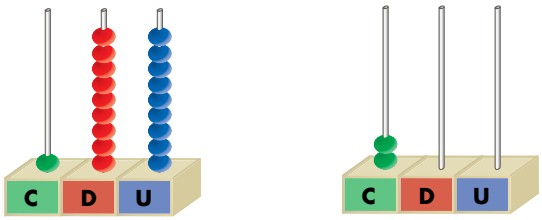

199 $\xrightarrow{+\,1}$ = 200



100 + 100 = 200

2 centenas = 20 decenas = 200 unidades

2 C = 20 D = 200 U

Escribe con letra los números representados.

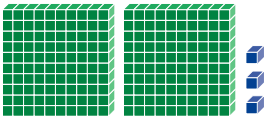

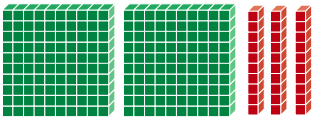







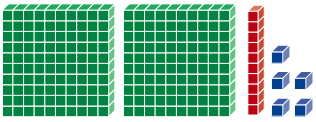

Aprende.

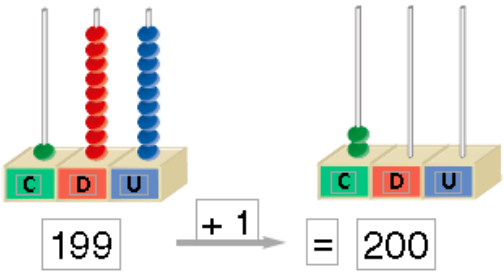



100 + 100 = 200

2 centenas = 20 decenas = 200 unidades

2 C = 20 D = 200 U

Escribe con letra los números representados.

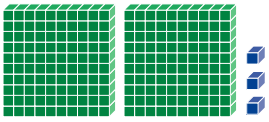

doscientos tres

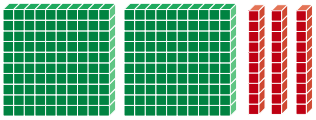

doscientos treinta

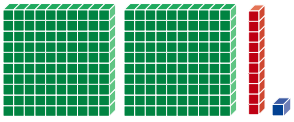

doscientos once

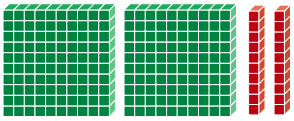

doscientos veinte



doscientos trece



doscientos quince

Escribe los números.

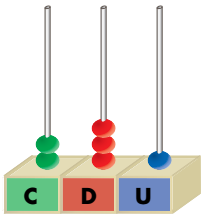

2 3 1

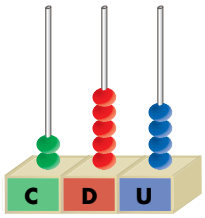



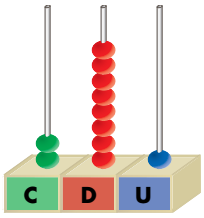

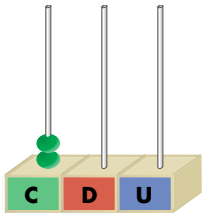

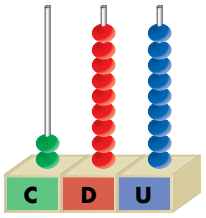

Escribe los números formados por:

2 C, 1 D y 3 U →

2 C y 6 U →

2 C y 3 D →

2 C y 8 U →

2 C y 4 D →

Escribe los números.



2	3	1







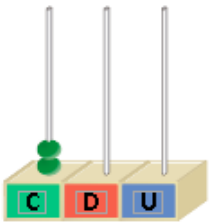



Escribe los números formados por:

2 C, 1 D y 3 U → 213 doscientos trece

2 C y 6 U → 206 doscientos seis

2 C y 3 D → 230 doscientos treinta

2 C y 8 U → 208 doscientos ocho

2 C y 4 D → 240 doscientos cuarenta