CUERPOS GEOMÉTRICOS. MEDIDA DEL VOLUMEN

Calcula el área total y el volumen de los siguientes cuerpos geométricos. Pon el nombre a cada uno de ellos.

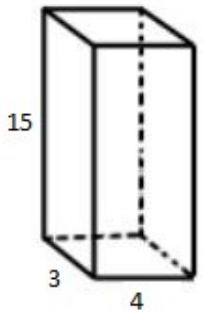

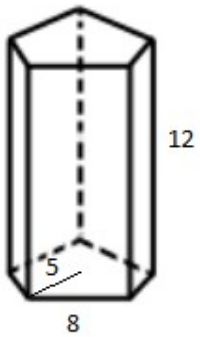

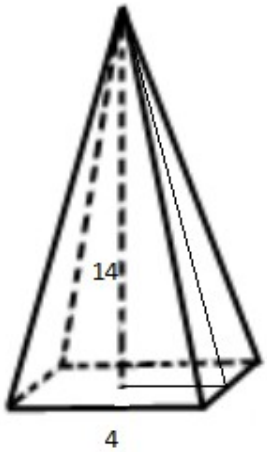



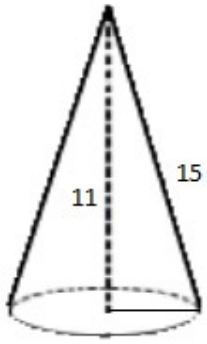

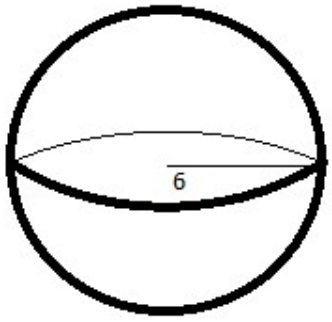

Todas las unidades están en centímetros.