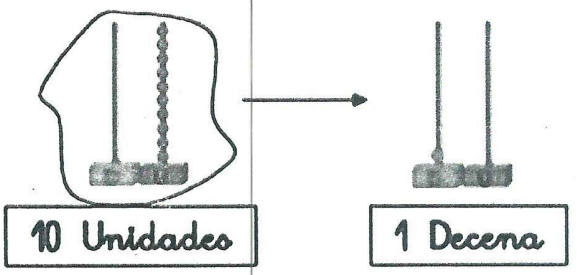

Rodea una decena y escribe cuántos hay.

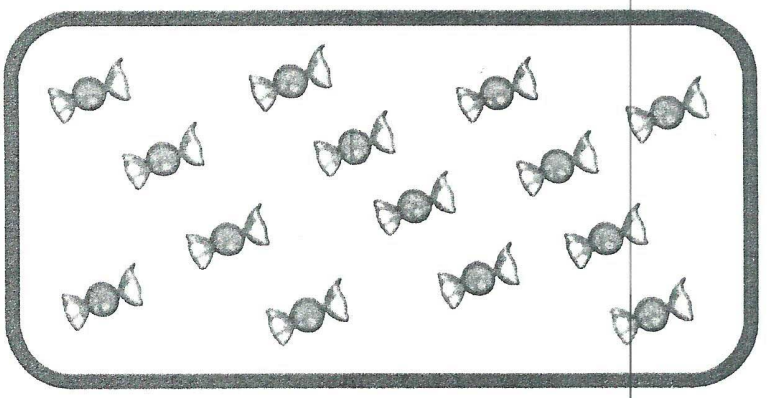

Decenas	Unidades



Decenas	Unidades



Decenas	Unidades

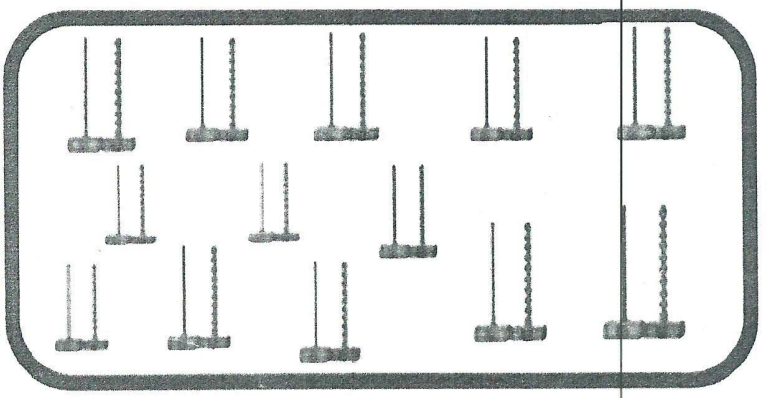

Decenas	Unidades

25010

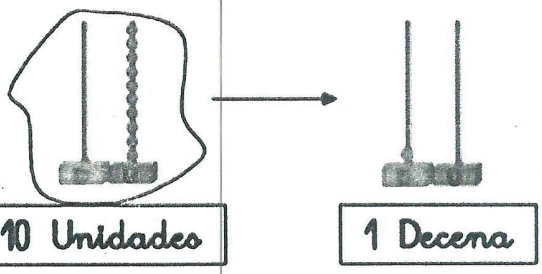

Rodea una decena y escribe cuántos hay.

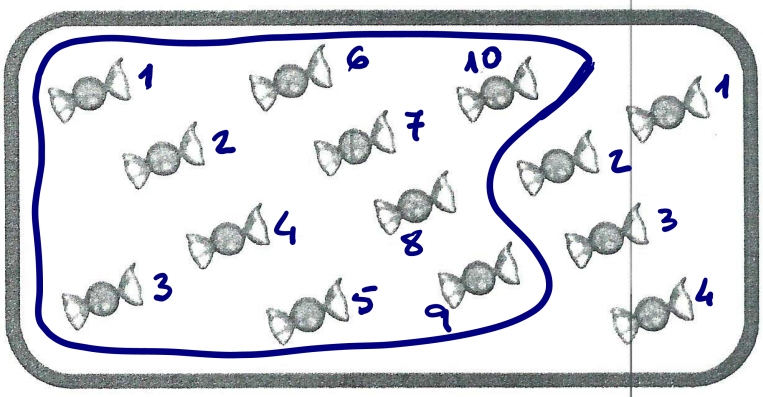

Decenas	Unidades
1	4



Decenas	Unidades
1	6



Decenas	Unidades
1	2

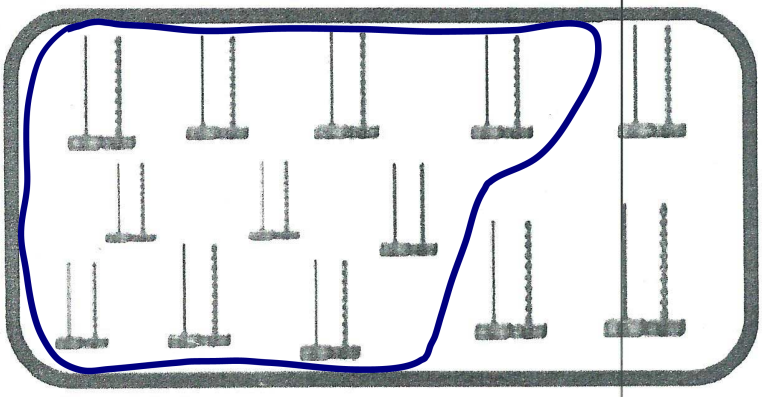

Decenas	Unidades
1	3

La decena

Nombre _____ Fecha _____

1. Rodea 10 en cada grupo y suma.

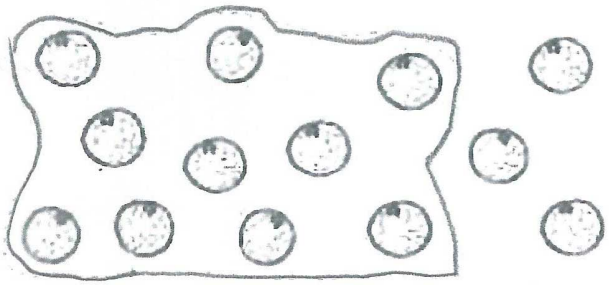

10 + ☐ = ☐



10 + ☐ = ☐

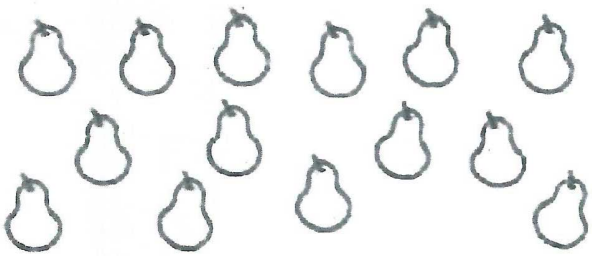

10 + ☐ = ☐

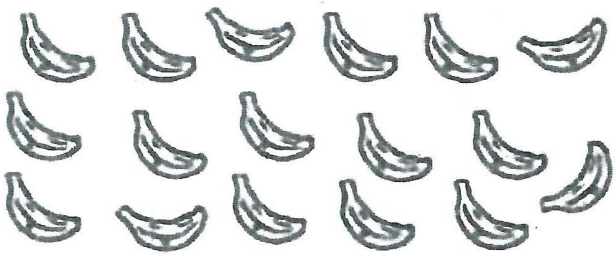

10 + ☐ = ☐



10 + ☐ = ☐



10 + ☐ = ☐



10 + ☐ = ☐



10 + ☐ = ☐

La decena

Nombre _____ Fecha _____

1. Rodea 10 en cada grupo y suma.

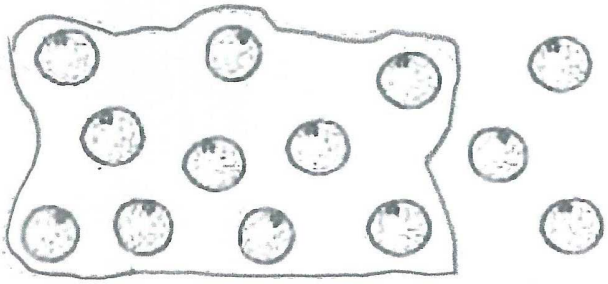

10 + 3 = 13



10 + 6 = 16



10 + 4 = 14

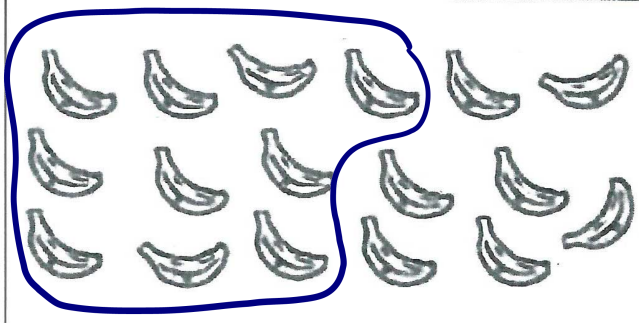

10 + 7 = 17

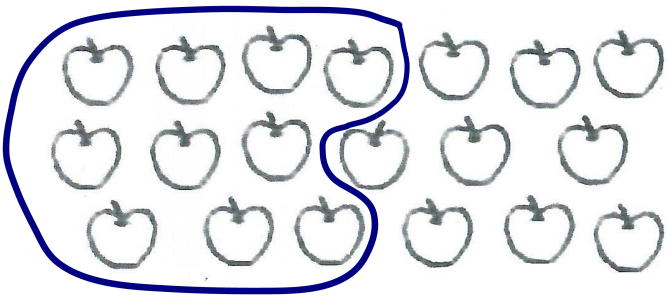

10 + 9 = 19



10 + 5 = 15

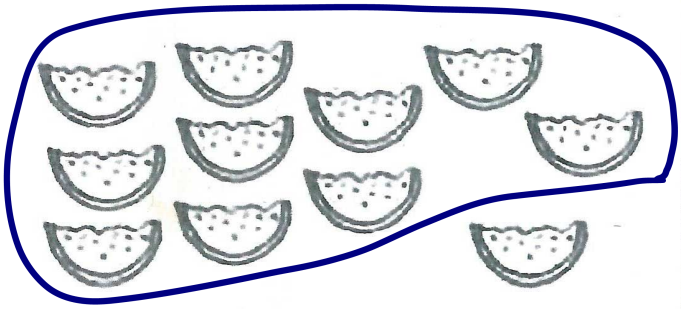

10 + 1 = 11



10 + 8 = 18

1 Escribe el número y une las parejas que suman 10.

2 Lee y resuelve.

Mateo tenía 9 pasteles de nata. Se comió 4.
¿Cuántos pasteles le quedan a Mateo?

Tenía ☐ .

Se comió ☐ .

☐ − ☐ = ☐

Le quedan ☐ .

3 Rodea de color verde a las niñas que tienen la cometa a la derecha, y de azul, a las que la tienen a la izquierda.



1 Escribe el número y une las parejas que suman 10.

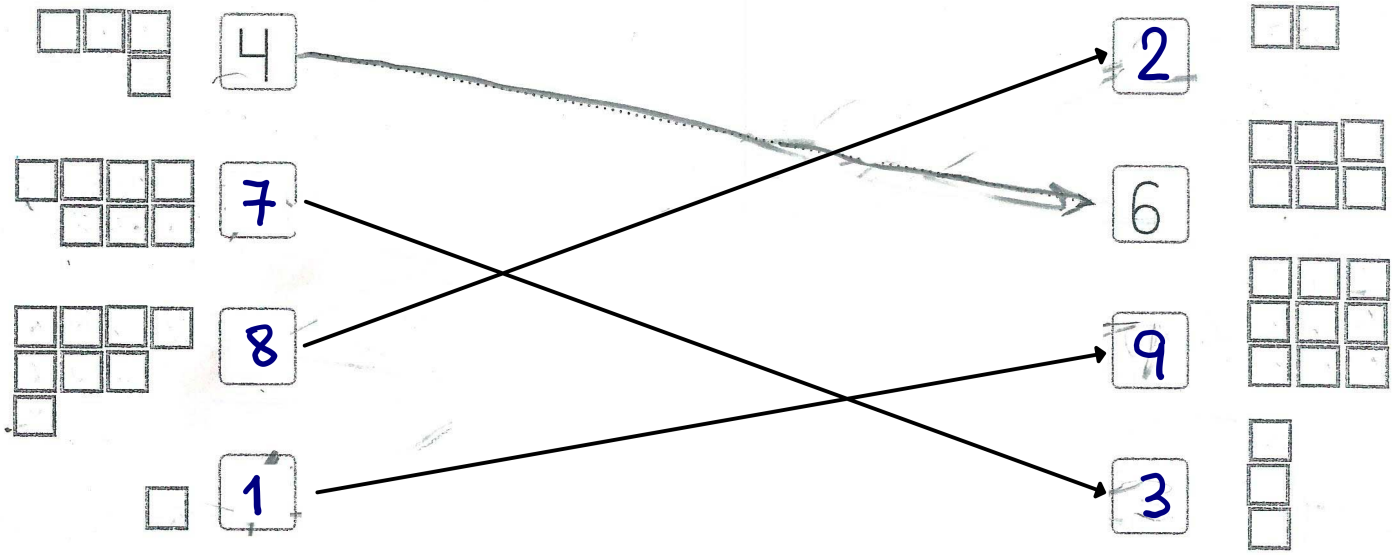

2 Lee y resuelve.

Mateo tenía 9 pasteles de nata. Se comió 4.
¿Cuántos pasteles le quedan a Mateo?

Tenía 9 .

Se comió 4 .



9 − 4 = 5

Le quedan 5 .

3 Rodea de color verde a las niñas que tienen la cometa a la derecha, y de azul, a las que la tienen a la izquierda.



VERDE AZUL AZUL VERDE